Name : _____ Score : _____

Pairs of Angles

P1S1

1)

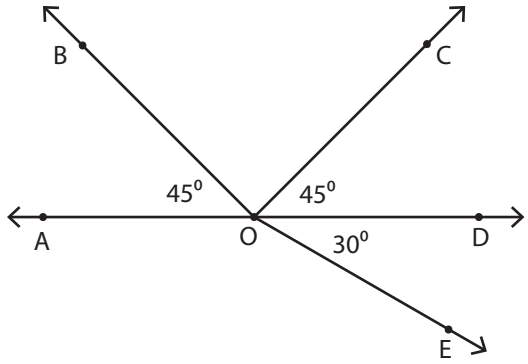

a) Name the complementary angles.

_____

b) Write the supplementary angle to ∠BOA.

_____

c) ∠AOE and ∠DOE are supplementary. Find m∠AOE.

_____

d) Name the angles adjacent to ∠BOC.

_____

2)

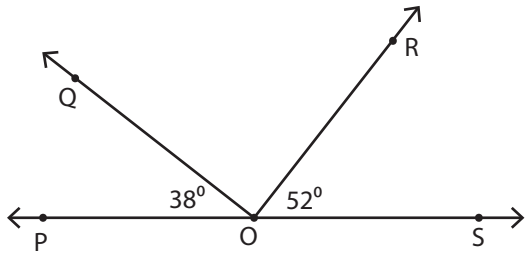

a) Name any one pair of adjacent angles.

_____

b) Find m∠QOR .

_____

c) Name the angle complement to ∠ROS.

_____

d) Name the angle that forms a linear pair with ∠POQ.

_____

Name : _____ Score : _____

Answer Key

Pairs of Angles

P1S1

1)

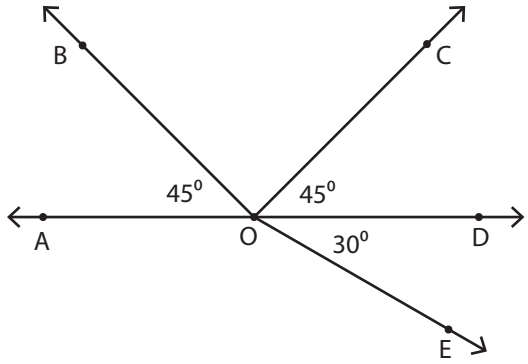

a) Name the complementary angles.

∠COD, ∠AOB

b) Write the supplementary angle to ∠BOA.

∠BOD

c) ∠AOE and ∠DOE are supplementary. Find m∠AOE.

150^0

d) Name the angles adjacent to ∠BOC.

∠COD, ∠AOB

2)

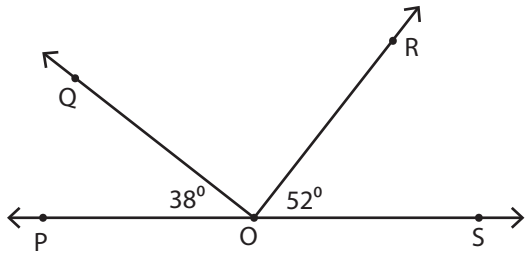

a) Name any one pair of adjacent angles.

∠POQ, ∠QOR (or) ∠QOR, ∠ROS

b) Find m∠QOR .

90^0

c) Name the angle complement to ∠ROS.

∠POQ

d) Name the angle that forms a linear pair with ∠POQ.

∠QOS