Name : _____ Score : _____

Angles in Transversal

Difficult: S1

Find the value of x.

1)

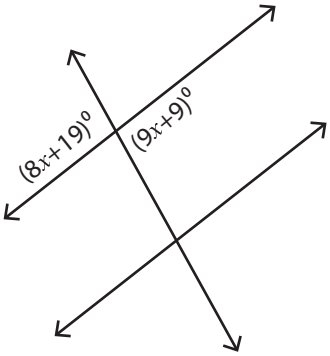

$x =$ _____

2)

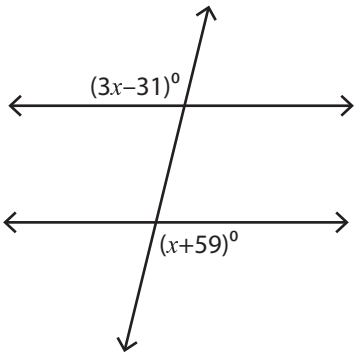

$x =$ _____

3)

$x =$ _____

5)

$x =$ _____

7)

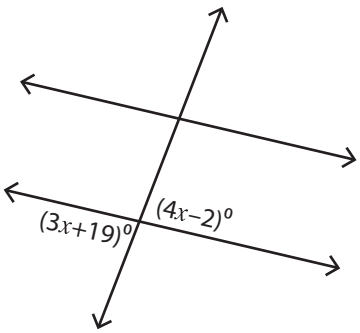

$x =$ _____

8)

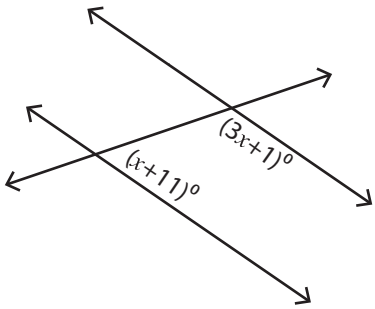

$x =$ _____

PREVIEW

Access the largest collection of worksheets for just $19.95 per year!

Members, please log in to download this worksheet.

Log in

Not a member? Please sign up to gain complete access.

Sign up

www.mathworksheets4kids.com

Name : _____ Score : _____

Answer Key

Angles in Transversal

Difficult: S1

Find the value of x.

1)

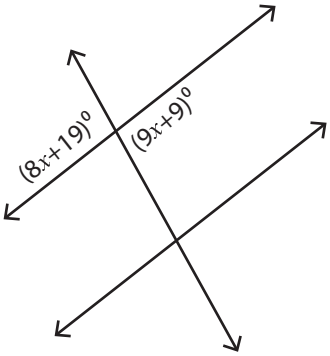

$x =$ 10

2)

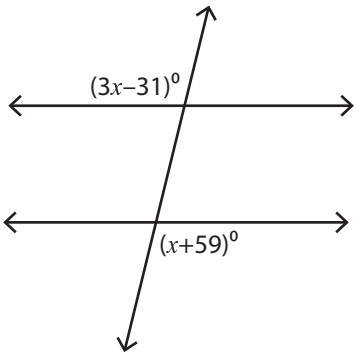

$x =$ 45

3)

$x =$ 1 ... 26

5)

$x =$ 6 ... 15

7)

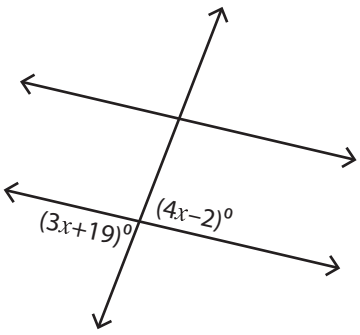

$x =$ 21

8)

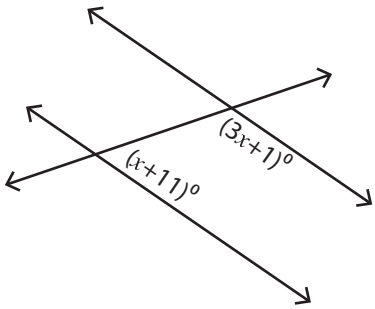

$x =$ 42

PREVIEW

Access the largest collection of worksheets for just $19.95 per year!

Members, please log in to download this worksheet.

Log in

Not a member? Please sign up to gain complete access.

Sign up

www.mathworksheets4kids.com

Name : _____ Score : _____

Angles in Transversal

Difficult: S2

Find the value of x.

1)

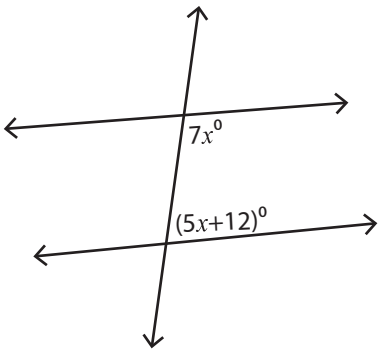

$x =$ _____

2)

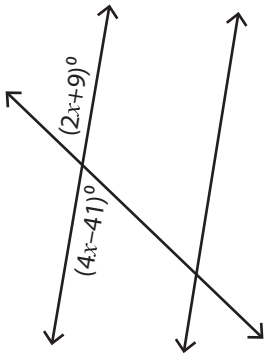

$x =$ _____

3)

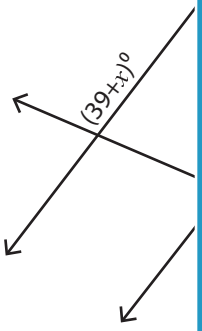

$x =$ _____

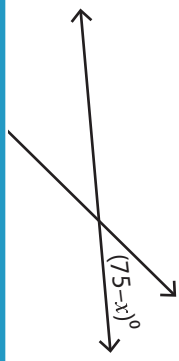

5)

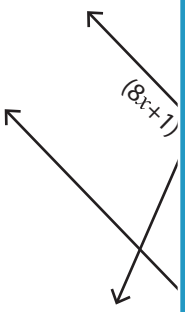

$x =$ _____

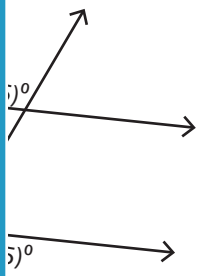

7)

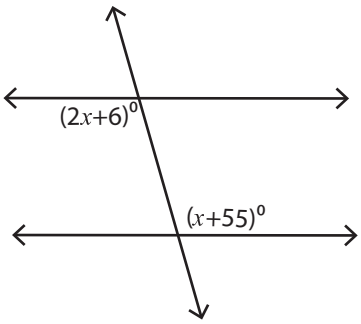

$x =$ _____

8)

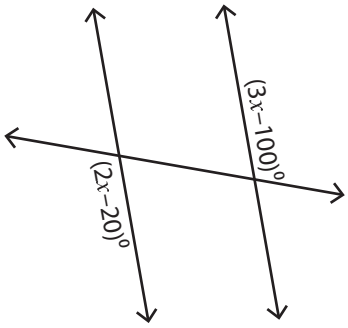

$x =$ _____

PREVIEW

Access the largest collection of worksheets for just $19.95 per year!

Members, please log in to download this worksheet.

Log in

Not a member? Please sign up to gain complete access.

Sign up

www.mathworksheets4kids.com

Name : _____ Score : _____

Answer Key

Angles in Transversal

Difficult: S2

Find the value of x.

1)

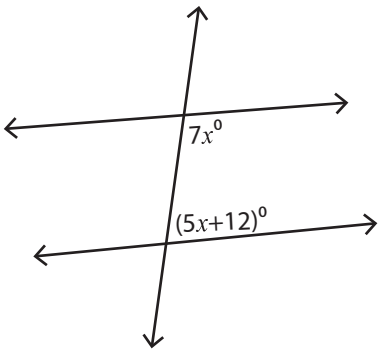

$x =$ 14

2)

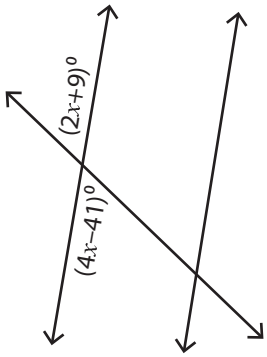

$x =$ 25

3)

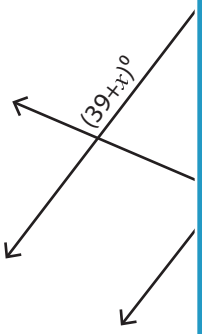

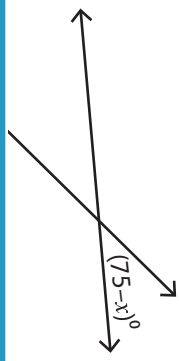

$x =$ 6 … 35

5)

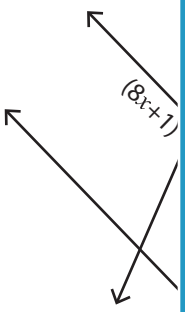

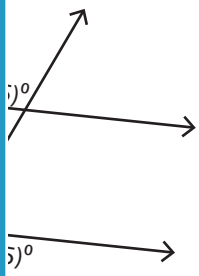

$x =$ 1 … 30

7)

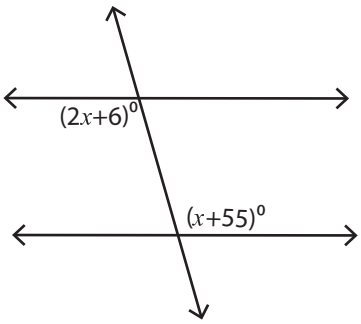

$x =$ 49

8)

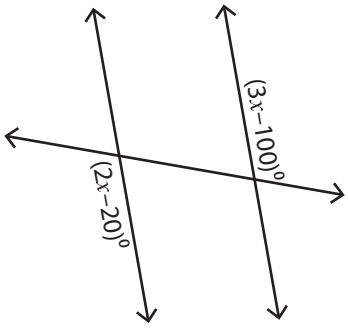

$x =$ 80

PREVIEW

Access the largest collection of worksheets for just **$19.95** per year!

Members, please log in to download this worksheet.

Log in

Not a member? Please sign up to gain complete access.

Sign up

www.mathworksheets4kids.com

Name : _____ Score : _____

Angles in Transversal

Difficult: S3

Find the value of x.

1)

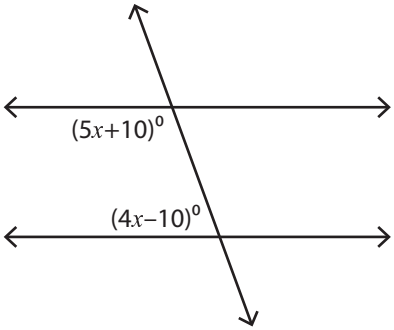

$x =$ _____

2)

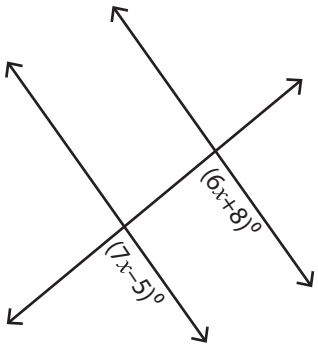

$x =$ _____

3)

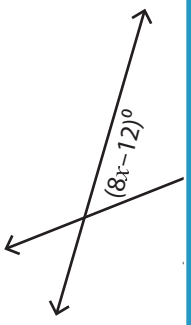

$x =$ _____

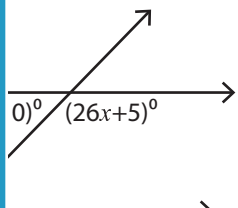

5)

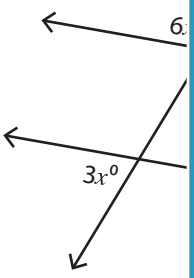

$x =$ _____

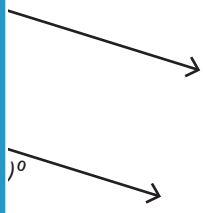

7)

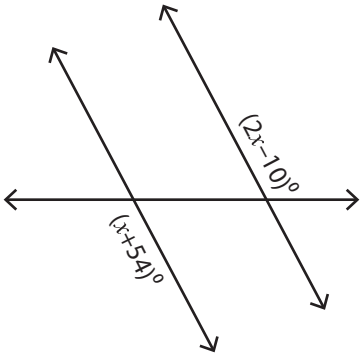

$x =$ _____

8)

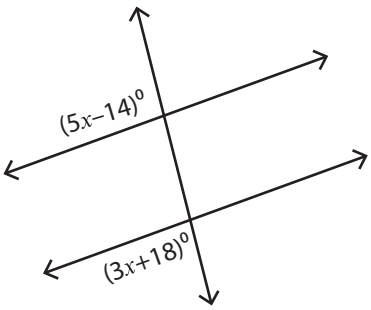

$x =$ _____

PREVIEW

Access the largest collection of worksheets for just $19.95 per year!

Members, please log in to download this worksheet.

Log in

Not a member? Please sign up to gain complete access.

Sign up

www.mathworksheets4kids.com

Name : _____ Score : _____

Answer Key

Angles in Transversal

Difficult: S3

Find the value of x.

1)

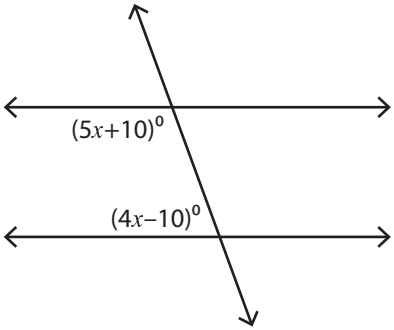

$x =$ 20

2)

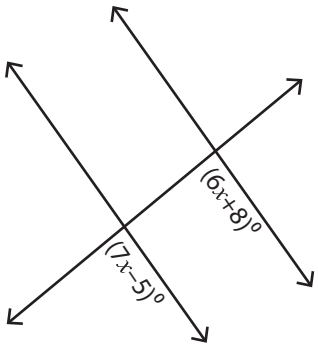

$x =$ 13

3)

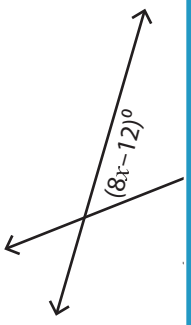

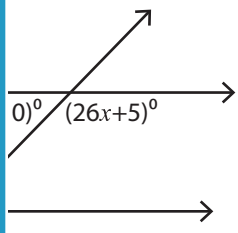

$x =$ 8

5

5)

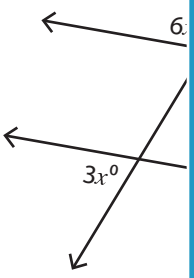

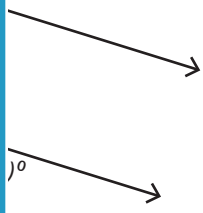

$x =$ 2

25

7)

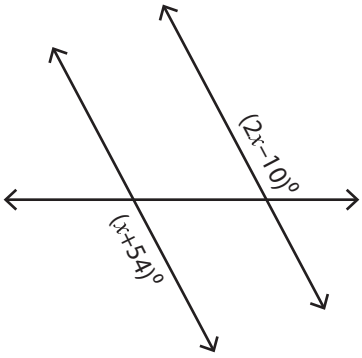

$x =$ 64

8)

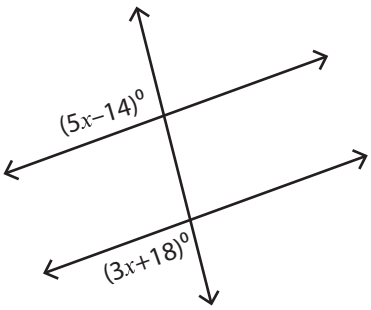

$x =$ 22

PREVIEW

Access the largest collection of worksheets for just $19.95 per year!

Members, please log in to download this worksheet.

Log in

Not a member? Please sign up to gain complete access.

Sign up

www.mathworksheets4kids.com