Name : _____ Score : _____

Easy: S1

Radius / Diameter

Find the radius or diameter of each circle.

1)

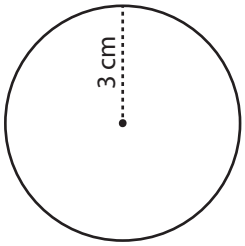

Radius = _____

Diameter = _____

2)

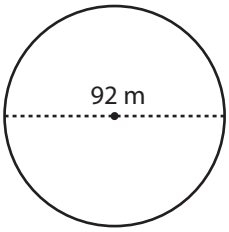

Radius = _____

Diameter = _____

3)

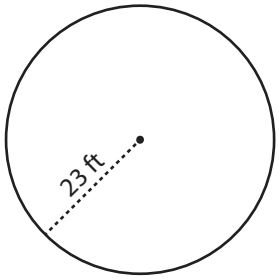

Radius = _____

Diameter = _____

4)

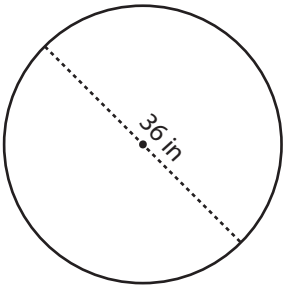

Radius = _____

Diameter = _____

5)

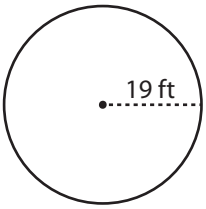

Radius = _____

Diameter = _____

6)

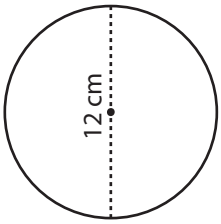

Radius = _____

Diameter = _____

7)

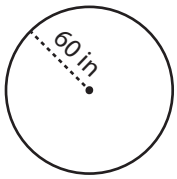

Radius = _____

Diameter = _____

8)

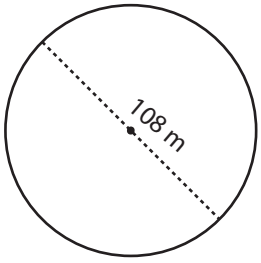

Radius = _____

Diameter = _____

9)

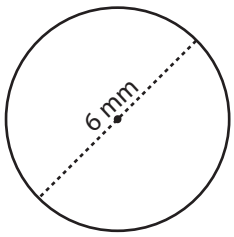

Radius = _____

Diameter = _____

10)

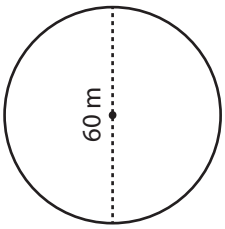

Radius = _____

Diameter = _____

11)

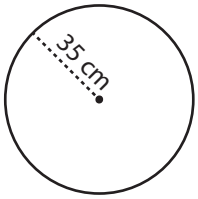

Radius = _____

Diameter = _____

12)

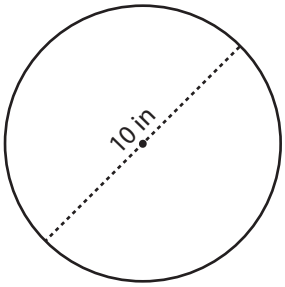

Radius = _____

Diameter = _____

Name : _____ **Answer Key** Score : _____

Easy: S1

Radius / Diameter

Find the radius or diameter of each circle.

1)

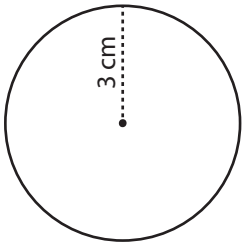

Radius = **3 cm**

Diameter = **6 cm**

2)

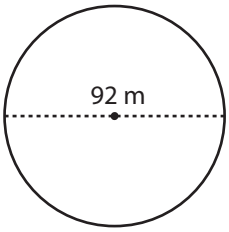

Radius = **46 m**

Diameter = **92 m**

3)

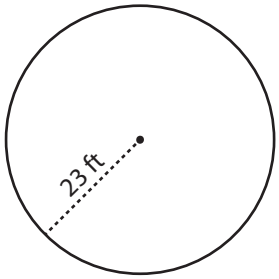

Radius = **23 ft**

Diameter = **46 ft**

4)

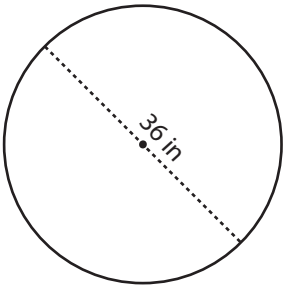

Radius = **18 in**

Diameter = **36 in**

5)

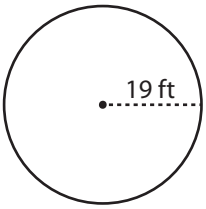

Radius = **19 ft**

Diameter = **38 ft**

6)

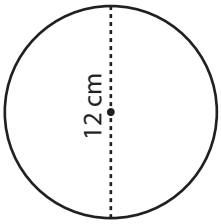

Radius = **6 cm**

Diameter = **12 cm**

7)

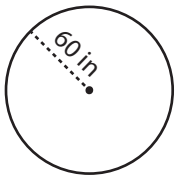

Radius = **60 in**

Diameter = **120 in**

8)

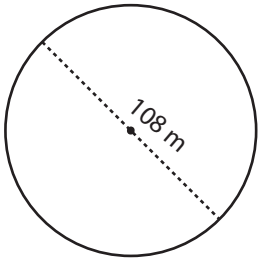

Radius = **54 m**

Diameter = **108 m**

9)

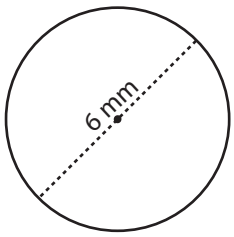

Radius = **3 mm**

Diameter = **6 mm**

10)

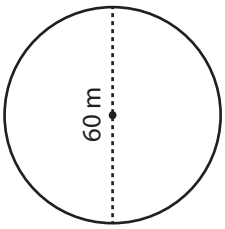

Radius = **30 m**

Diameter = **60 m**

11)

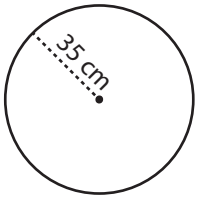

Radius = **35 cm**

Diameter = **70 cm**

12)

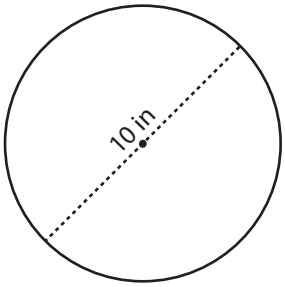

Radius = **5 in**

Diameter = **10 in**

Name : _____ Score : _____

Easy: S2

Radius / Diameter

Find the radius or diameter of each circle.

1)

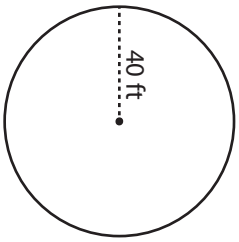

Radius = _____

Diameter = _____

2)

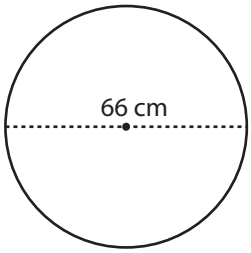

Radius = _____

Diameter = _____

3)

Radius = _____

Diameter = _____

4)

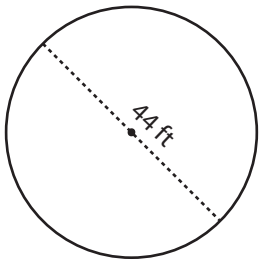

Radius = _____

Diameter = _____

5)

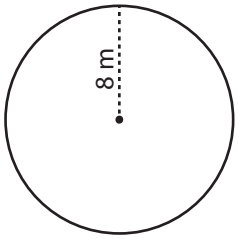

Radius = _____

Diameter = _____

6)

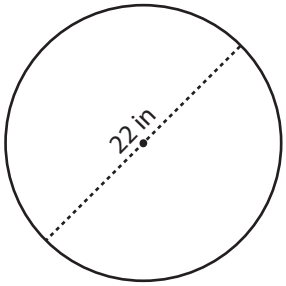

Radius = _____

Diameter = _____

7)

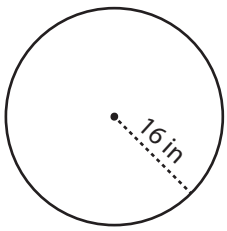

Radius = _____

Diameter = _____

8)

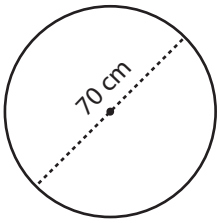

Radius = _____

Diameter = _____

9)

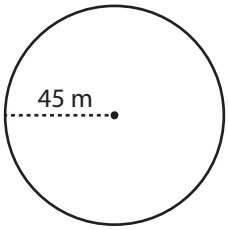

Radius = _____

Diameter = _____

10)

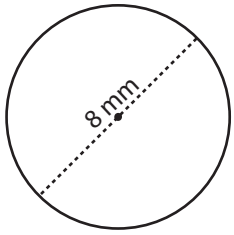

Radius = _____

Diameter = _____

11)

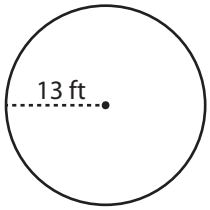

Radius = _____

Diameter = _____

12)

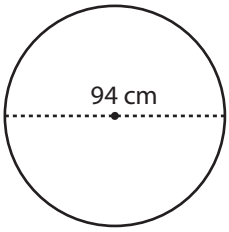

Radius = _____

Diameter = _____

Name : _____ **Answer Key** Score : _____

Easy: S2

Radius / Diameter

Find the radius or diameter of each circle.

1)

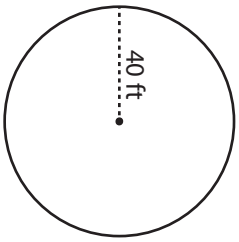

Radius = **40 ft**

Diameter = **80 ft**

2)

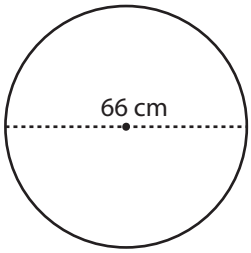

Radius = **33 cm**

Diameter = **66 cm**

3)

Radius = **5 mm**

Diameter = **10 mm**

4)

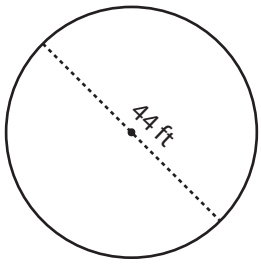

Radius = **22 ft**

Diameter = **44 ft**

5)

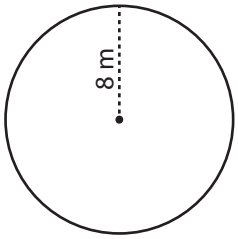

Radius = **8 m**

Diameter = **16 m**

6)

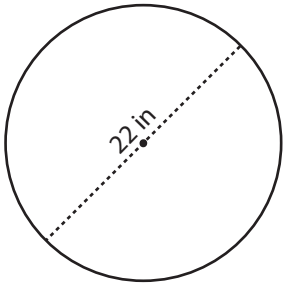

Radius = **11 in**

Diameter = **22 in**

7)

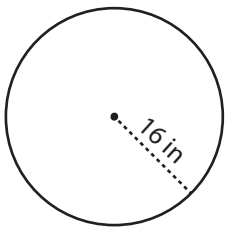

Radius = **16 in**

Diameter = **32 in**

8)

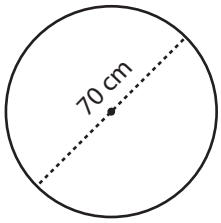

Radius = **35 cm**

Diameter = **70 cm**

9)

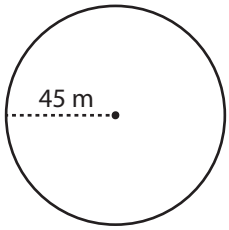

Radius = **45 m**

Diameter = **90 m**

10)

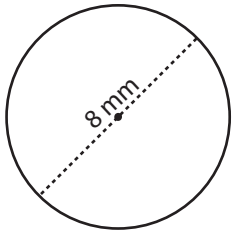

Radius = **4 mm**

Diameter = **8 mm**

11)

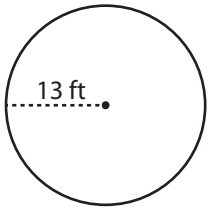

Radius = **13 ft**

Diameter = **26 ft**

12)

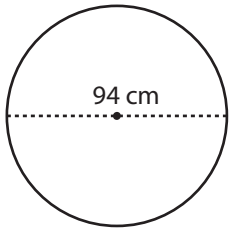

Radius = **47 cm**

Diameter = **94 cm**

Name : _____ Score : _____

Easy: S3

Radius / Diameter

Find the radius or diameter of each circle.

1)

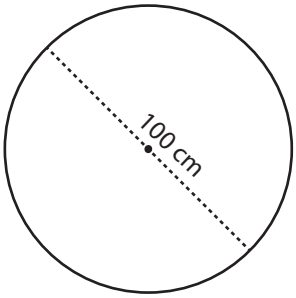

Radius = _____

Diameter = _____

2)

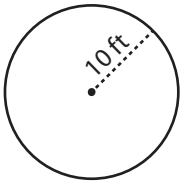

Radius = _____

Diameter = _____

3)

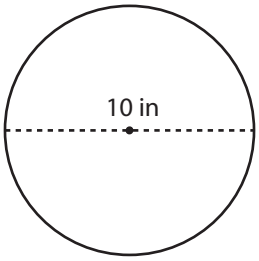

Radius = _____

Diameter = _____

4)

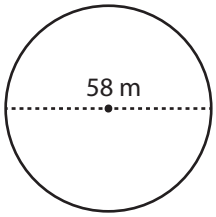

Radius = _____

Diameter = _____

5)

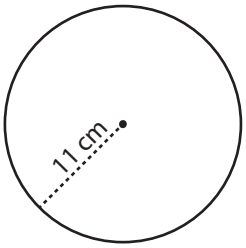

Radius = _____

Diameter = _____

6)

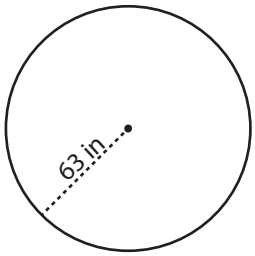

Radius = _____

Diameter = _____

7)

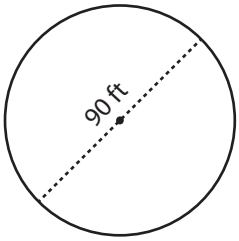

Radius = _____

Diameter = _____

8)

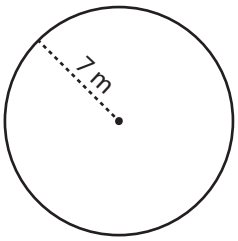

Radius = _____

Diameter = _____

9)

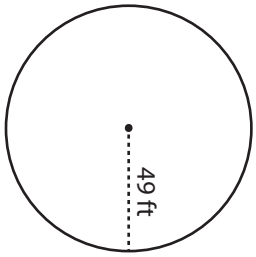

Radius = _____

Diameter = _____

10)

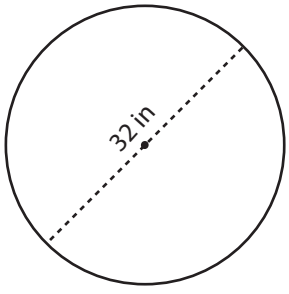

Radius = _____

Diameter = _____

11)

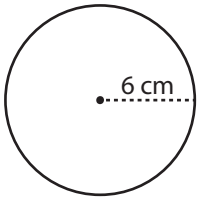

Radius = _____

Diameter = _____

12)

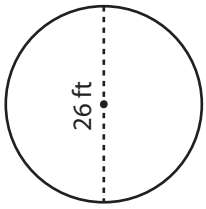

Radius = _____

Diameter = _____

Name : _____ **Answer Key** Score : _____

Easy: S3

Radius / Diameter

Find the radius or diameter of each circle.

1) 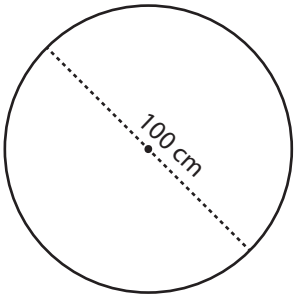

Radius = **50 cm**

Diameter = **100 cm**

2) 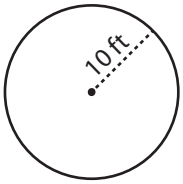

Radius = **10 ft**

Diameter = **20 ft**

3) 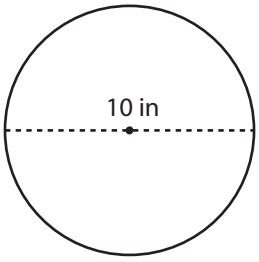

Radius = **5 in**

Diameter = **10 in**

4) 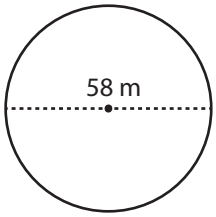

Radius = **29 m**

Diameter = **58 m**

5) 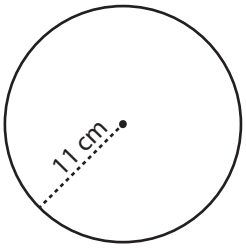

Radius = **11 cm**

Diameter = **22 cm**

6) 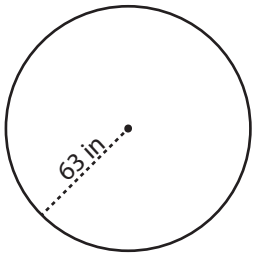

Radius = **63 in**

Diameter = **126 in**

7) 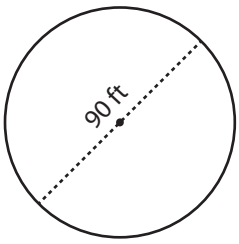

Radius = **45 ft**

Diameter = **90 ft**

8) 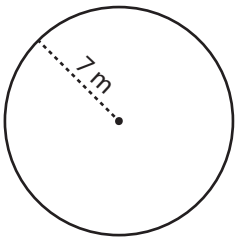

Radius = **7 m**

Diameter = **14 m**

9) 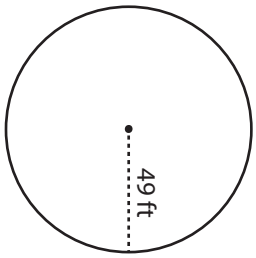

Radius = **49 ft**

Diameter = **98 ft**

10) 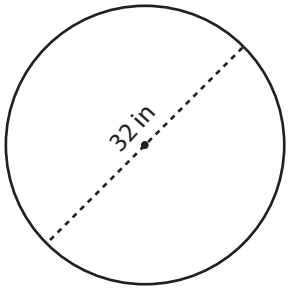

Radius = **16 in**

Diameter = **32 in**

11) 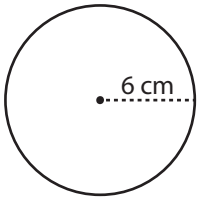

Radius = **6 cm**

Diameter = **12 cm**

12) 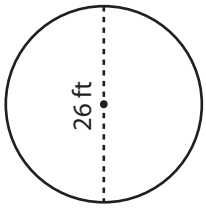

Radius = **13 ft**

Diameter = **26 ft**