Name : _____ Score : _____

Counting Coins & Bills

Level 1: S1

Calculate the total amount in each question; write the correct alphabet to show the item you can buy with that money.

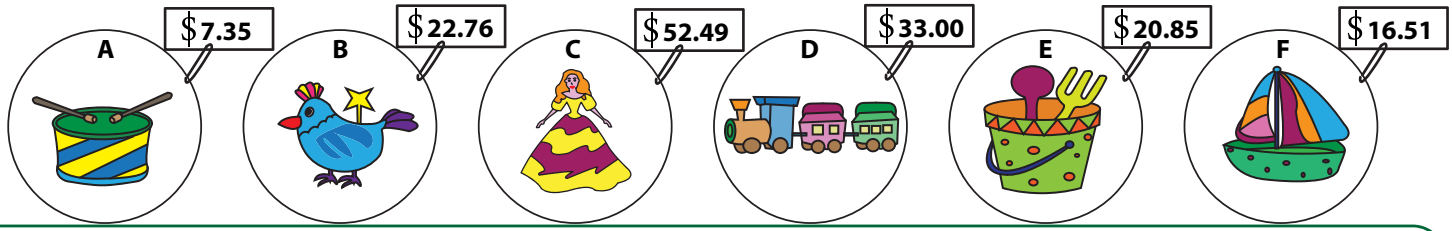

1)

2)

3)

4)

5)

Name : _____ Score : _____

Answer key

Counting Coins & Bills

Level 1: S1

Calculate the total amount in each question; write the correct alphabet to show the item you can buy with that money.

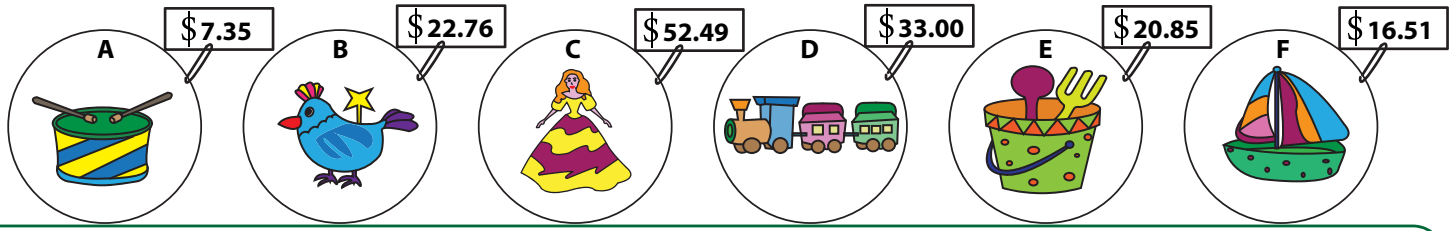

1)

E

2)

F

3)

A

4)

C

5)

D

Name : _____ Score : _____

Counting Coins & Bills

Level 1: S2

Calculate the total amount in each question; write the correct alphabet to show the item you can buy with that money.

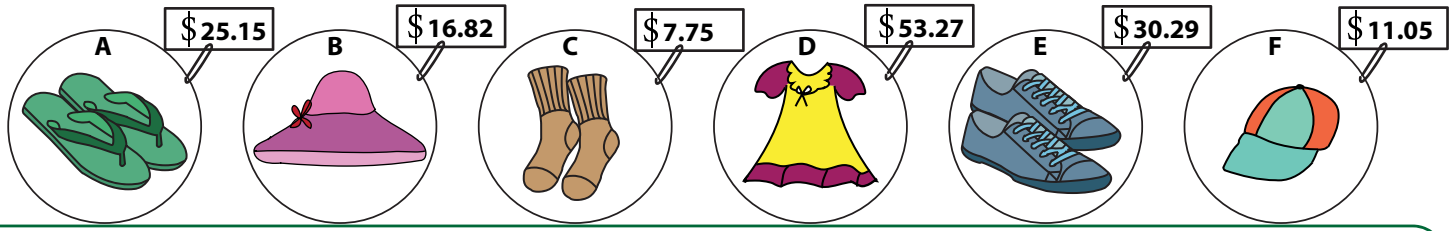

1)

2)

3)

4)



5)

PREVIEW

Access the largest collection of worksheets for just $19.95 per year!

Members, please log in to download this worksheet.

Log in

Not a member? Please sign up to gain complete access.

Sign up

www.mathworksheets4kids.com

Name : _____ Score : _____

Answer key

Counting Coins & Bills

Level 1: S2

Calculate the total amount in each question; write the correct alphabet to show the item you can buy with that money.

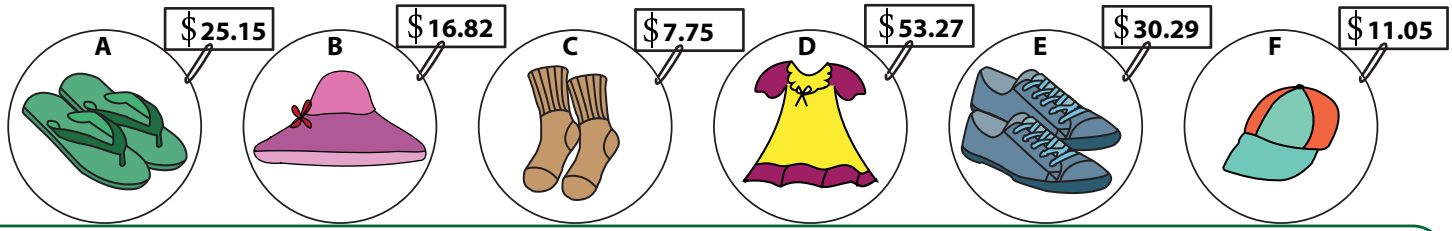

1) F

2) E

3) C

4)  D

5) A

PREVIEW

Access the largest collection of worksheets for just $19.95 per year!

Members, please log in to download this worksheet.

Log in

Not a member? Please sign up to gain complete access.

Sign up

www.mathworksheets4kids.com

Name : _____ Score : _____

Counting Coins & Bills

Level 1: S3

Calculate the total amount in each question; write the correct alphabet to show the item you can buy with that money.

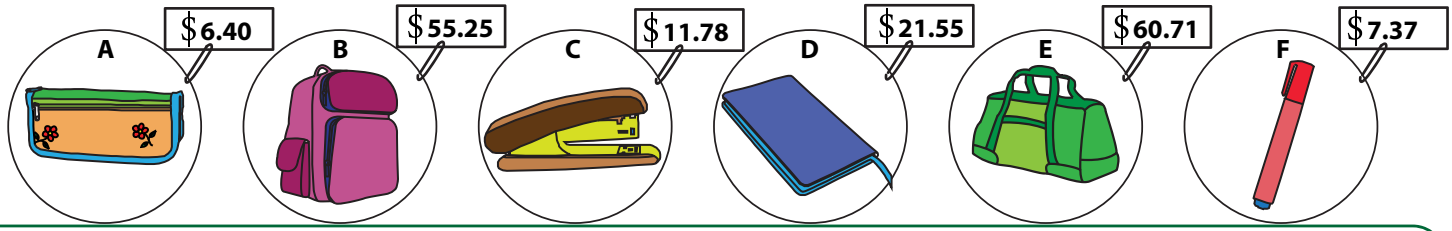

1)

2)

3)

4)

5)

PREVIEW

Access the largest collection of worksheets for just $19.95 per year!

Members, please log in to download this worksheet.

Log in

Not a member? Please sign up to gain complete access.

Sign up

www.mathworksheets4kids.com

Name : _____ Score : _____

Answer key

Counting Coins & Bills

Level 1: S3

Calculate the total amount in each question; write the correct alphabet to show the item you can buy with that money.

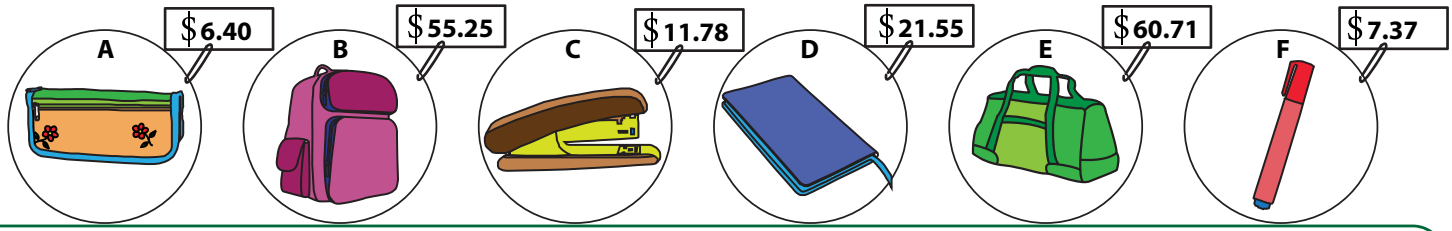

1)

C

2)

F

3)

B

4)

A

5)

D

PREVIEW

Access the largest collection of worksheets for just $19.95 per year!

Members, please log in to download this worksheet.

Log in

Not a member? Please sign up to gain complete access.

Sign up

www.mathworksheets4kids.com

Name : _____ Score : _____

Counting Coins & Bills

Level 2: S1

Calculate the total amount in each question; write the correct alphabet to show the item you can buy with that money.

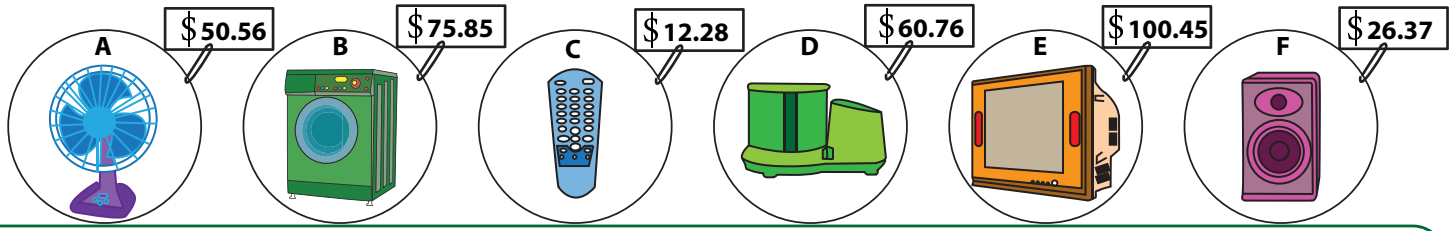

1)



2)

3)

4)

5)

PREVIEW

Access the largest collection of worksheets for just $19.95 per year!

Members, please log in to download this worksheet.

Log in

Not a member? Please sign up to gain complete access.

Sign up

www.mathworksheets4kids.com

Name : _____ Score : _____

Answer key

Counting Coins & Bills

Level 2: S1

Calculate the total amount in each question; write the correct alphabet to show the item you can buy with that money.

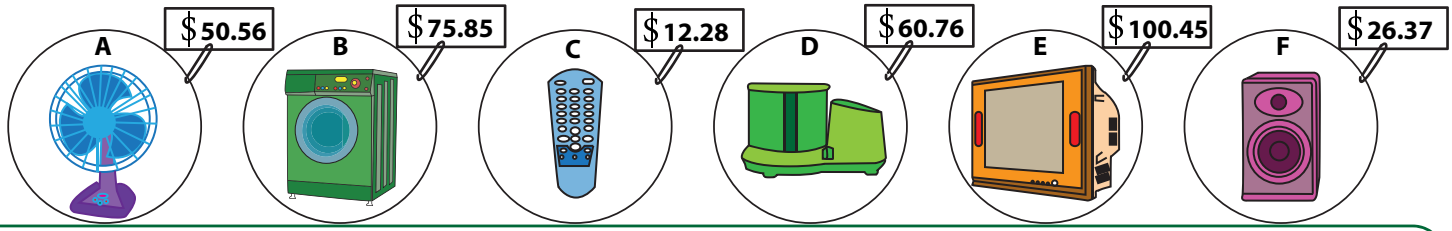

1) 

A

2)

C

3)

D

4) 

B

5)

E

PREVIEW

Access the largest collection of worksheets for just $19.95 per year!

Members, please log in to download this worksheet.

Log in

Not a member? Please sign up to gain complete access.

Sign up

www.mathworksheets4kids.com

Name : _____ Score : _____

Counting Coins & Bills

Level 2: S2

Calculate the total amount in each question; write the correct alphabet to show the item you can buy with that money.

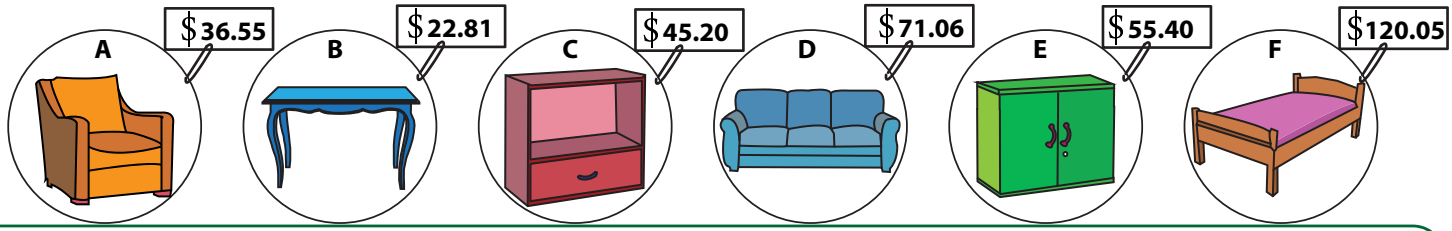

1) 

2)

3)

4)

5)

PREVIEW

Access the largest collection of worksheets for just $19.95 per year!

Members, please log in to download this worksheet.

Log in

Not a member? Please sign up to gain complete access.

Sign up

www.mathworksheets4kids.com

Name : _____ Score : _____

Answer key

Counting Coins & Bills

Level 2: S2

Calculate the total amount in each question; write the correct alphabet to show the item you can buy with that money.

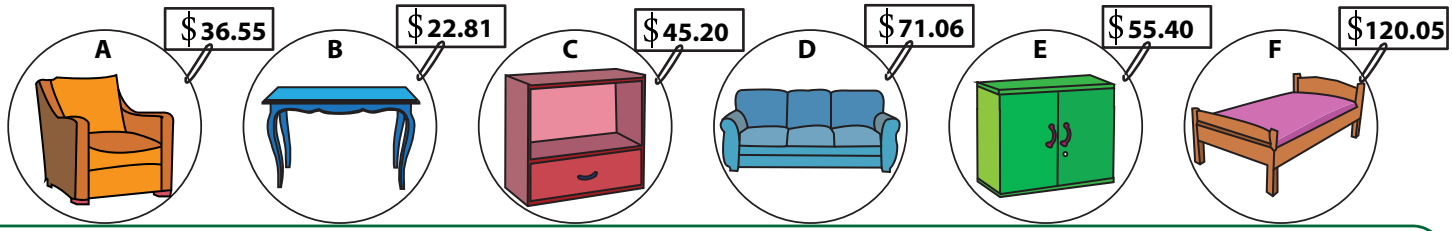

1)

B

2)

D

3)

F

4)

A

5) 

C

PREVIEW

Access the largest collection of worksheets for just $19.95 per year!

Members, please log in to download this worksheet.

Log in

Not a member? Please sign up to gain complete access.

Sign up

www.mathworksheets4kids.com

Name : _____ Score : _____

Counting Coins & Bills

Level 2: S3

Calculate the total amount in each question; write the correct alphabet to show the item you can buy with that money.

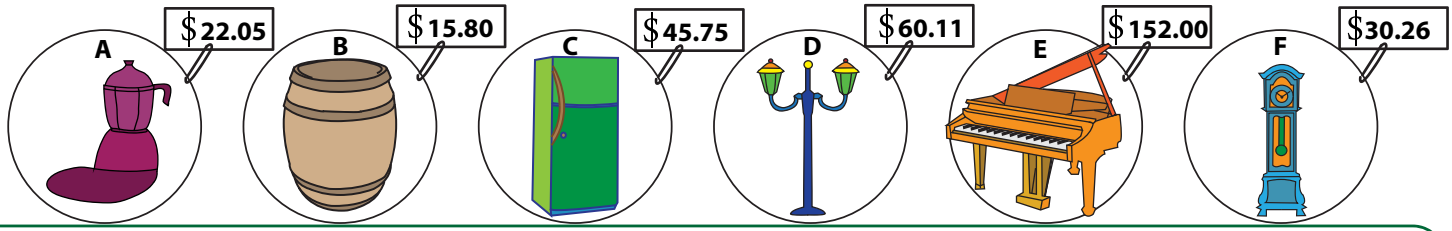

1)

2)

3)

4)

5)

PREVIEW

Access the largest collection of worksheets for just $19.95 per year!

Members, please log in to download this worksheet.

Log in

Not a member? Please sign up to gain complete access.

Sign up

www.mathworksheets4kids.com

Name : _____ Score : _____

Answer key

Counting Coins & Bills

Level 2: S3

Calculate the total amount in each question; write the correct alphabet to show the item you can buy with that money.

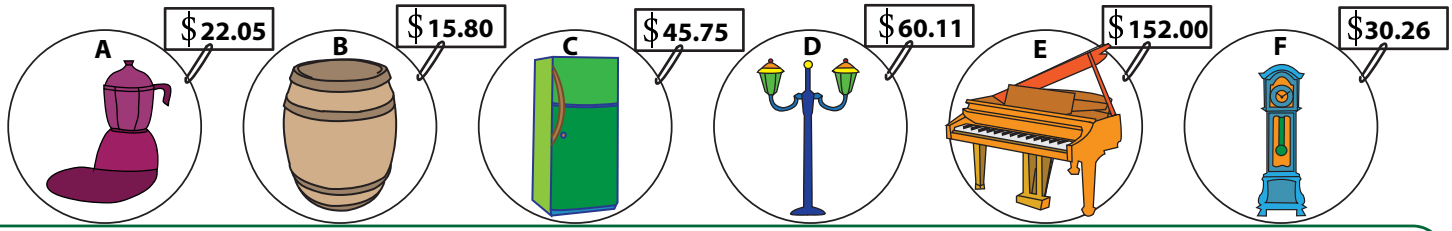

1) F

2) D

3) B

4) C

5) E

PREVIEW

Access the largest collection of worksheets for just $19.95 per year!

Members, please log in to download this worksheet.

Log in

Not a member? Please sign up to gain complete access.

Sign up

www.mathworksheets4kids.com