Name : _____ Score : _____

Comparing Money

Coins: S1

Shirley and her friends went to shop to buy some pencils.
Use <, > or = symbols to compare the money in their wallets.

1) Shirley has $ _____

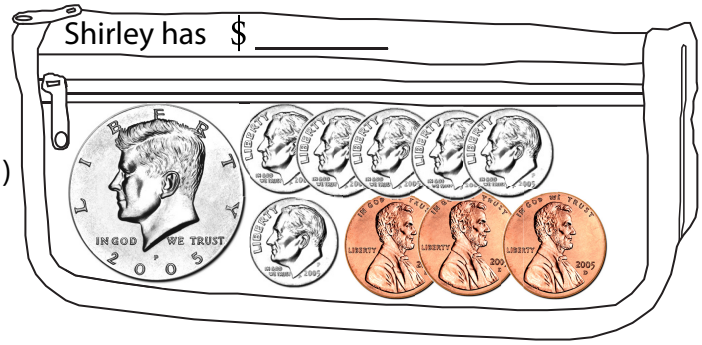

_____

Nancy has $ _____



2) Linda has $ _____

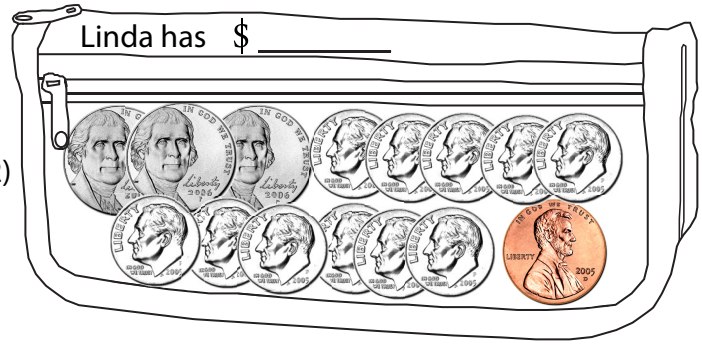

_____

Susan has $ _____



3) Amy has $ _____

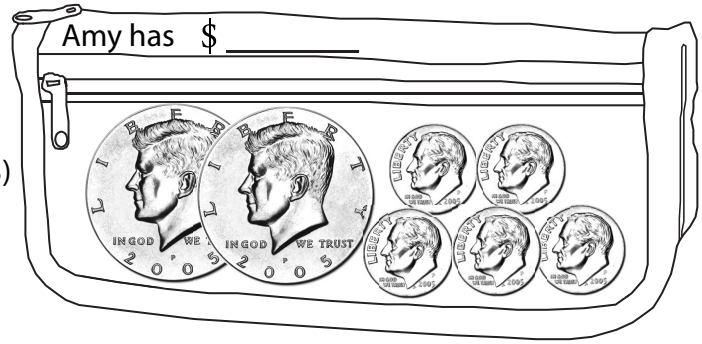

_____

Rose has $ _____

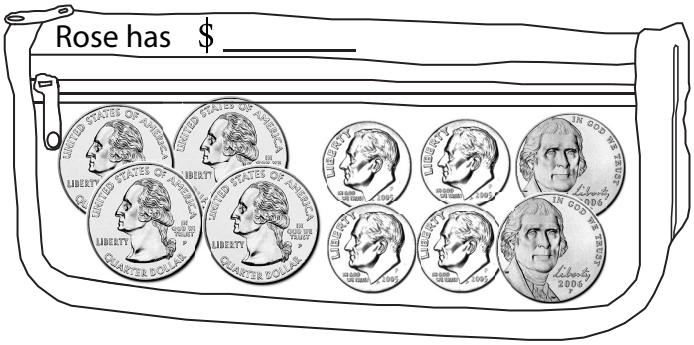

4) Angela has $ _____

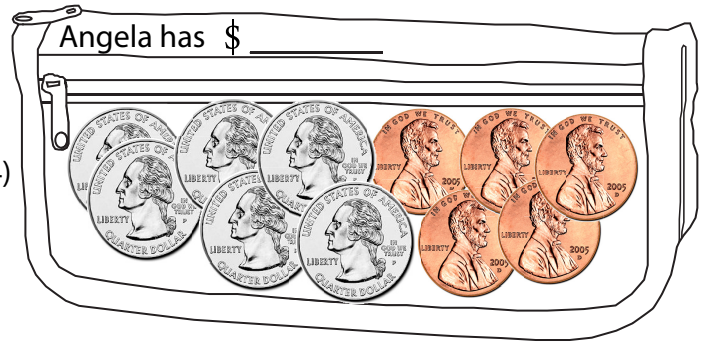

_____

Jenifer has $ _____



5) Who has the most money between the friends? _____

6) Who has the least money between the friends? _____

7) I have exactly ten coins with no pennies. Who am I? _____

Name : _____ Score : _____

Answer key

Comparing Money

Coins: S1

Shirley and her friends went to shop to buy some pencils.
Use <, > or = symbols to compare the money in their wallets.

1) Shirley has $ 1.13 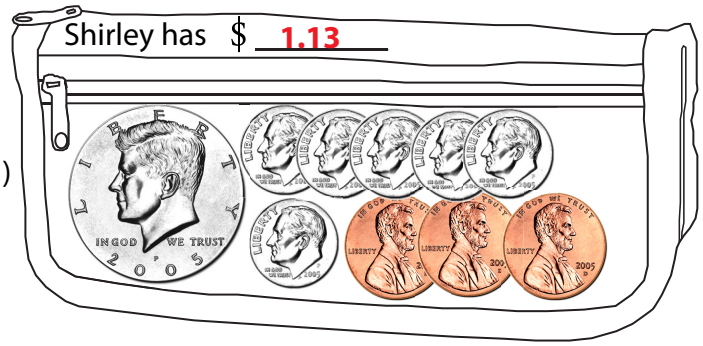 **<** Nancy has $ 2.12 

2) Linda has $ 1.26 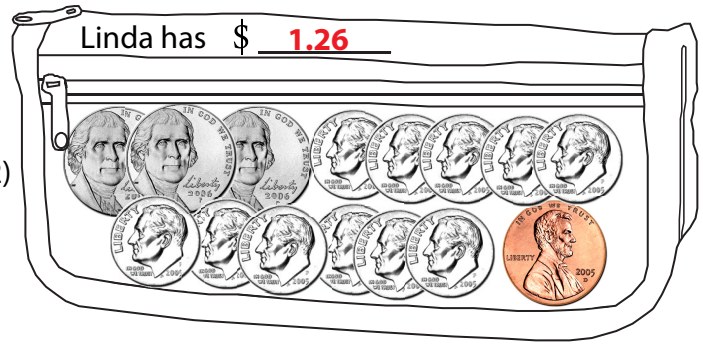 **>** Susan has $ 0.74 

3) Amy has $ 1.50 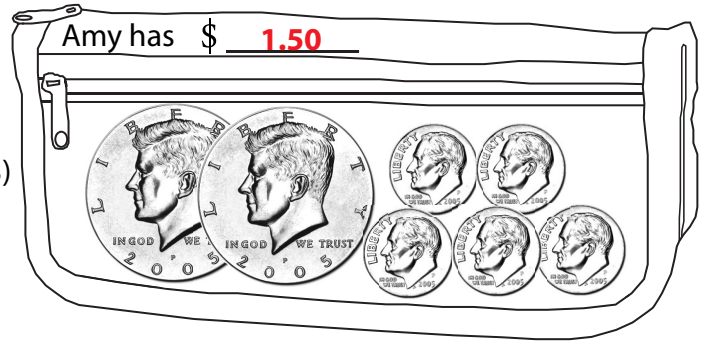 **=** Rose has $ 1.50 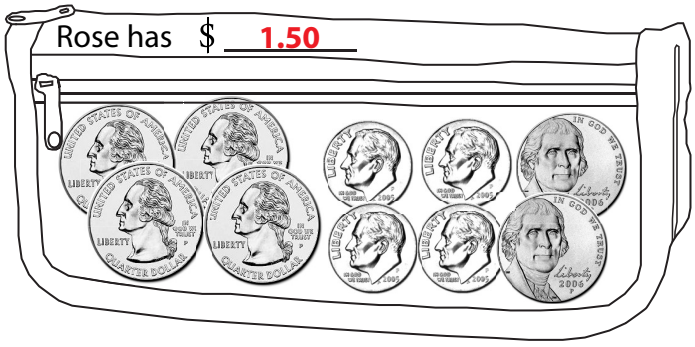

4) Angela has $ 1.55 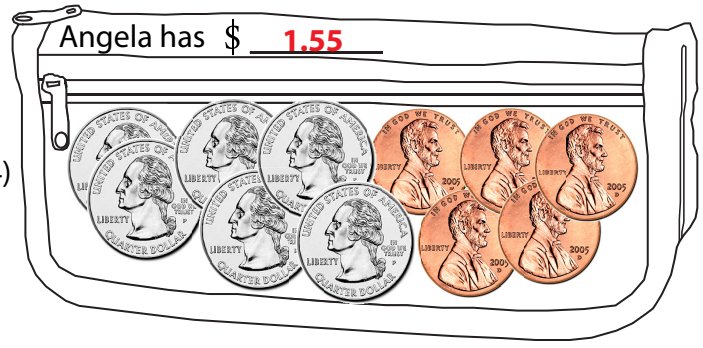 **>** Jenifer has $ 0.35 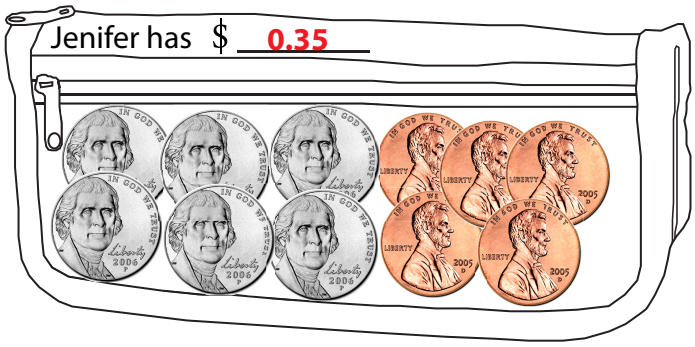

5) Who has the most money between the friends? **Nancy**

6) Who has the least money between the friends? **Jenifer**

7) I have exactly ten coins with no pennies. Who am I? **Rose**

Name : _____ Score : _____

Comparing Money

Coins: S2

Sarah and her friends went to shop to buy some crayons.
Use <, > or = symbols to compare the money in their wallets.

1) Sarah has $ _____



Mary has $ _____

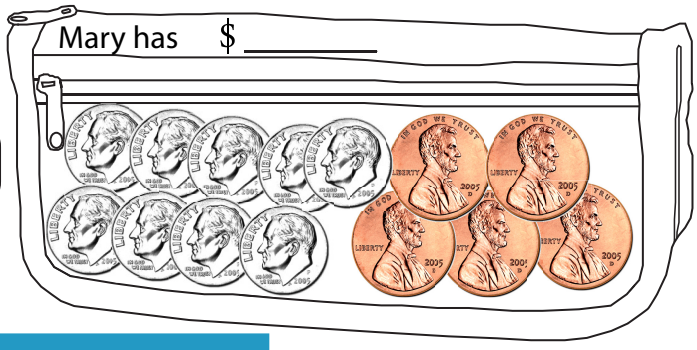

2) Laura has $ _____



_____

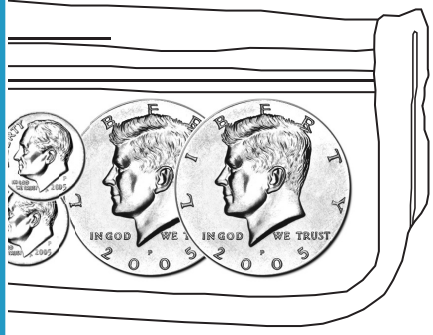

3) Patricia has $ _____

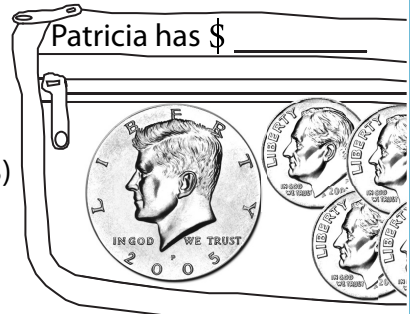

_____

4) Pamela has $ _____



_____

PREVIEW

Access the largest collection of worksheets for just $19.95 per year!

Members, please log in to download this worksheet.

Log in

Not a member? Please sign up to gain complete access.

Sign up

www.mathworksheets4kids.com

5) How many friends have money less than $1.05? _____

6) Who has more money, Mary or Lisa? _____

7) Pamela, Brenda and _____ have equal amount of money.

Name : _____ Score : _____

Answer key

Comparing Money

Coins: S2

Sarah and her friends went to shop to buy some crayons.
Use <, > or = symbols to compare the money in their wallets.

1) Sarah has $ 1.75



>

Mary has $ 0.95

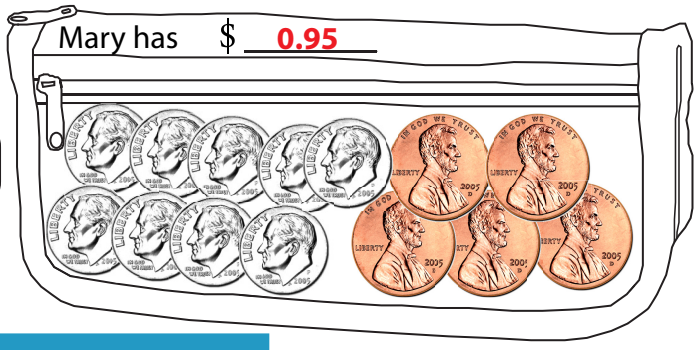

2) Laura has $ 0.55



1.80

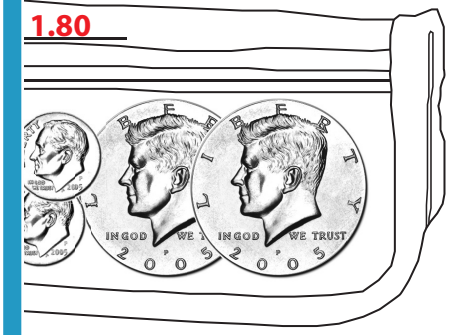

3) Patricia has $ 1.05

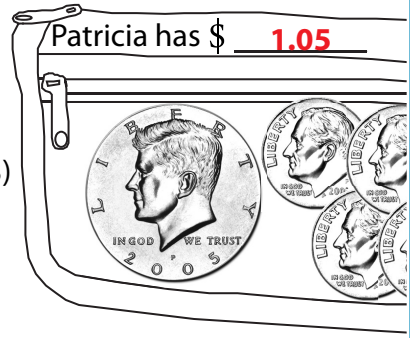

.21



4) Pamela has $ 1.05



1.05



PREVIEW

Access the largest collection of worksheets for just $19.95 per year!

Members, please log in to download this worksheet.

Log in

Not a member? Please sign up to gain complete access.

Sign up

www.mathworksheets4kids.com

5) How many friends have money less than $1.05? 3

6) Who has more money, Mary or Lisa? Mary

7) Pamela, Brenda and Patricia have equal amount of money.

Name : _____ Score : _____

Comparing Money

Coins: S3

Anita and her friends went to shop to buy some erasers.
Use <, > or = symbols to compare the money in their wallets.

1) Anita has $ _____



_____

Sheila has $ _____



2) Virginia has $ _____



_____

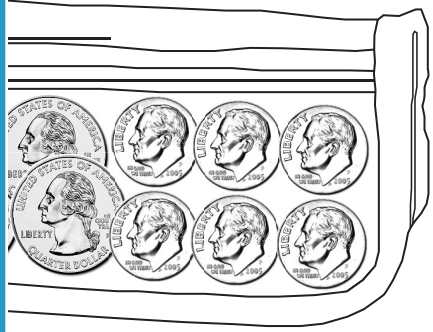

3) Shlvia has $ _____

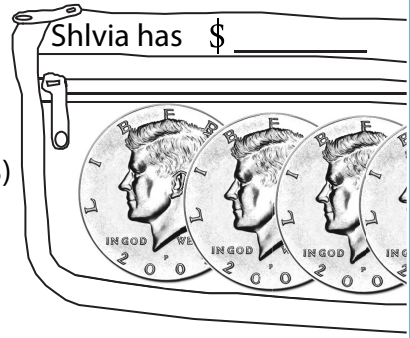

_____



4) Amber has $ _____



_____

PREVIEW

Access the largest collection of worksheets for just $19.95 per year!

Members, please log in to download this worksheet.

Log in

Not a member? Please sign up to gain complete access.

Sign up

www.mathworksheets4kids.com

5) Who has the least money between the friends? _____

6) How many pairs of friends has equal amount of money? _____

7) How much more money does Martha have than Debra? _____

Name : _____ Score : _____

Answer key

Comparing Money

Coins: S3

Anita and her friends went to shop to buy some erasers.
Use <, > or = symbols to compare the money in their wallets.

1) Anita has $ 0.68 = Sheila has $ 0.68





2) Virginia has $ 0.95 ? 2.10



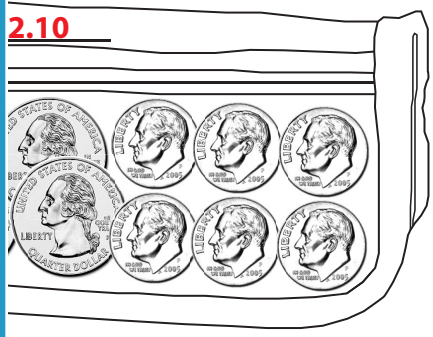

3) Shlvia has $ 2.03 ? 1.03

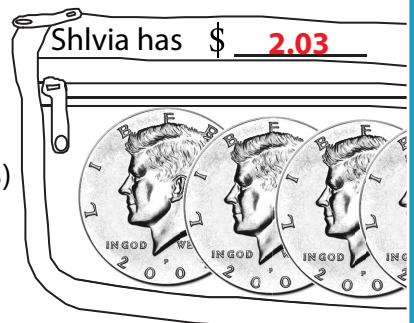

4) Amber has $ 1.25 ? 1.25

PREVIEW

Access the largest collection of worksheets for just $19.95 per year!

Members, please log in to download this worksheet.

Log in

Not a member? Please sign up to gain complete access.

Sign up

www.mathworksheets4kids.com

5) Who has the least money between the friends? Anita & Sheila

6) How many pairs of friends has equal amount of money? 2

7) How much more money does Martha have than Debra? $ 0.85