Name : _____

Equivalent Fractions

Improper Fractions: S3

Example:

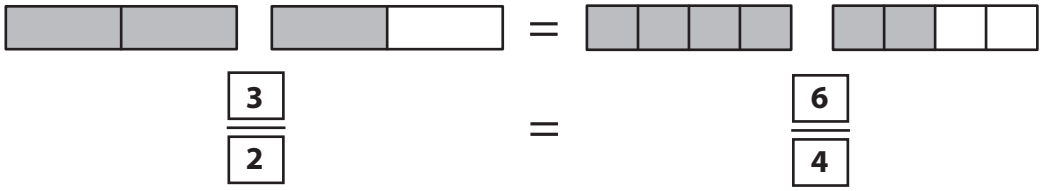

Write the equivalent improper fractions for the fraction bars in each problem.

1) 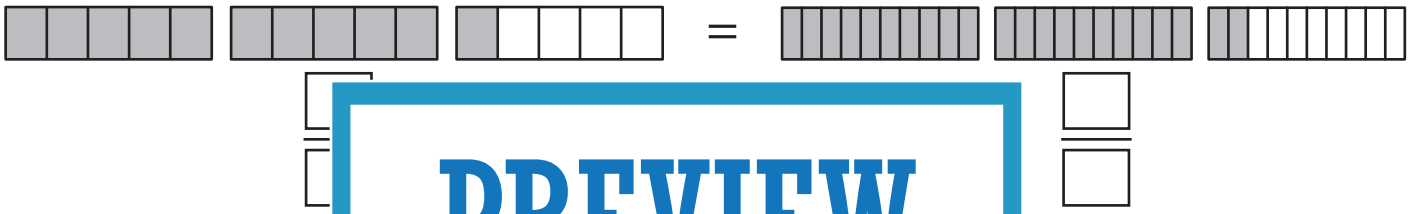

2)

3)

4) 

5) 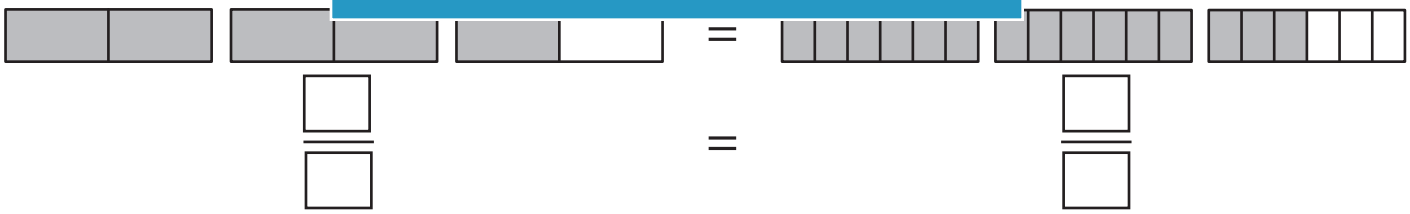

6) 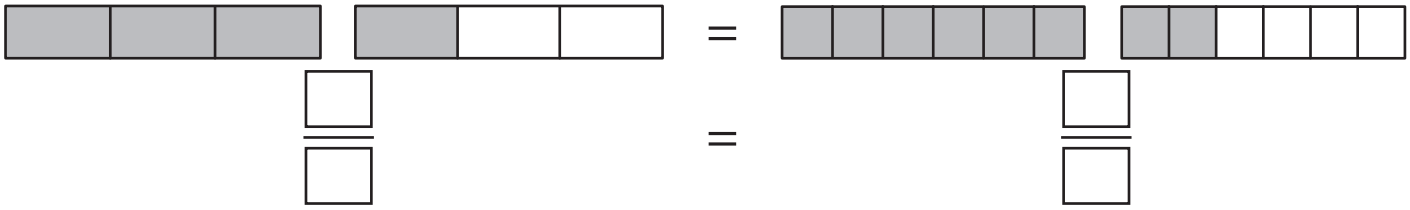

PREVIEW

Gain complete access to the largest collection of worksheets in all subjects!

Members, please log in to download this worksheet.

Not a member? Please sign up to gain complete access.

www.mathworksheets4kids.com

Name : _____

Answer key

Equivalent Fractions

Improper Fractions: S3

Example:

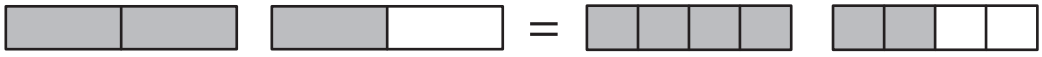

$$\frac{3}{2} = \frac{6}{4}$$

Write the equivalent improper fractions for the fraction bars in each problem.

1) 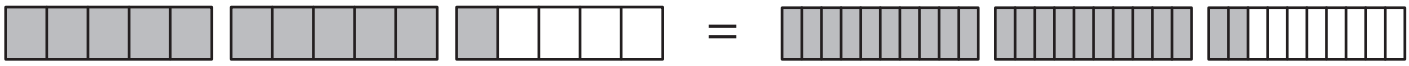

$$\frac{1}{\ } = \frac{22}{10}$$

2)

$$\frac{\ }{\ } = \frac{15}{9}$$

3)

$$\frac{1}{\ } = \frac{24}{10}$$

4)

$$\frac{\ }{\ } = \frac{21}{12}$$

5)

$$\frac{5}{2} = \frac{15}{6}$$

6) 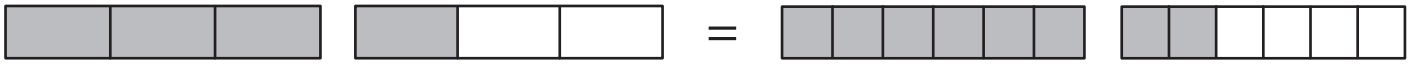

$$\frac{4}{3} = \frac{8}{6}$$

PREVIEW

Gain complete access to the largest collection of worksheets in all subjects!

Members, please log in to download this worksheet.

Not a member? Please sign up to gain complete access.

www.mathworksheets4kids.com