Name : _____ Score : _____

Lines, Rays or Line segments: MCQ

Sheet 2

1) Which one of the following is a line?

a) b) c) d)

2) Which one of the following is a ray?

a) b) c) d)

3) Which one of the following is a line segment?

a) b) 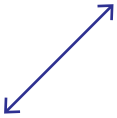 c) d)

4) Which one of the following is a line?

a) b) c) d)

5) Which one of the following is a line segment?

a) b) c) d)

6) Which one of the following is a ray?

a) b) 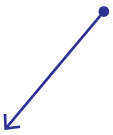 c) d)

7) Which one of the following is a line?

a) b) c) d)

Name : _____ Score : _____

Answer Key

Lines, Rays or Line segments: MCQ

Sheet 2

1) Which one of the following is a line?

a) b) c) d)

2) Which one of the following is a ray?

a) b) c) d)

3) Which one of the following is a line segment?

a) b) 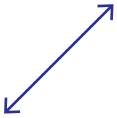 c) d)

4) Which one of the following is a line?

a) b) c) d)

5) Which one of the following is a line segment?

a) b) c) d)

6) Which one of the following is a ray?

a) b) 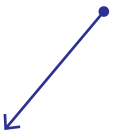 c) d)

7) Which one of the following is a line?

a) b) c) d)