Name : _____ Score : _____

Points, Lines, Rays & Line segments

Sheet 1

Part - A

Write each as a point, line, ray or line segment.

1) 

_____

2) 

_____

3)

_____

4) 

_____

5) 

_____

6) 

_____

Part - B

Draw the following.

1) A line

2) A ray

3) A line segment

Name : _____ Score : _____

Answer Key

Points, Lines, Rays & Line segments

Sheet 1

Part - A

Write each as a point, line, ray or line segment.

1) 

line segment

2) 

line

3)

point

4) 

ray

5) 

line segment

6) 

line

Part - B

Draw the following.

1) A line

2) A ray



3) A line segment