Student Name: _____ **Score:**

Addition Using Number Line

Sum up to 15: S2

Draw hops to show the addition sentence and find the sum.

1)

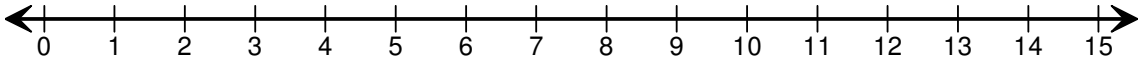

7 + **3** = ☐

2)

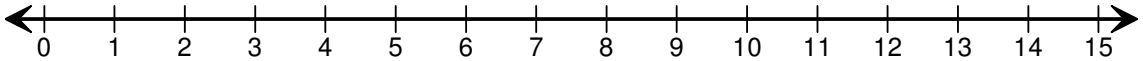

7 + **7** = ☐

3)

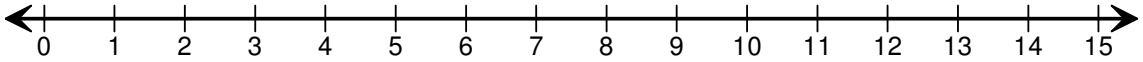

6 + **9** = ☐

4)

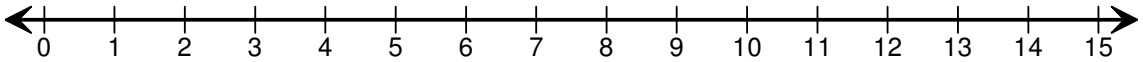

4 + **10** = ☐

5)

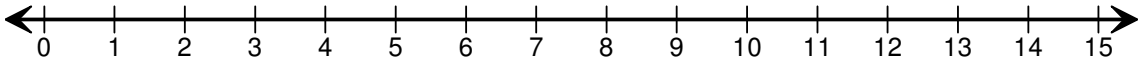

12 + **1** = ☐

Student Name: _____ **Score:**

Answer key

Addition Using Number Line

Sum up to 15: S2

1)

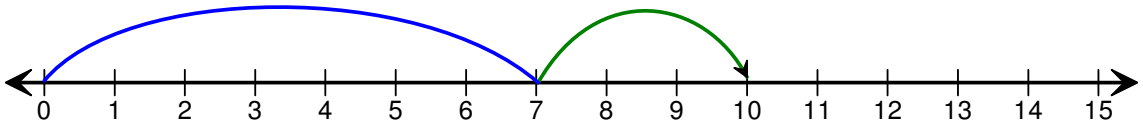

7 + **3** = **10**

2)

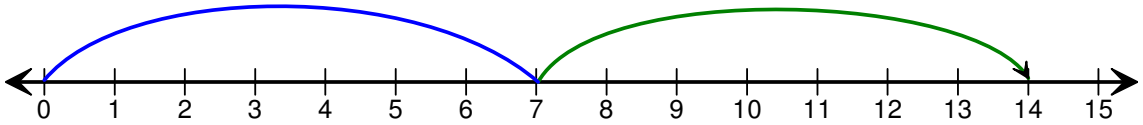

7 + **7** = **14**

3)

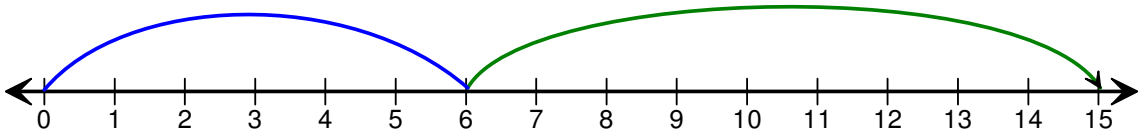

6 + **9** = **15**

4)

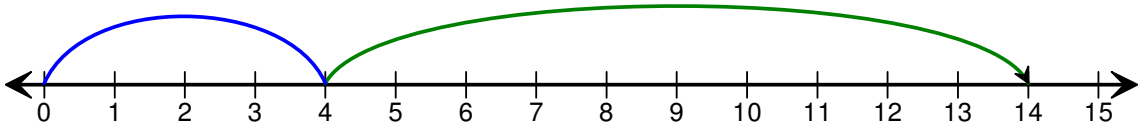

4 + **10** = **14**

5)

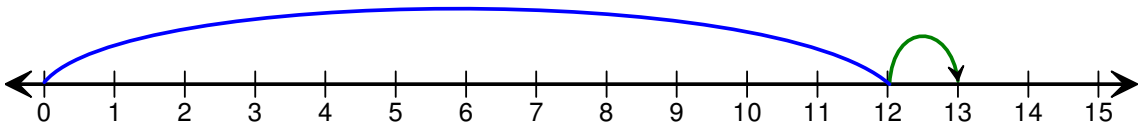

12 + **1** = **13**