Student Name: _____ **Score:**

Identify the Fraction

Mixed

What fraction do the letter points to?

1)



A = _____	B = _____	C = _____
D = _____	E = _____	F = _____

2)

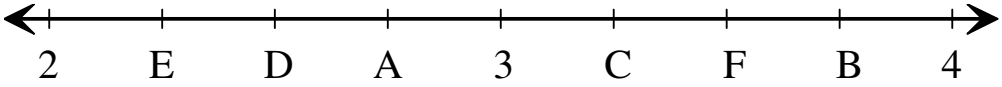

A = _____	B = _____	C = _____
D = _____	E = _____	F = _____

3)

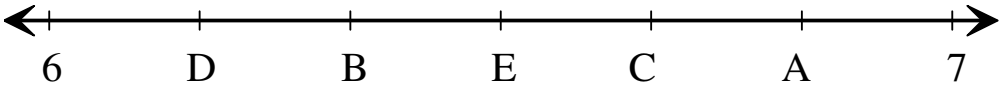

A = _____	B = _____	C = _____
D = _____	E = _____	

4)

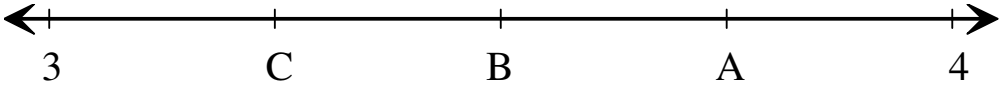

A = _____	B = _____	C = _____

Student Name: _____ **Score:**

Answer key

Identify the Fraction

Mixed

1)



A = $8\frac{3}{7}$	B = $8\frac{6}{7}$	C = $8\frac{2}{7}$
D = $8\frac{5}{7}$	E = $8\frac{1}{7}$	F = $8\frac{4}{7}$

2)

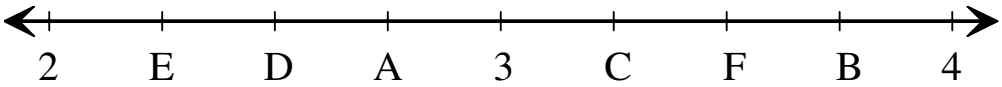

A = $2\frac{3}{4}$	B = $3\frac{3}{4}$	C = $3\frac{1}{4}$
D = $2\frac{1}{2}$	E = $2\frac{1}{4}$	F = $3\frac{1}{2}$

3)

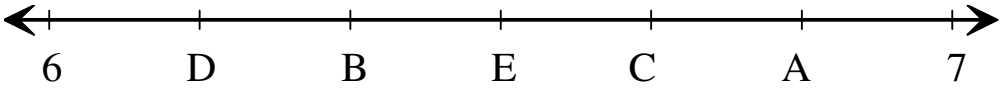

A = $6\frac{5}{6}$	B = $6\frac{1}{3}$	C = $6\frac{2}{3}$
D = $6\frac{1}{6}$	E = $6\frac{1}{2}$	

4)

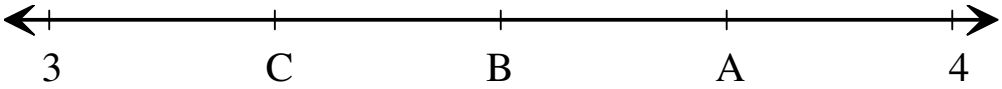

A = $3\frac{3}{4}$	B = $3\frac{1}{2}$	C = $3\frac{1}{4}$