Name : _____ Score : _____

Odd or Even: Race Horses

Sheet 2

Look at the number on each race horse. Write odd or even.

1) 

_____

2) 

_____

3) 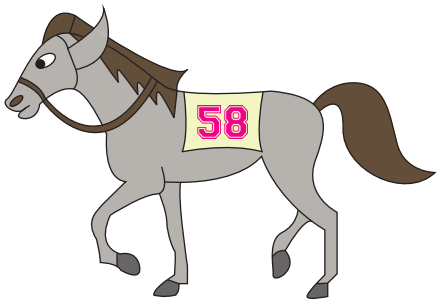

_____

4)

_____

5) 

_____

6)

_____

7)

_____

8) 

_____

Name : _____ Score : _____

Answer Key

Odd or Even: Race Horses

Sheet 2

Look at the number on each race horse. Write odd or even.

1) 

odd

2) 

even

3) 

even

4)

odd

5) 

odd

6)

even

7)

even

8) 

odd