Name : _____ Score : _____

Sheet 2

Moving the Points

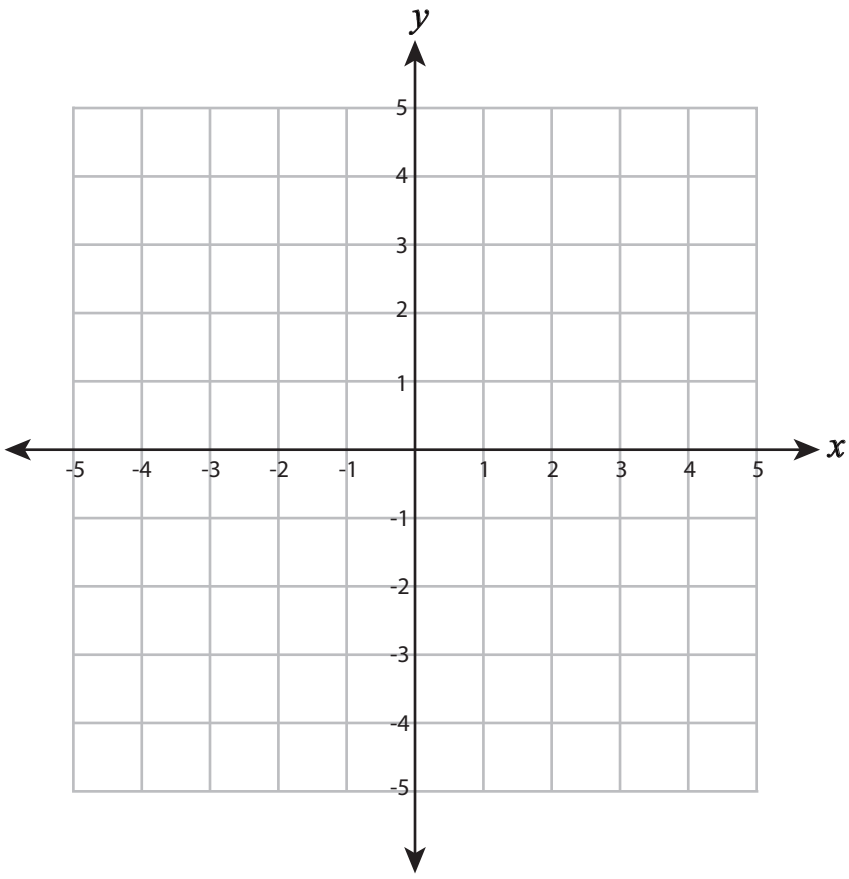

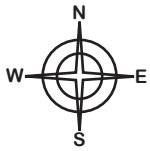

Find the coordinates of each end point.

Start	Direction	End
(-5, -5)	6 units north and 2 units east	
(3, 2)	7 units west and 4 units south	
(0, -5)	8 units north and 5 units east	
(1, -2)	3 units east and 2 units south	
(-3, -2)	5 units east and 4 units north	

1) You are at (-1, 3). Move 3 units west and 2 units north. Where do you land? _____

2) You are at (4, 4). Move 5 units south and 5 units west. Where do you land? _____

Name : _____ **Answer key** Score : _____

Sheet 2

Moving the Points

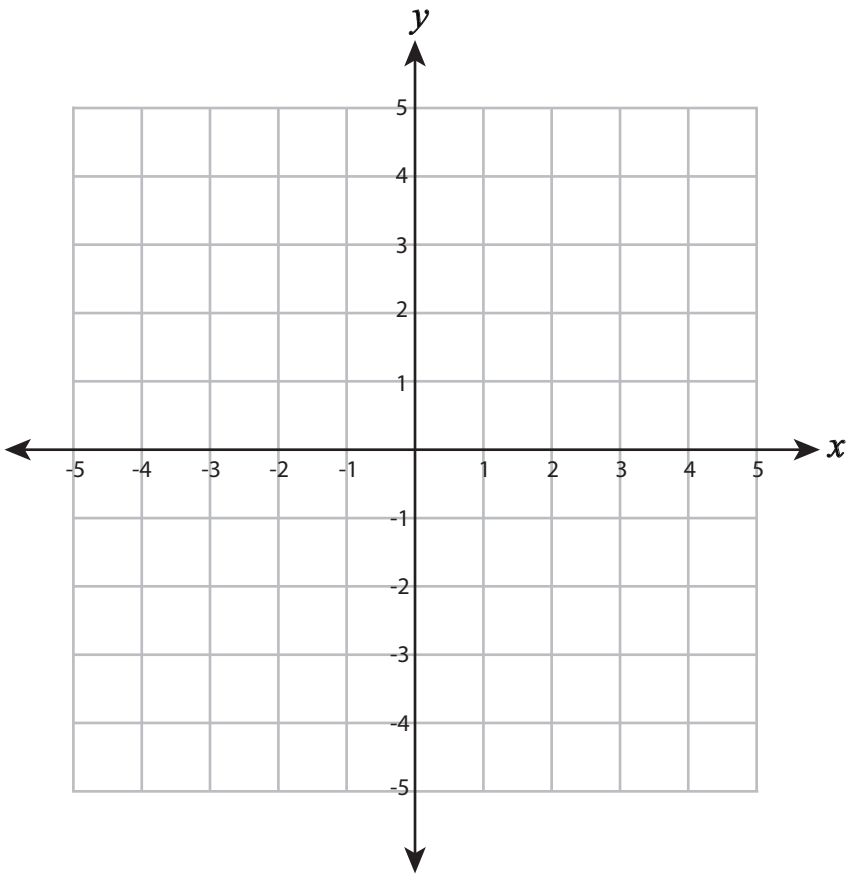

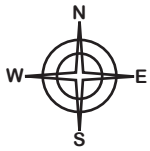

Find the coordinates of each end point.

Start	Direction	End
(-5, -5)	6 units north and 2 units east	**(-3, 1)**
(3, 2)	7 units west and 4 units south	**(-4, -2)**
(0, -5)	8 units north and 5 units east	**(5, 3)**
(1, -2)	3 units east and 2 units south	**(4, -4)**
(-3, -2)	5 units east and 4 units north	**(2, 2)**

1) You are at (-1, 3). Move 3 units west and 2 units north. Where do you land? **(-4, 5)**

2) You are at (4, 4). Move 5 units south and 5 units west. Where do you land? **(-1, -1)**