Name : _____ Score : _____

Plotting Points

Positive: S2

A) Plot each point on the coordinate grid.

1) V(5, 5)
2) H(2, 9)
3) I(9, 3)
4) K(1, 6)
5) N(10, 4)
6) U(5, 10)
7) O(0, 8)
8) M(7, 3)
9) T(6, 4)
10) A(8, 4)

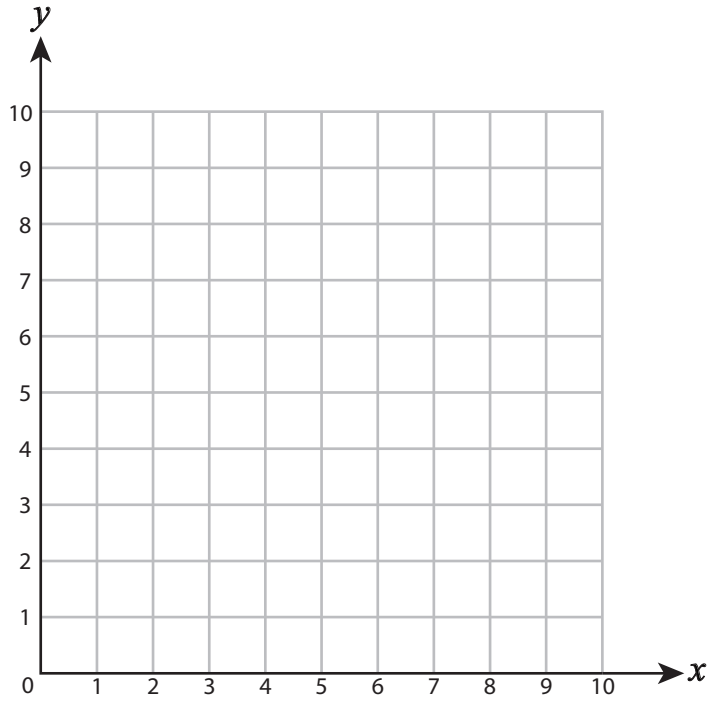

B) Draw each shape on the coordinate grid.

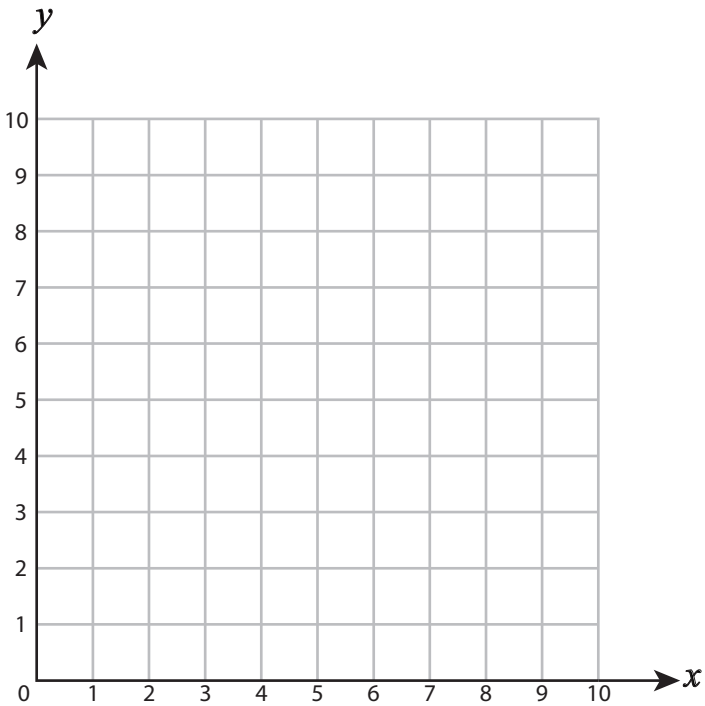

11) Draw ○ at (10, 3)

12) Draw ☆ at (0, 7)

13) Draw ▭ at (5, 2)

14) Draw △ at (1, 6)

15) Draw □ at (9, 9)

Name : _____ Score : _____

Answer key

Positive: S2

Plotting Points

A) Plot each point on the coordinate grid.

1) V(5, 5)
2) H(2, 9)
3) I(9, 3)
4) K(1, 6)
5) N(10, 4)
6) U(5, 10)
7) O(0, 8)
8) M(7, 3)
9) T(6, 4)
10) A(8, 4)

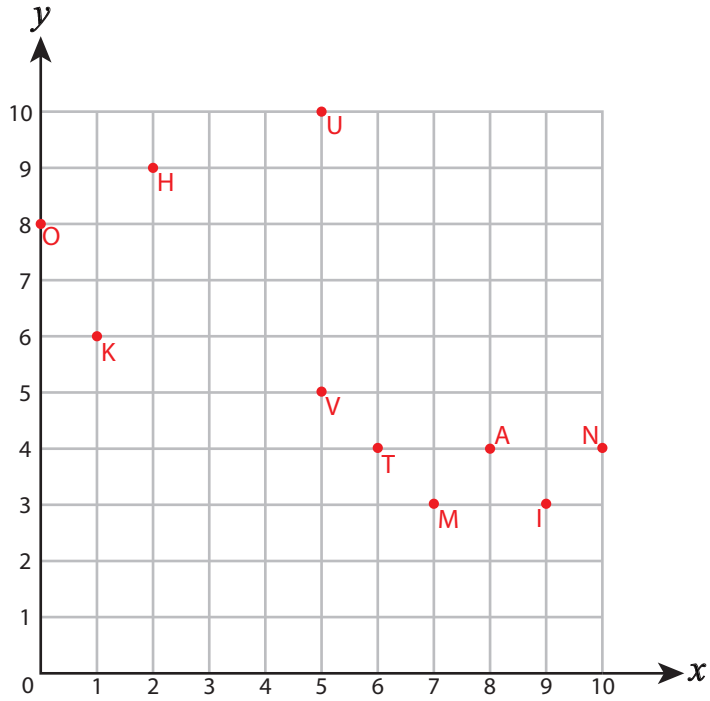

B) Draw each shape on the coordinate grid.

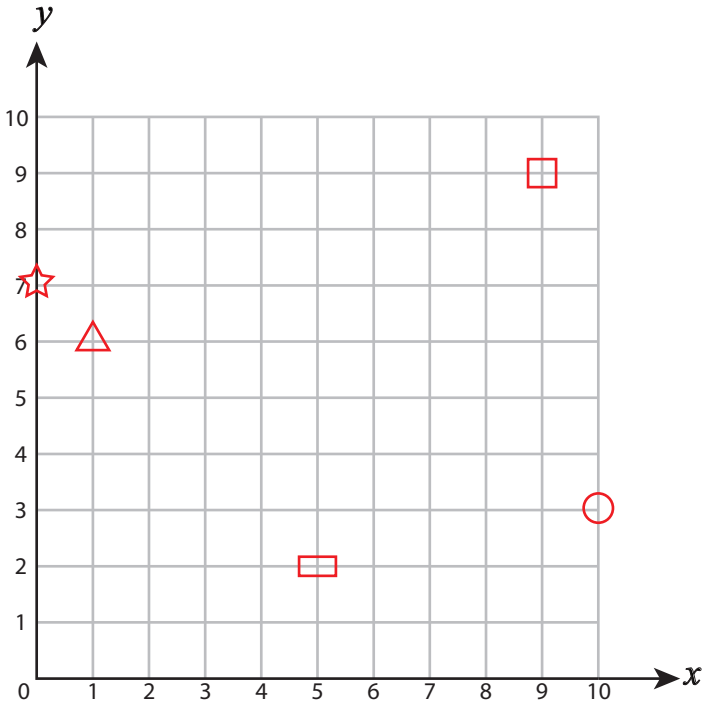

11) Draw ○ at (10, 3)

12) Draw ☆ at (0, 7)

13) Draw ▭ at (5, 2)

14) Draw △ at (1, 6)

15) Draw □ at (9, 9)