Name : _____

DS3

Parallelogram - Finding Base/Height

Find the base or height of each parallelogram.

1)

Height = _____

2)

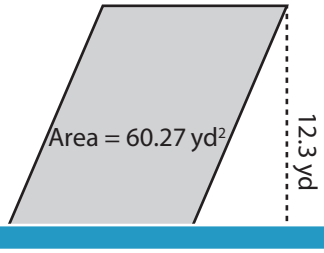

3)

ight = _____

4)

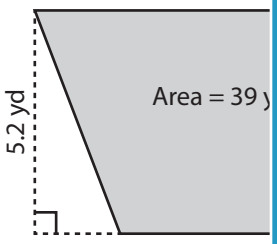

Base = _____

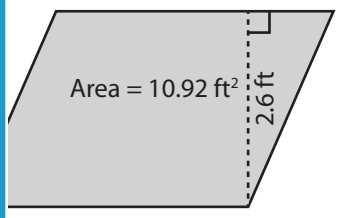

Base = _____

7)

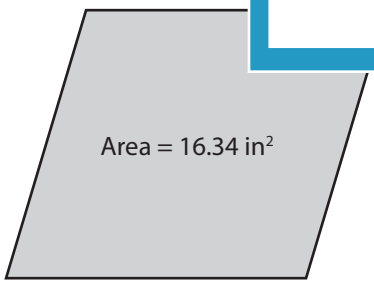

Height = _____

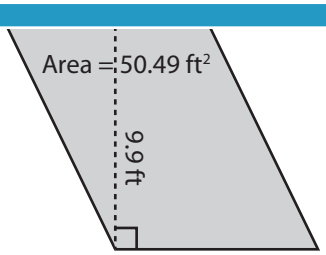

Base = _____

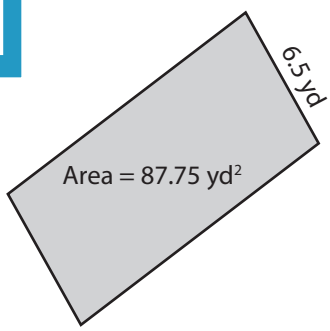

Height = _____

PREVIEW

Access the largest collection of worksheets for just $19.95 per year!

Members, please log in to download this worksheet.

Log in

Not a member? Please sign up to gain complete access.

Sign up

www.mathworksheets4kids.com

Name : _____

Answer key

Parallelogram - Finding Base/Height

DS3

Find the base or height of each parallelogram.

1)

Height = **8.4 ft**

2)

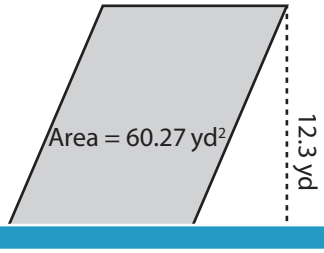

3)

Height = **14.9 in**

4)

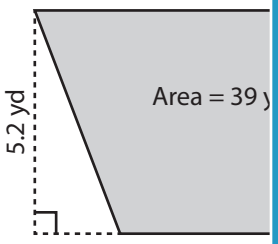

Base = **7.5 y**

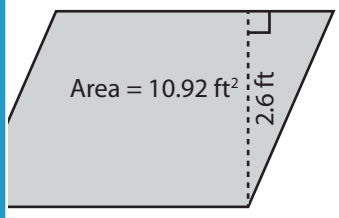

Base = **4.2 ft**

7)

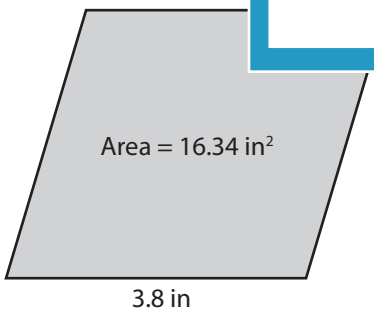

Height = **4.3 in**

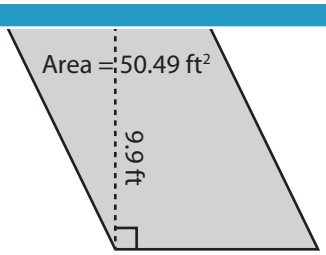

Base = **5.1 ft**

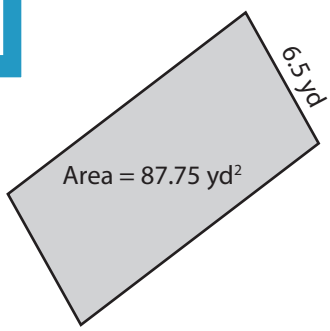

Height = **13.5 yd**

PREVIEW

Access the largest collection of worksheets for just **$19.95** per year!

Members, please log in to download this worksheet.

Log in

Not a member? Please sign up to gain complete access.

Sign up

www.mathworksheets4kids.com