Name : _____ Score : _____

Sheet 1

Weight Estimation - Metric Units

Choose the object close to the given weight.

1) 3 kilograms

-
-
-

2) 150 grams

- 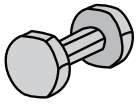
-

-

3) 100 grams

-
-

-

4) 1 kilogram

-
-
-

5) 1.5 kilograms

-

-
-

6) 700 grams

-

- 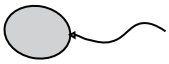
-

7) 5 grams

-

-
-

8) 2 kilograms

-

-
-

Name : _____ Score : _____

Answer key

Weight Estimation - Metric Units

Sheet 1

Choose the object close to the given weight.

1) 3 kilograms

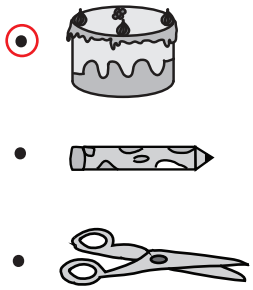

2) 150 grams

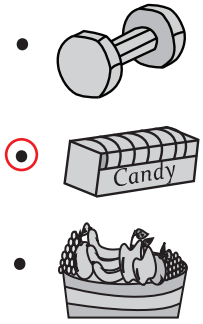

3) 100 grams



4) 1 kilogram

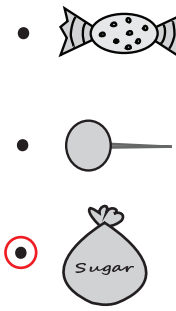

5) 1.5 kilograms

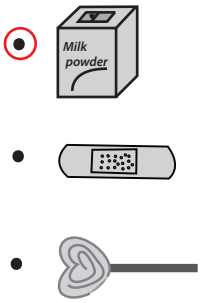

6) 700 grams

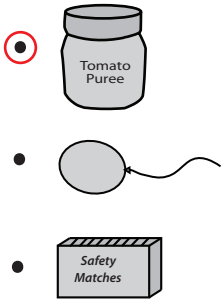

7) 5 grams

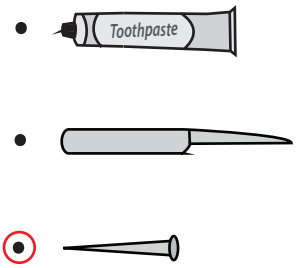
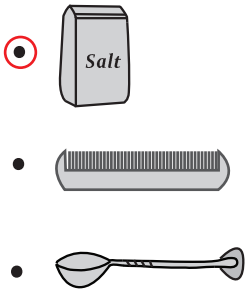
8) 2 kilograms