Name : _____ Score : _____

Estimation vs Exact Measure

Sheet 2

Estimate the measure of each angle. Also find the exact measure using protractor.

1)

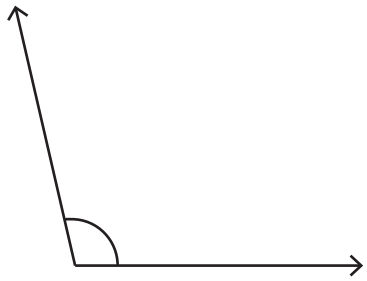

Estimation : _____

Exact measure : _____

2)

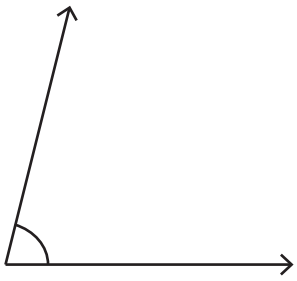

Estimation : _____

Exact measure : _____

3)

Estimation : _____

Exact measure : _____

5)

Estimation : _____

Exact measure : _____

7)

Estimation : _____

Exact measure : _____

8)

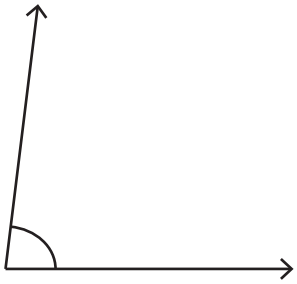

Estimation : _____

Exact measure : _____

PREVIEW

Access the largest collection of worksheets for just $19.95 per year!

Members, please log in to download this worksheet.

Log in

Not a member? Please sign up to gain complete access.

Sign up

www.mathworksheets4kids.com

Name : _____ Score : _____

Answer Key

Estimation vs Exact Measure

Sheet 2

Estimate the measure of each angle. Also find the exact measure using protractor.

1)

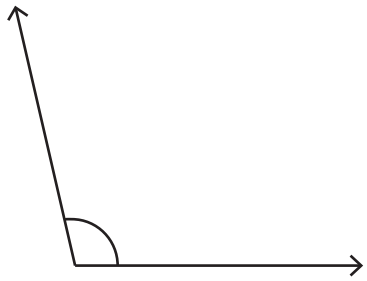

Estimation : 99^0 - 107^0

Exact measure : 103^0

2)

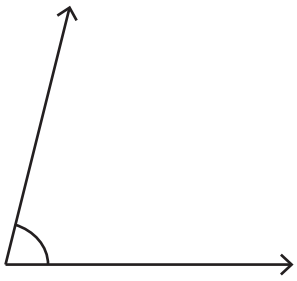

Estimation : 72^0 - 80^0

Exact measure : 76^0

3)

Estimation : 121^0 - 129^0

Exact measure : 125^0

5)

Estimation : 63^0 - 71^0

Exact measure : 67^0

7)

Estimation : 170^0 - 178^0

Exact measure : 174^0

8)

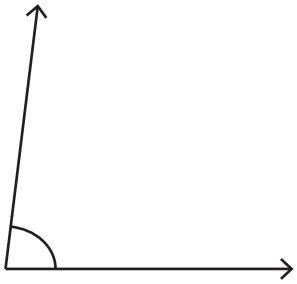

Estimation : 79^0 - 87^0

Exact measure : 83^0

PREVIEW

Access the largest collection of worksheets for just $19.95 per year!

Members, please log in to download this worksheet.

Log in

Not a member? Please sign up to gain complete access.

Sign up

www.mathworksheets4kids.com