Name : _____ Score : _____

Measuring Angles

Easy: S3

Measure each angle using protractor.

1)

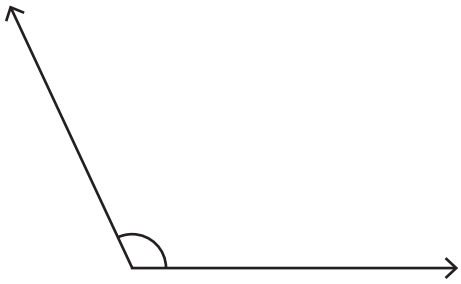

Angle : _____

2)

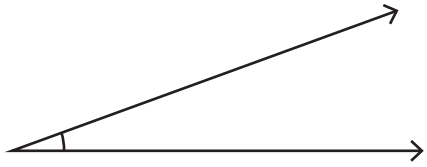

Angle : _____

3)

Angle : _____

5)

Angle : _____

7)

Angle : _____

8)

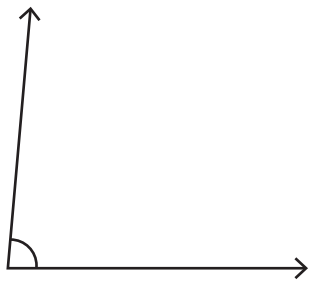

Angle : _____

PREVIEW

Access the largest collection of worksheets for just $19.95 per year!

Members, please log in to download this worksheet.

Log in

Not a member? Please sign up to gain complete access.

Sign up

www.mathworksheets4kids.com

Name : _____ Score : _____

Answer Key

Measuring Angles

Easy: S3

Measure each angle using protractor.

1)

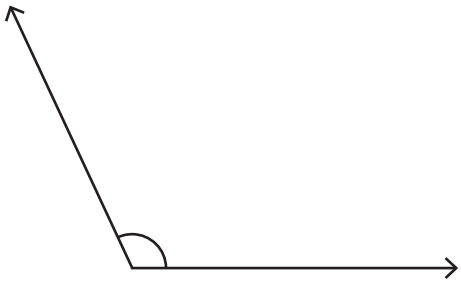

Angle : 115°

2)

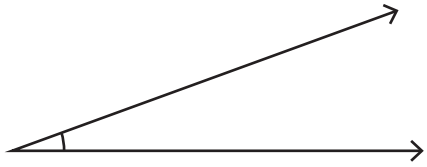

Angle : 20°

3)

Angle : 130°

5)

Angle : 155°

7)

Angle : 170°

8)

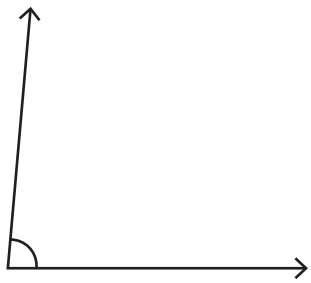

Angle : 85°

PREVIEW

Access the largest collection of worksheets for just $19.95 per year!

Members, please log in to download this worksheet.

Log in

Not a member? Please sign up to gain complete access.

Sign up

www.mathworksheets4kids.com