Name : _____ Score : _____

Angles in a Straight Line

Level 1-Moderate: S1

Find the unknown angle in each problem.

1)

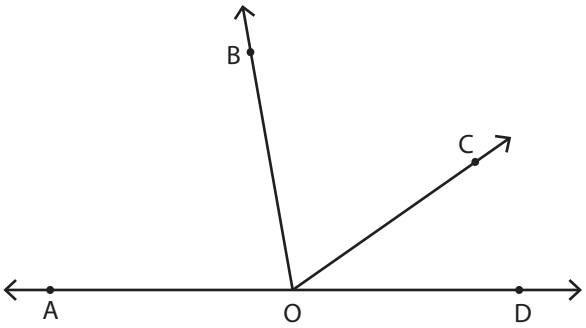

m∠AO
m∠BO
m∠BO

2)

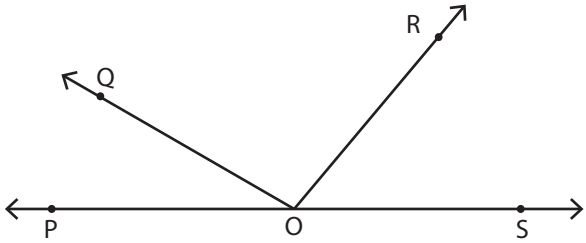

OS = 150^0
OR = 100^0
OS = _____

3)

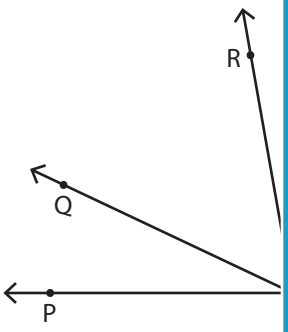



m∠PO
m∠TO
m∠QO

OZ = 65^0
OW = 160^0
OZ = _____

PREVIEW

Access the largest collection of worksheets for just $19.95 per year!

Members, please log in to download this worksheet.

Log in

Not a member? Please sign up to gain complete access.

Sign up

www.mathworksheets4kids.com

5)

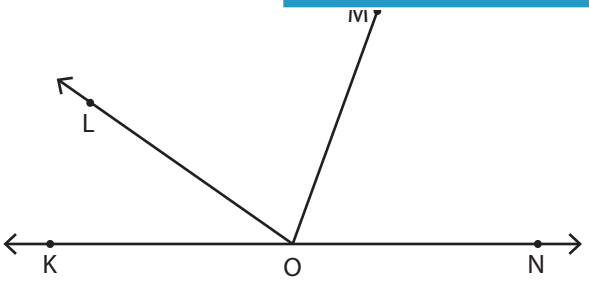

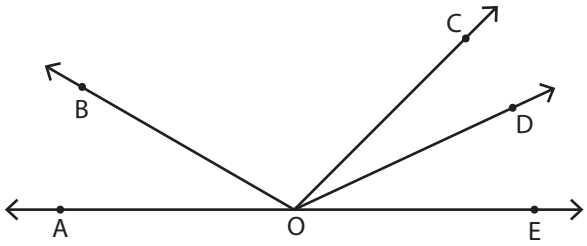

m∠LOM = 75^0
m∠MON = 70^0
m∠LOK = _____

m∠COD = 20^0
m∠AOD = 155^0
m∠COE = _____

Name : _____ **Answer Key** Score : _____

Level 1-Moderate: S1

Angles in a Straight Line

Find the unknown angle in each problem.

1)

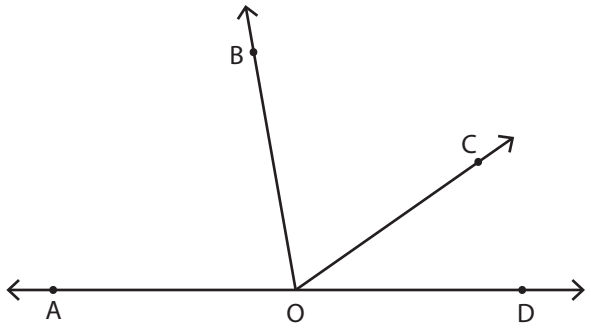

m∠AO
m∠BO
m∠BO

2)

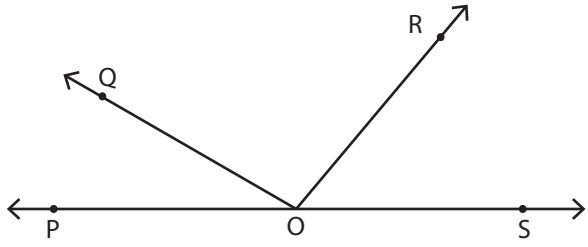

OS = 150^0
OR = 100^0
OS = 50^0

3)

m∠PO
m∠TO
m∠QO

OZ = 65^0
OW = 160^0
OZ = 45^0

PREVIEW

Access the largest collection of worksheets for just $19.95 per year!

Members, please log in to download this worksheet.

Log in

Not a member? Please sign up to gain complete access.

Sign up

www.mathworksheets4kids.com

5)

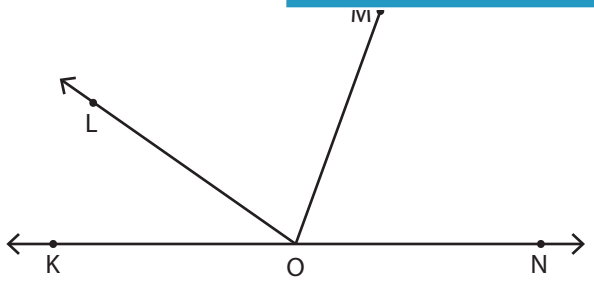

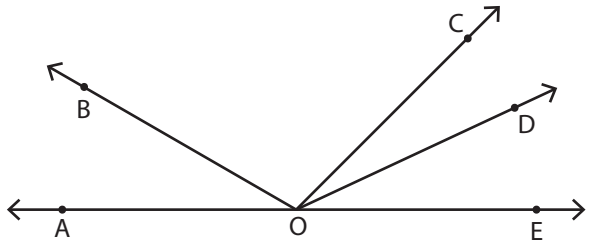

m∠LOM = 75^0
m∠MON = 70^0
m∠LOK = 35^0

m∠COD = 20^0
m∠AOD = 155^0
m∠COE = 45^0