Name : _____ Score : _____

Counting Squares

Level 2: S2

Calculate the area of each shape by counting the squares.

1) Scale : ☐ = 2 in²

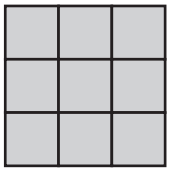

Area = _____

2) Scale : ☐ = 3 ft²



Area = _____

3) Scale : ☐ = 2 yd²



Area = _____

4) Scale : ☐ = 4



Area = _____

Scale : ☐ = 5 ft²



Area = _____

7) Scale : ☐ = 4



Area = _____

Scale : ☐ = 3 in²



Area = _____

10) Scale : ☐ = 5 yd²

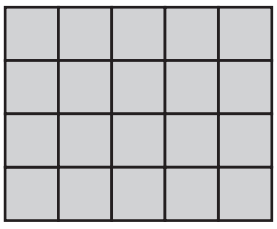

Area = _____

11) Scale : ☐ = 4 in²

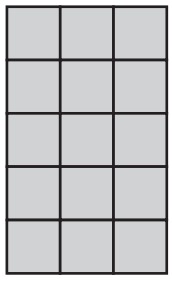

Area = _____

12) Scale : ☐ = 3 ft²

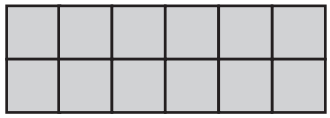

Area = _____

PREVIEW

Access the largest collection of worksheets for just $19.95 per year!

Members, please log in to download this worksheet.

Log in

Not a member? Please sign up to gain complete access.

Sign up

www.mathworksheets4kids.com

Name : _____ Score : _____

Answer key

Counting Squares

Level 2: S2

Calculate the area of each shape by counting the squares.

1) Scale : ☐ = 2 in²

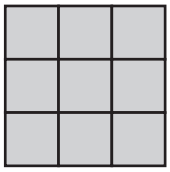

Area = 18 in²

2) Scale : ☐ = 3 ft²



Area = 60 ft²

3) Scale : ☐ = 2 yd²



Area = 30 yd²

4) Scale : ☐ = 4



Area = 48 yd²

Scale : ☐ = 5 ft²



Area = 120 ft²

7) Scale : ☐ = 4



Area = 40 ft²

Scale : ☐ = 3 in²



Area = 48 in²

10) Scale : ☐ = 5 yd²



Area = 100 yd²

11) Scale : ☐ = 4 in²

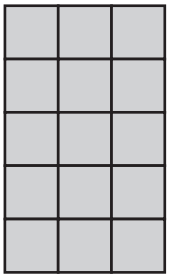

Area = 60 in²

12) Scale : ☐ = 3 ft²

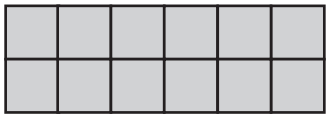

Area = 36 ft²

PREVIEW

Access the largest collection of worksheets for just $19.95 per year!

Members, please log in to download this worksheet.

Log in

Not a member? Please sign up to gain complete access.

Sign up

www.mathworksheets4kids.com