Name : _____ Score : _____

MS1

Marking Calendar

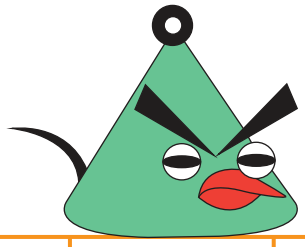

October 2001

Sunday	Monday	Tuesday	Wednesday	Thursday	Friday	Saturday
	1	2	3	4	5	6
7	8 Columbus Day	9	10	11	12	13
14	15	16	17	18	19	20
21	22 Diane's birthday	23	24	25	26	27
28	29	30	31			

1) Mary's birthday is 17 days before Diane's birthday. Cross mark Mary's birthday.

2) Check all the dates between the Columbus Day and Mary's birthday.

3) Halloween day falls two weeks and nine days after Columbus Day. Mark the Halloween day with a rectangle.

4) Bob has a flight to New York on October 15. Today is October 11. Circle all the dates until Bob's flight.

5) Mark the second and fourth Wednesday with triangles.

Name : _____ Score : _____

Answer Key

MS1

Marking Calendar

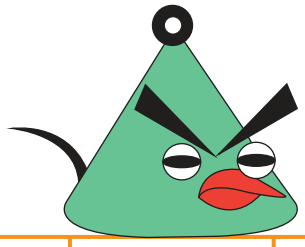

October 2001

Sunday	Monday	Tuesday	Wednesday	Thursday	Friday	Saturday
	1	2	3	4	~~5~~	~~6~~
~~7~~	8 Columbus Day	9	10	11	12	13
14	15	16	17	18	19	20
21	22 Diane's birthday	23	24	25	26	27
28	29	30	31			

1) Mary's birthday is 17 days before Diane's birthday. Cross mark Mary's birthday.

2) Check all the dates between the Columbus Day and Mary's birthday.

3) Halloween day falls two weeks and nine days after Columbus Day. Mark the Halloween day with a rectangle.

4) Bob has a flight to New York on October 15. Today is October 11. Circle all the dates until Bob's flight.

5) Mark the second and fourth Wednesday with triangles.

Name : _____ Score : _____

MS2

Marking Calendar

February 2013

Sunday	Monday	Tuesday	Wednesday	Thursday	Friday	Saturday
					1	2
3	4	5	6	7	8	9
10	11				15	16
17	18				22	23
24	25					

PREVIEW

Access the largest collection of worksheets for just $19.95 per year!

Members, please log in to download this worksheet.

Log in

Not a member? Please sign up to gain complete access.

Sign up

www.mathworksheets4kids.com

1) Fred is planning n after 24 days. If today is Februa x to mark the date.

2) If today is Febru s and four days with a triangle.

3) Today is February 3. Bella has an appointment to clean Mr. Smith's house on the 14th day. Check mark the date in her schedule.

4) Ray places an order to buy a pair of trousers on February 2. It takes exactly 11 days to reach him. Mark the delivery date with a circle.

5) Mark all the days which begin with the letter 'M'. Use rectangles to mark them.

Name : _____ Score : _____

Answer Key

MS2

Marking Calendar

February 2013

Sunday	Monday	Tuesday	Wednesday	Thursday	Friday	Saturday
					1	2
3	4	5	6	7	8	9
10	11				15	16
17	18				22	23
24	25					

PREVIEW

Access the largest collection of worksheets for just $19.95 per year!

Members, please log in to download this worksheet.

Log in

Not a member? Please sign up to gain complete access.

Sign up

www.mathworksheets4kids.com

1) Fred is planning ... n after 24 days. If today is Februa ... x to mark the date.

2) If today is Febru ... s and four days with a triangle.

3) Today is February 3. Bella has an appointment to clean Mr. Smith's house on the 14th day. Check mark the date in her schedule.

4) Ray places an order to buy a pair of trousers on February 2. It takes exactly 11 days to reach him. Mark the delivery date with a circle.

5) Mark all the days which begin with the letter 'M'. Use rectangles to mark them.

Name : _____ Score : _____

MS3

Marking Calendar



May 2004

Sunday	Monday	Tuesday	Wednesday	Thursday	Friday	Saturday
						1
2	3	4	5	6	7	8
9 Mother's Day	10				14	15
16	17				21	22
23	24				28	29
30	31					

PREVIEW

Access the largest collection of worksheets for just $19.95 per year!

Members, please log in to download this worksheet.

Log in

Not a member? Please sign up to gain complete access.

Sign up

www.mathworksheets4kids.com

1) Ryan's soccer pr ... after Mother's Day. Check mark the ...

2) Cross the first Fr ... y calendar.

3) Mark all the Tuesdays which fall between May 15th and May 30th. Use rectangles to mark the dates.

4) Circle the Sundays that have even dates.

5) What is the date of the 3rd Saturday and 3rd Sunday in this month? Check mark the dates.

Name : _____ Score : _____

Answer Key

MS3

Marking Calendar



May 2004

Sunday	Monday	Tuesday	Wednesday	Thursday	Friday	Saturday
						1
2	3	4	5	6	~~7~~	8
9 Mother's Day	10				14	~~15~~
~~16~~	17				21	22
23	24				28	29
30	31					

PREVIEW

Access the largest collection of worksheets for just $19.95 per year!

Members, please log in to download this worksheet.

Log in

Not a member? Please sign up to gain complete access.

Sign up

www.mathworksheets4kids.com

1) Ryan's soccer pr ... after Mother's Day. Check mark the ...

2) Cross the first Fr ... y calendar.

3) Mark all the Tuesdays which fall between May 15th and May 30th. Use rectangles to mark the dates.

4) Circle the Sundays that have even dates.

5) What is the date of the 3rd Saturday and 3rd Sunday in this month? Check mark the dates.