Name : _____ Score : _____

Counting Quarters and Half-Dollars

Sheet 1

1 half-dollar = **50 ¢** or **$ 0.50**
1 quarter = **25 ¢** or **$ 0.25**

Count the coins and write the total amount.

1)		$ _____
2)		$ _____
3)		$ _____
4)		$ _____
5)	7 half-dollars = $ ___	quarters = $ _____

PREVIEW

Access the largest collection of worksheets for just **$19.95** per year!

Members, please log in to download this worksheet.
Log in

Not a member? Please sign up to gain complete access.
Sign up

www.mathworksheets4kids.com

7) How many half-dollars do you need to buy a stapler?

_____ half-dollars

8) Adam bought a wooden pushpin with 9 quarters. How much money did he pay?

$ _____

Name : _____ Score : _____

Answer key

Counting Quarters and Half-Dollars

Sheet 1

1 half-dollar = **50 ¢** or **$ 0.50**
1 quarter = **25 ¢** or **$ 0.25**

Count the coins and write the total amount.

1)		$ 2.50
2)		$ 1.50
3)		$ 1.50
4)		$ 1.75

5) 7 half-dollars = $ [illegible] quarters = $ 2.50

PREVIEW

Access the largest collection of worksheets for just **$19.95** per year!

Members, please log in to download this worksheet.
Log in

Not a member? Please sign up to gain complete access.
Sign up

www.mathworksheets4kids.com

7) How many half-dollars do you need to buy a stapler?

8 half-dollars

8) Adam bought a wooden pushpin with 9 quarters. How much money did he pay?

$ 2.25

Name : _____ Score : _____

Counting Quarters and Half-Dollars

Sheet 2

1 half-dollar = **50 ¢** or **$ 0.50**
1 quarter = **25 ¢** or **$ 0.25**

Count the coins and write the total amount.

1)		$ _____
2)		$ _____
3)		$ _____
4)		$ _____
5)	6 quarters = $ _____	lf-dollars = $ _____

PREVIEW

Access the largest collection of worksheets for just **$19.95** per year!

Members, please log in to download this worksheet.
Log in

Not a member? Please sign up to gain complete access.
Sign up

www.mathworksheets4kids.com

7) How many quarters do you need to buy a notebook?

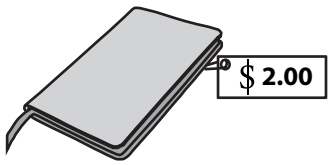

_____ quarters

8) Ronald bought an eraser with 3 half-dollars. How much money did he pay?

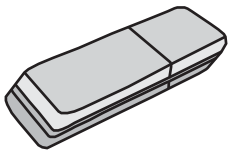

$ _____

Name : _____ Score : _____

Answer key

Counting Quarters and Half-Dollars

Sheet 2

1 half-dollar = **50 ¢** or **$ 0.50**
1 quarter = **25 ¢** or **$ 0.25**

Count the coins and write the total amount.

1)

$ 1.00

2)

$ 3.00

3)

$ 2.00

4)

$ 0.50

5) 6 quarters = $ 1.5 ... lf-dollars = $ 4.00

PREVIEW

Access the largest collection of worksheets for just **$19.95** per year!

Members, please log in to download this worksheet.
Log in

Not a member? Please sign up to gain complete access.
Sign up

www.mathworksheets4kids.com

7) How many quarters do you need to buy a notebook?

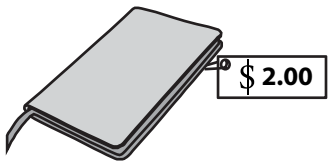

8 quarters

8) Ronald bought an eraser with 3 half-dollars. How much money did he pay?

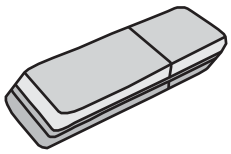

$ 1.50

Name : _____ Score : _____

Counting Quarters and Half-Dollars

Sheet 3

1 half-dollar = **50 ¢** or **$ 0.50**
1 quarter = **25 ¢** or **$ 0.25**

Count the coins and write the total amount.

1)		$ _____
2)		$ _____
3)		$ _____
4)		$ _____
5)	5 half-dollars = $ ____	uarters = $ _____

PREVIEW

Access the largest collection of worksheets for just **$19.95** per year!

Members, please log in to download this worksheet.
Log in

Not a member? Please sign up to gain complete access.
Sign up

www.mathworksheets4kids.com

7) How many quarters do you need to buy a handbag?

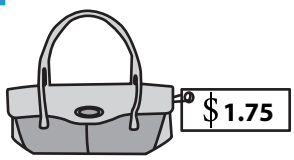

_____ quarters

8) Emma bought a dress with 6 half-dollars. How much money did she pay?



$ _____

Name : _____ Score : _____

Answer key

Counting Quarters and Half-Dollars

Sheet 3

1 half-dollar = **50 ¢** or **$ 0.50**
1 quarter = **25 ¢** or **$ 0.25**

Count the coins and write the total amount.

1)

$ 1.50

2)

$ 1.50

3)

$ 1.25

4)

$ 1.00

5) 5 half-dollars = $ 2. ... uarters = $ 2.50

PREVIEW

Access the largest collection of worksheets for just **$19.95** per year!

Members, please log in to download this worksheet.
Log in

Not a member? Please sign up to gain complete access.
Sign up

www.mathworksheets4kids.com

7) How many quarters do you need to buy a handbag?

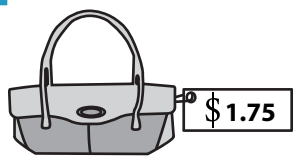

7 quarters

8) Emma bought a dress with 6 half-dollars. How much money did she pay?



$ 3.00