Name : _____ Score : _____

MCQ

Sheet 1

1) Which of the following equation represents the line on the graph?

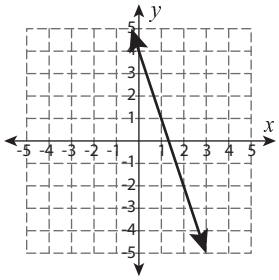

a) $y = x + 4$ b) $y = 2x - 4$ c) $y = -3x + 4$

2) Which of the following equation represents the line on the graph?

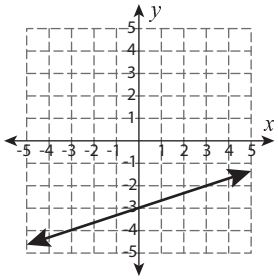

a) $y = -2x + 3$ b) $y = \frac{1}{2}x - 3$ c) $y = \frac{1}{2}x + 3$

3) Which of the foll aph?

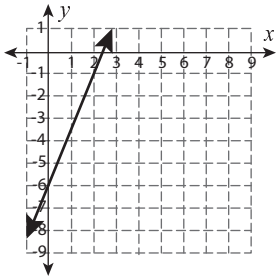

a) $y = 3x - 6$

4) Which of the foll aph?

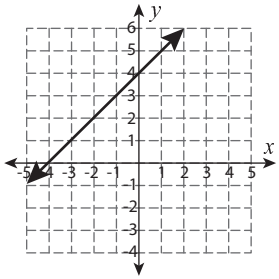

a) $y = x + 4$

5) Which of the foll aph?

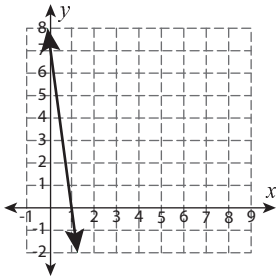

a) $y = -7x + 7$ b) $y = 8x - 7$ c) $y = 4x + 7$

6) Which of the following equation represents the line on the graph?

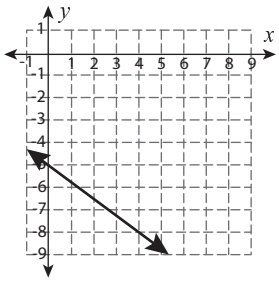

a) $y = 6x + 5$ b) $y = \frac{5}{4}x + 5$ c) $y = -\frac{3}{4}x - 5$

PREVIEW

Access the largest collection of worksheets for just $19.95 per year!

Members, please log in to download this worksheet.

Log in

Not a member? Please sign up to gain complete access.

Sign up

www.mathworksheets4kids.com

Name : _____ **Answer key** Score : _____

MCQ

Sheet 1

1) Which of the following equation represents the line on the graph?

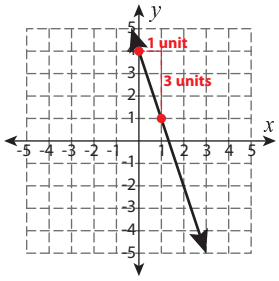

a) $y = x + 4$ b) $y = 2x - 4$ c) $y = -3x + 4$

2) Which of the following equation represents the line on the graph?

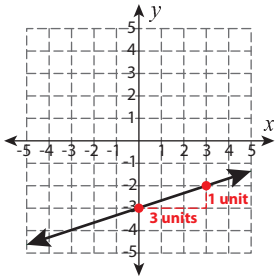

a) $y = -2x + 3$ b) $y = \frac{1}{2}x - 3$ c) $y = \frac{1}{2}x + 3$

PREVIEW

Access the largest collection of worksheets for just $19.95 per year!

Members, please log in to download this worksheet.

Log in

Not a member? Please sign up to gain complete access.

Sign up

www.mathworksheets4kids.com

3) Which of the foll aph?

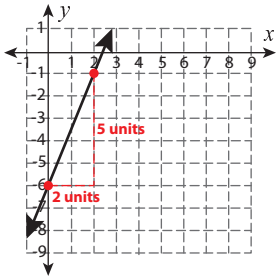

a) $y = 3x - 6$

4) Which of the foll aph?

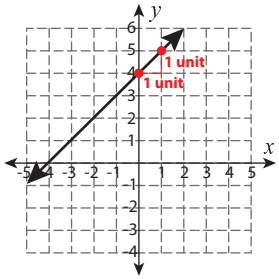

a) $y = x + 4$

5) Which of the foll aph?

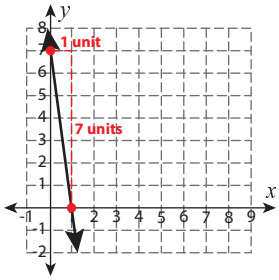

a) $y = -7x + 7$ b) $y = 8x - 7$ c) $y = 4x + 7$

6) Which of the following equation represents the line on the graph?

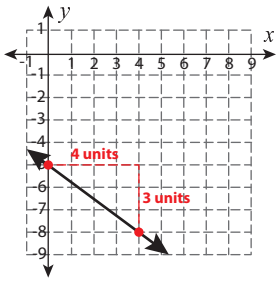

a) $y = 6x + 5$ b) $y = \frac{5}{4}x + 5$ c) $y = -\frac{3}{4}x - 5$

Name : _____ Score : _____

MCQ

Sheet 2

1) Which of the following equation represents the line on the graph?

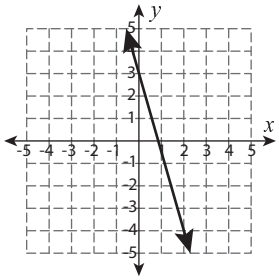

a) $y = 7x - 3$ b) $y = -\frac{7}{2}x + 3$ c) $y = -\frac{3}{5}x - 3$

2) Which of the following equation represents the line on the graph?

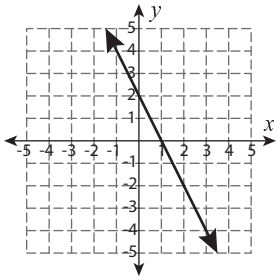

a) $y = -2x + 2$ b) $y = -3x + 2$ c) $y = 5x + 2$

3) Which of the foll aph?

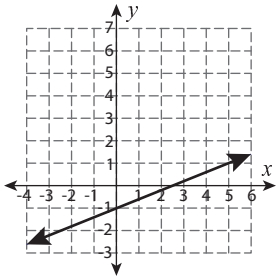

a) $y = \frac{5}{2}x - 1$

4) Which of the foll aph?

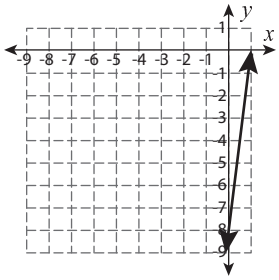

a) $y = 8x + 8$

5) Which of the foll aph?

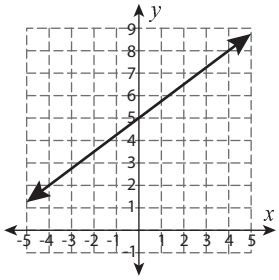

a) $y = 5x - 5$ b) $y = \frac{6}{5}x + 5$ c) $y = \frac{5}{4}x + 5$

6) Which of the following equation represents the line on the graph?

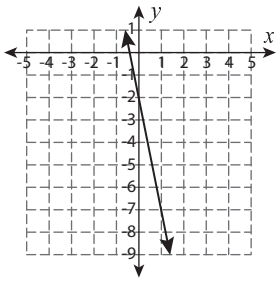

a) $y = -5x - 2$ b) $y = 6x + 2$ c) $y = 5x + 2$

PREVIEW

Access the largest collection of worksheets for just $19.95 per year!

Members, please log in to download this worksheet.

Log in

Not a member? Please sign up to gain complete access.

Sign up

www.mathworksheets4kids.com

Name : _____ **Answer key** Score : _____

MCQ

Sheet 2

1) Which of the following equation represents the line on the graph?

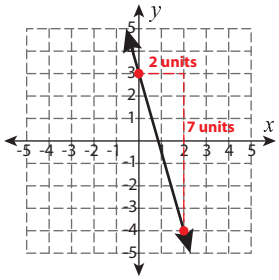

a) $y = 7x - 3$ b) $y = -\frac{7}{2}x + 3$ c) $y = -\frac{3}{5}x - 3$

2) Which of the following equation represents the line on the graph?

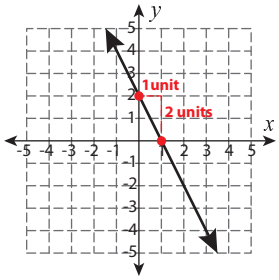

a) $y = -2x + 2$ b) $y = -3x + 2$ c) $y = 5x + 2$

3) Which of the foll aph?

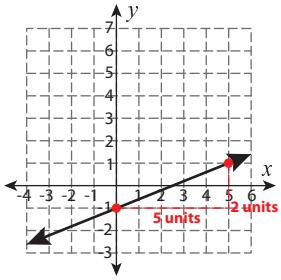

a) $y = \frac{5}{2}x - 1$

4) Which of the foll aph?

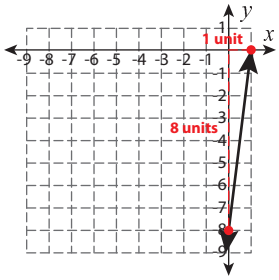

a) $y = 8x + 8$

5) Which of the foll aph?

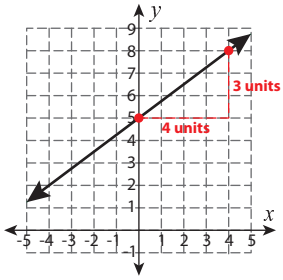

a) $y = 5x - 5$ b) $y = \frac{5}{5}x + 5$ c) $y = \frac{3}{4}x + 5$

6) Which of the following equation represents the line on the graph?

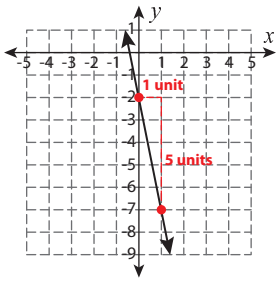

a) $y = -5x - 2$ b) $y = 6x + 2$ c) $y = 5x + 2$

PREVIEW

Access the largest collection of worksheets for just $19.95 per year!

Members, please log in to download this worksheet.

Log in

Not a member? Please sign up to gain complete access.

Sign up

www.mathworksheets4kids.com

Name : _____ Score : _____

MCQ

Sheet 3

1) Which of the following equation represents the line on the graph?

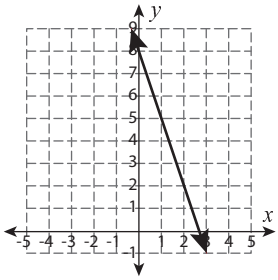

a) $y = -3x + 8$ b) $y = 7x + 8$ c) $y = 8x - 8$

2) Which of the following equation represents the line on the graph?

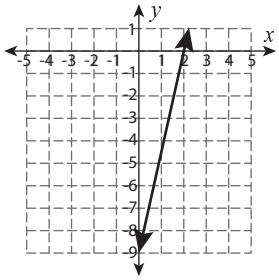

a) $y = -3x + 9$ b) $y = -\frac{7}{2}x + 9$ c) $y = \frac{9}{2}x - 9$

3) Which of the foll aph?

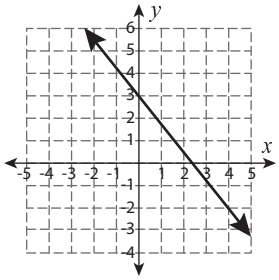

a) $y = -\frac{5}{4}x + 3$

4) Which of the foll aph?

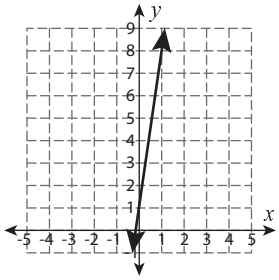

a) $y = -9x + 1$

5) Which of the foll aph?

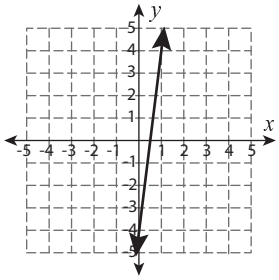

a) $y = 5x - 4$ b) $y = 8x - 4$ c) $y = 5x + 4$

6) Which of the following equation represents the line on the graph?

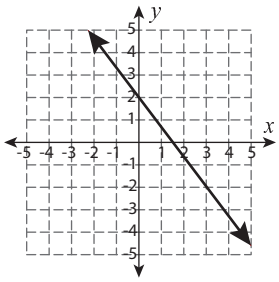

a) $y = 3x + 2$ b) $y = -\frac{4}{3}x + 2$ c) $y = \frac{6}{5}x - 2$

PREVIEW

Access the largest collection of worksheets for just $19.95 per year!

Members, please log in to download this worksheet.

Log in

Not a member? Please sign up to gain complete access.

Sign up

www.mathworksheets4kids.com

Name : _____ **Answer key** Score : _____

MCQ

Sheet 3

1) Which of the following equation represents the line on the graph?

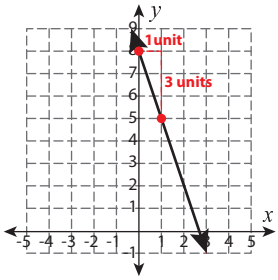

a) $y = -3x + 8$ b) $y = 7x + 8$ c) $y = 8x - 8$

2) Which of the following equation represents the line on the graph?

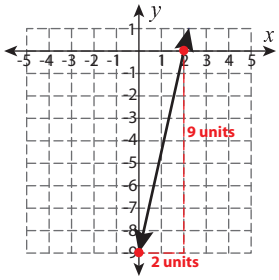

a) $y = -3x + 9$ b) $y = -\frac{7}{2}x + 9$ c) $y = \frac{9}{2}x - 9$

3) Which of the foll aph?

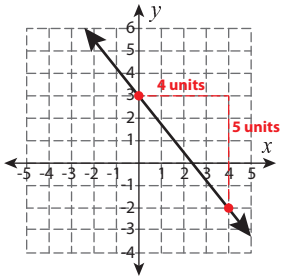

a) $y = -\frac{5}{4}x + 3$

4) Which of the foll aph?

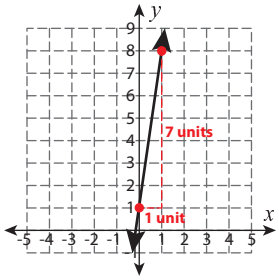

a) $y = -9x + 1$

5) Which of the foll aph?

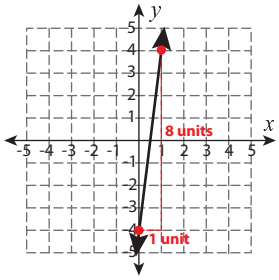

a) $y = 5x - 4$ b) $y = 8x - 4$ c) $y = 5x + 4$

6) Which of the following equation represents the line on the graph?

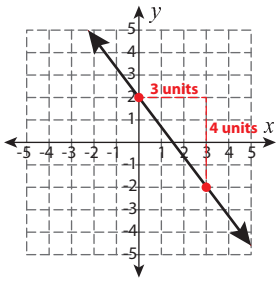

a) $y = 3x + 2$ b) $y = -\frac{4}{3}x + 2$ c) $y = \frac{6}{5}x - 2$

PREVIEW

Access the largest collection of worksheets for just $19.95 per year!

Members, please log in to download this worksheet.

Log in

Not a member? Please sign up to gain complete access.

Sign up

www.mathworksheets4kids.com