Name : _____

Counting Money

Sheet 3

1) 

Mia takes all the change from her wallet. Count the coins and bills and determine how much money she has altogether.

_____

2) 

ck of fries for lunch.
e how much money

_____

3)

ne and a cup of coffee.
e out the total money

_____

4) 

nience store. Count the
much he can spend.

_____

5) 

Zia wants to buy a pair of socks and a keychain. Count the bills and coins in her purse and determine how much she has.

_____

PREVIEW

Gain complete access to the largest collection of worksheets in all subjects!

Members, please log in to download this worksheet.

Not a member? Please sign up to gain complete access.

www.mathworksheets4kids.com