Name : _____

Number Line Addition

Hops: S1

Indicate hops on each number line and complete the addition sentences.

1) 8.36 + 0.6 = _____



2) 4.245 + 0.98 =

3) 17.74 +

4) 6.8 +

5) 2.524 +



6) 9.5 + 0.2 = _____

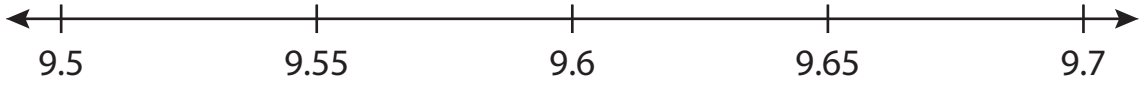

PREVIEW

Access the largest collection of worksheets for just $19.95 per year!

Members, please log in to download this worksheet.

Log in

Not a member? Please sign up to gain complete access.

Sign up

www.mathworksheets4kids.com

Name : _____

Answer key

Number Line Addition

Hops: S1

Indicate hops on each number line and complete the addition sentences.

1) 8.36 + 0.6 = **8.96**

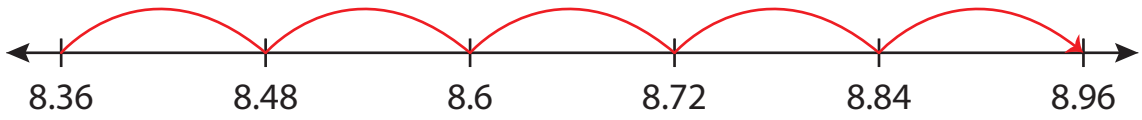

2) 4.245 + 0.98 = **5.225**

3) 17.74 +

4) 6.8 +

5) 2.524 +



6) 9.5 + 0.2 = **9.7**

PREVIEW

Access the largest collection of worksheets for just $19.95 per year!

Members, please log in to download this worksheet.

Log in

Not a member? Please sign up to gain complete access.

Sign up

www.mathworksheets4kids.com

Name : _____

Number Line Addition

Hops: S2

Indicate hops on each number line and complete the addition sentences.

1) 3.6 + 0.8 = _____

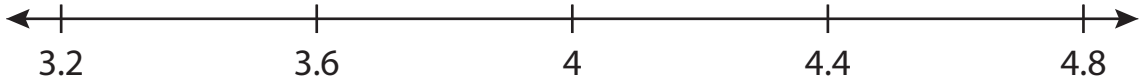

2) 6.345 + 0.46 =

3) 3.5 +

4) 7.991 +

5) 9.724 +

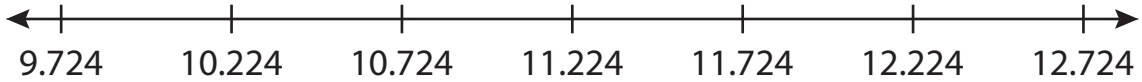

6) 12.78 + 3 = _____



PREVIEW

Access the largest collection of worksheets for just $19.95 per year!

Members, please log in to download this worksheet.

Log in

Not a member? Please sign up to gain complete access.

Sign up

www.mathworksheets4kids.com

Name : _____

Answer key

Number Line Addition

Hops: S2

Indicate hops on each number line and complete the addition sentences.

1) 3.6 + 0.8 = **4.4**

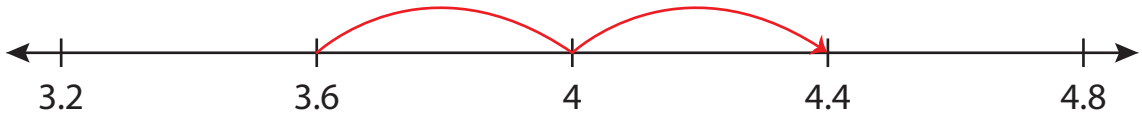

2) 6.345 + 0.46 = **6.805**

3) 3.5 +

4) 7.991 +

5) 9.724 +

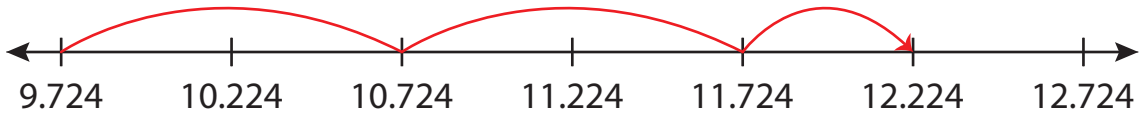

6) 12.78 + 3 = **15.78**



PREVIEW

Access the largest collection of worksheets for just **$19.95** per year!

Members, please log in to download this worksheet.

Log in

Not a member? Please sign up to gain complete access.

Sign up

www.mathworksheets4kids.com

Name : _____

Number Line Addition

Hops: S3

Indicate hops on each number line and complete the addition sentences.

1) 7 + 0.625 = _____

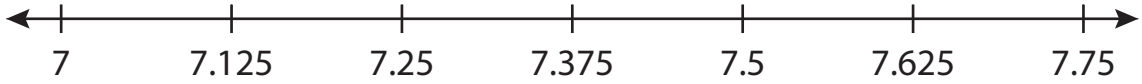

2) 5.017 + 3 =

3) 9.76 +

4) 1.15 +

5) 14.2 +

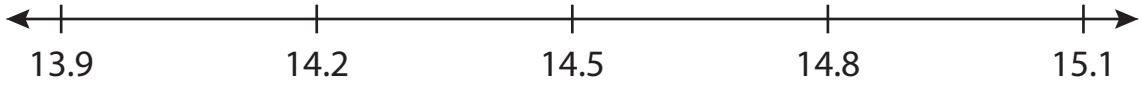

6) 7.755 + 0.86 = _____

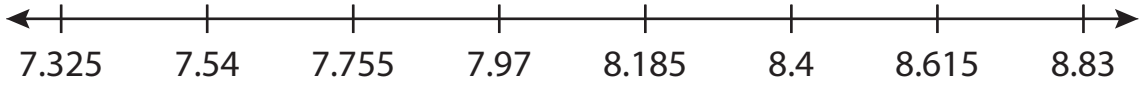

PREVIEW

Access the largest collection of worksheets for just $19.95 per year!

Members, please log in to download this worksheet.

Log in

Not a member? Please sign up to gain complete access.

Sign up

www.mathworksheets4kids.com

Name : _____

Answer key

Number Line Addition

Hops: S3

Indicate hops on each number line and complete the addition sentences.

1) 7 + 0.625 = **7.625**

2) 5.017 + 3 = **8.017**

3) 9.76 +

4) 1.15 +

5) 14.2 +

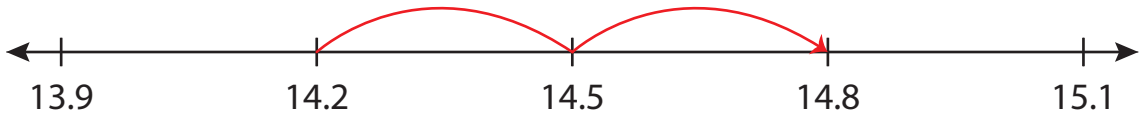

6) 7.755 + 0.86 = **8.615**

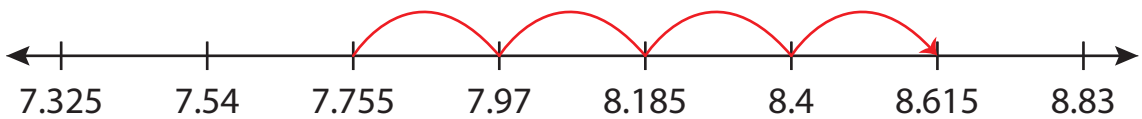

PREVIEW

Access the largest collection of worksheets for just **$19.95** per year!

Members, please log in to download this worksheet.

Log in

Not a member? Please sign up to gain complete access.

Sign up

www.mathworksheets4kids.com

Name : _____

Number Line Addition

Hops: S4

Indicate hops on each number line and complete the addition sentences.

1) 2.011 + 6 = _____

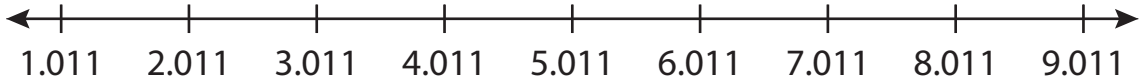

2) 10 + 1.25 =

3) 5.13 +

4) 12.315 +

5) 8.7 +



6) 3.8 + 2.5 = _____



PREVIEW

Access the largest collection of worksheets for just $19.95 per year!

Members, please log in to download this worksheet.
Log in

Not a member? Please sign up to gain complete access.
Sign up

www.mathworksheets4kids.com

Name : _____

Answer key

Number Line Addition

Hops: S4

Indicate hops on each number line and complete the addition sentences.

1) 2.011 + 6 = **8.011**

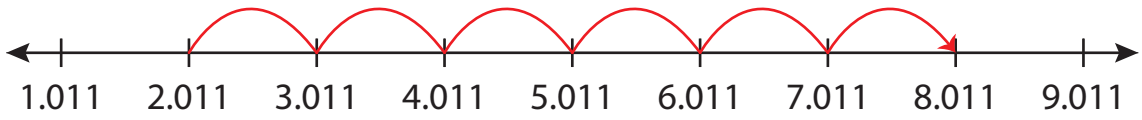

2) 10 + 1.25 = **11.25**

3) 5.13 +

4) 12.315 +

5) 8.7 +

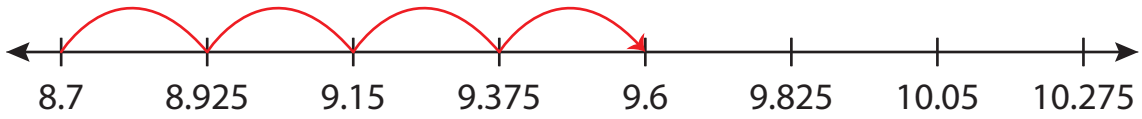

6) 3.8 + 2.5 = **6.3**



PREVIEW

Access the largest collection of worksheets for just **$19.95** per year!

Members, please log in to download this worksheet.

Log in

Not a member? Please sign up to gain complete access.

Sign up

www.mathworksheets4kids.com

Name : _____

Number Line Addition

Hops: S5

Indicate hops on each number line and complete the addition sentences.

1) 17.14 + 0.48 = _____



2) 15.05 + 2.5 =

3) 8.6 +

4) 2 +

5) 4.197 +

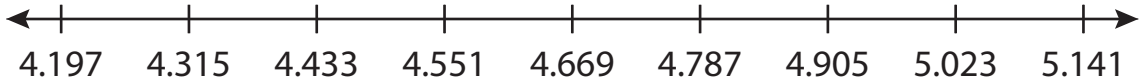

6) 8.5 + 1 = _____

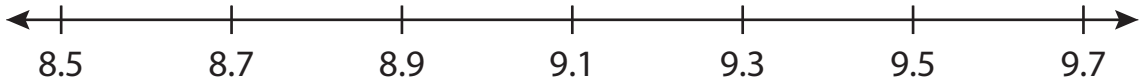

PREVIEW

Access the largest collection of worksheets for just $19.95 per year!

Members, please log in to download this worksheet.

Log in

Not a member? Please sign up to gain complete access.

Sign up

www.mathworksheets4kids.com

Name : _____

Answer key

Number Line Addition

Hops: S5

Indicate hops on each number line and complete the addition sentences.

1) 17.14 + 0.48 = **17.62**



2) 15.05 + 2.5 = **17.55**

3) 8.6 +

4) 2 +

5) 4.197 +

6) 8.5 + 1 = **9.5**

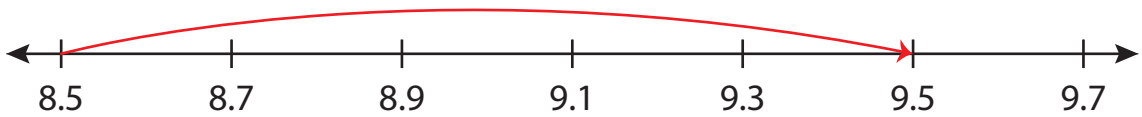

PREVIEW

Access the largest collection of worksheets for just **$19.95** per year!

Members, please log in to download this worksheet.

Log in

Not a member? Please sign up to gain complete access.

Sign up

www.mathworksheets4kids.com