Name : _____

Number Line Addition

3addends-tenth: S1

Indicate hops on each number line and complete the addition sentences.

1) 3.7 + 2 + 1.5 = _____



2) 8.2 + 0.4 + 0.2 = _____



3) 17.5 + 1 + 0.5 = _____

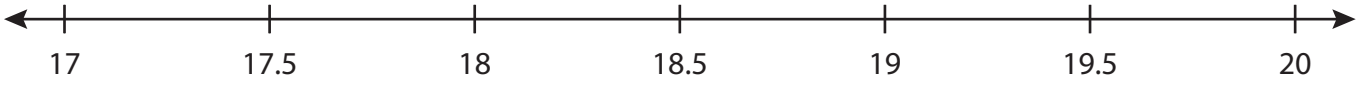

4) 6.9 + 3 + 1 = _____

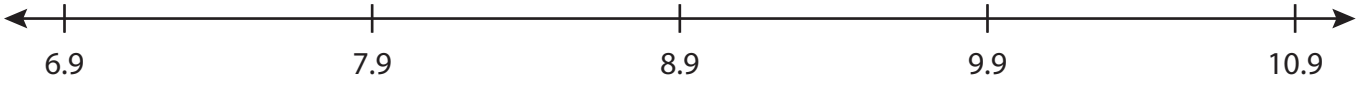

5) 5 + 0.1 + 0.4 = _____

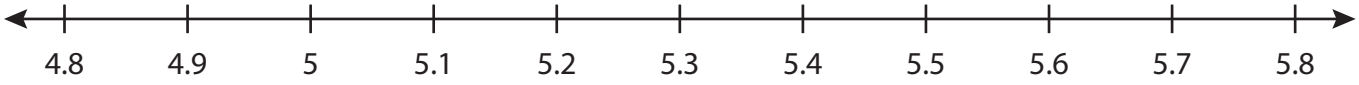

6) 9.4 + 0.2 + 1 = _____

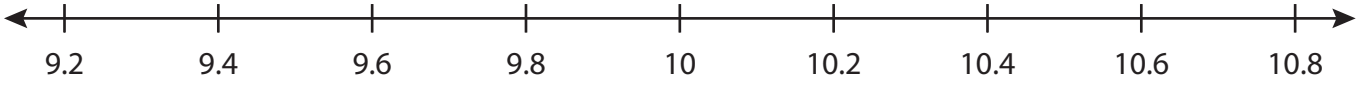

Name : _____

Answer key

Number Line Addition

3addends-tenth: S1

Indicate hops on each number line and complete the addition sentences.

1) 3.7 + 2 + 1.5 = **7.2**

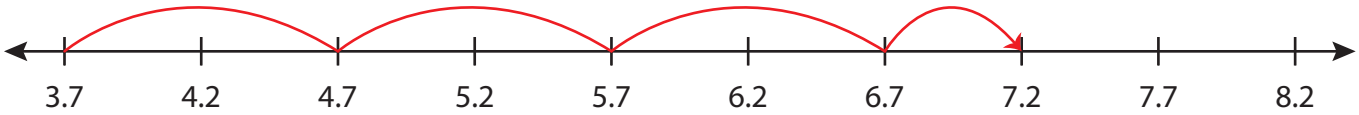

2) 8.2 + 0.4 + 0.2 = **8.8**

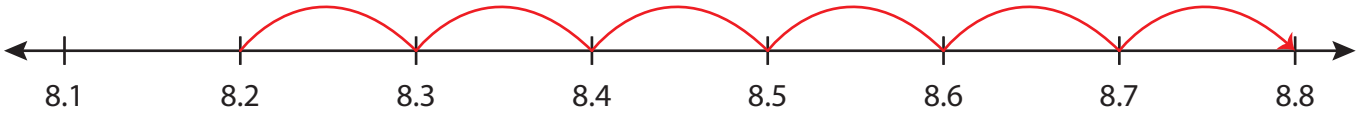

3) 17.5 + 1 + 0.5 = **19**

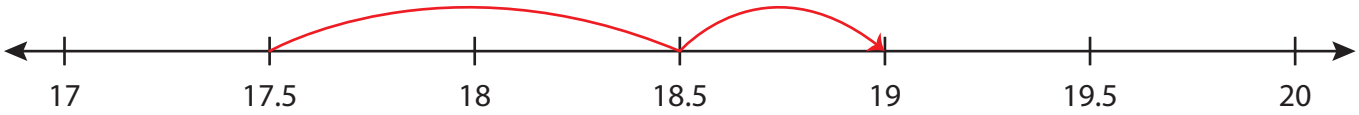

4) 6.9 + 3 + 1 = **10.9**

5) 5 + 0.1 + 0.4 = **5.5**

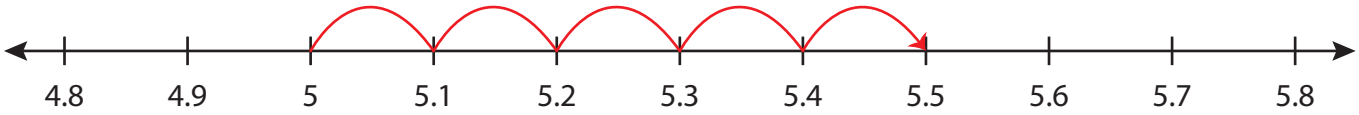

6) 9.4 + 0.2 + 1 = **10.6**

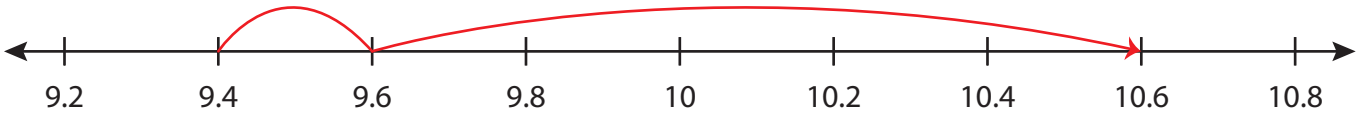

Name : _____

Number Line Addition

3addends-tenth: S2

Indicate hops on each number line and complete the addition sentences.

1) 2.2 + 0.2 + 0.5 = _____



2) 7.8 + 1 + 0.5 = _____

3) 1.8 + 2 + 4 =

4) 13 + 0.3 + 0.6 =

5) 6.6 + 1 + 0.4 =



6) 4.1 + 2.5 + 1 = _____

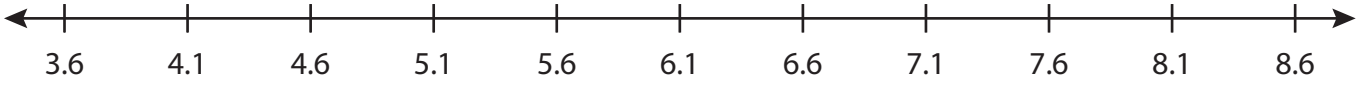

PREVIEW

Access the largest collection of worksheets for just $19.95 per year!

Members, please log in to download this worksheet.

Log in

Not a member? Please sign up to gain complete access.

Sign up

www.mathworksheets4kids.com

Name : _____

Answer key

Number Line Addition

3addends-tenth: S2

Indicate hops on each number line and complete the addition sentences.

1) 2.2 + 0.2 + 0.5 = **2.9**

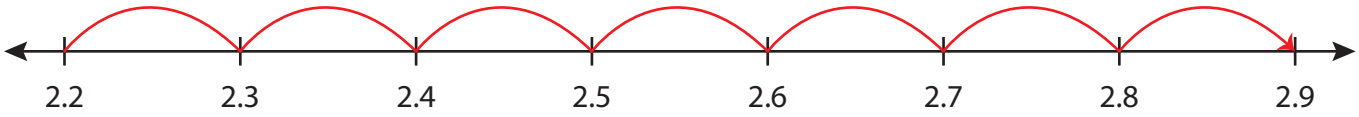

2) 7.8 + 1 + 0.5 = **9.3**

3) 1.8 + 2 + 4 =

4) 13 + 0.3 + 0.6 =

5) 6.6 + 1 + 0.4 =

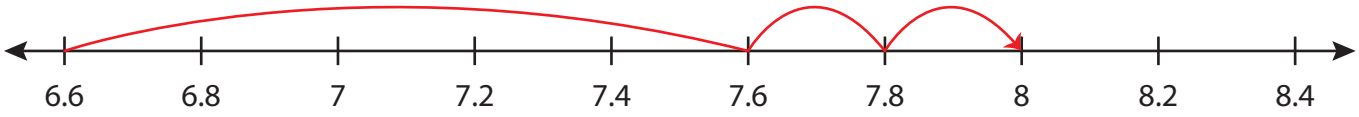

6) 4.1 + 2.5 + 1 = **7.6**

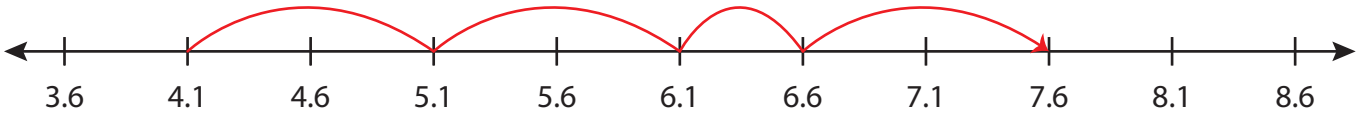

PREVIEW

Access the largest collection of worksheets for just $19.95 per year!

Members, please log in to download this worksheet.

Log in

Not a member? Please sign up to gain complete access.

Sign up

www.mathworksheets4kids.com

Name : _____

Number Line Addition

3addends-tenth: S3

Indicate hops on each number line and complete the addition sentences.

1) 6 + 0.1 + 0.3 = _____

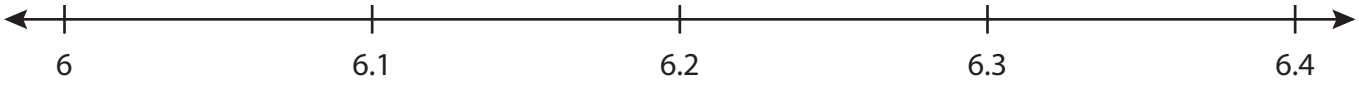

2) 9.5 + 3 + 2 = _____

3) 3.2 + 2.5 + 1 =

4) 14.3 + 0.2 + 0.1 =

5) 8.6 + 2 + 0.5 =



6) 2 + 1 + 0.6 = _____

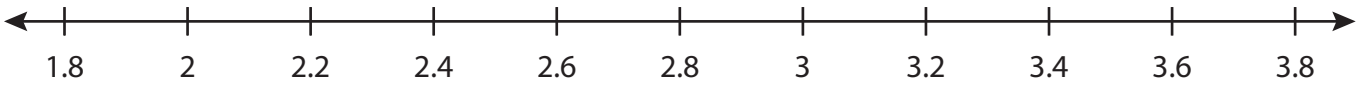

PREVIEW

Access the largest collection of worksheets for just $19.95 per year!

Members, please log in to download this worksheet.

Log in

Not a member? Please sign up to gain complete access.

Sign up

www.mathworksheets4kids.com

Name : _____

Answer key

Number Line Addition

3addends-tenth: S3

Indicate hops on each number line and complete the addition sentences.

1) 6 + 0.1 + 0.3 = **6.4**

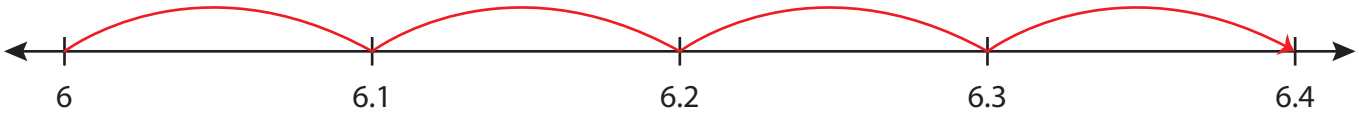

2) 9.5 + 3 + 2 = **14.5**

3) 3.2 + 2.5 + 1 =

4) 14.3 + 0.2 + 0.1 =

5) 8.6 + 2 + 0.5 =

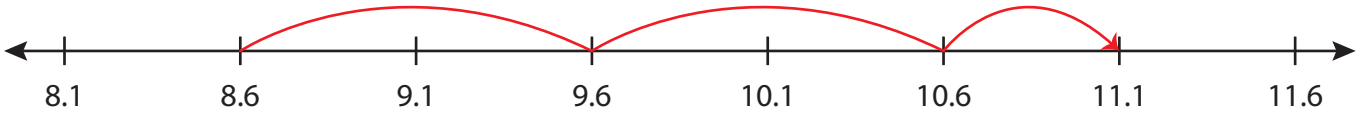

6) 2 + 1 + 0.6 = **3.6**

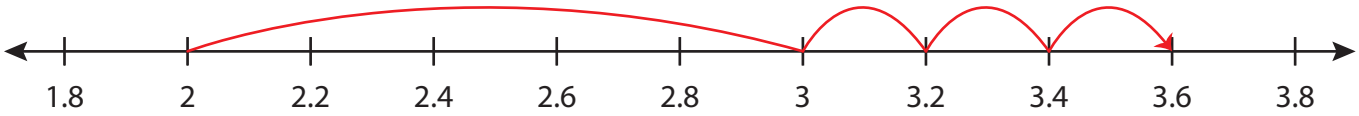

PREVIEW

Access the largest collection of worksheets for just $19.95 per year!

Members, please log in to download this worksheet.

Log in

Not a member? Please sign up to gain complete access.

Sign up

www.mathworksheets4kids.com

Name : _____

Number Line Addition

3addends-tenth: S4

Indicate hops on each number line and complete the addition sentences.

1) 12 + 2.5 + 2 = _____

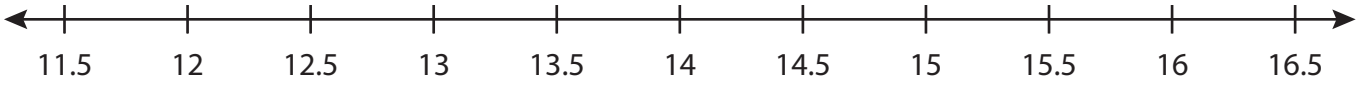

2) 1 + 0.3 + 0.9 = _____

3) 9.4 + 0.2 + 1 =

4) 4.5 + 3 + 0.5 =

5) 17.6 + 1 + 3 =

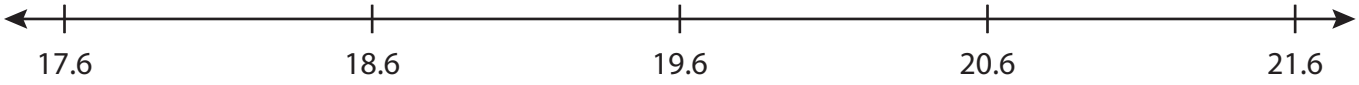

6) 8 + 0.1 + 0.3 = _____

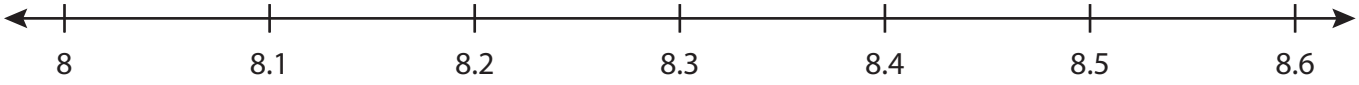

PREVIEW

Access the largest collection of worksheets for just $19.95 per year!

Members, please log in to download this worksheet.

Log in

Not a member? Please sign up to gain complete access.

Sign up

www.mathworksheets4kids.com

Name : _____

Answer key

Number Line Addition

3addends-tenth: S4

Indicate hops on each number line and complete the addition sentences.

1) 12 + 2.5 + 2 = **16.5**

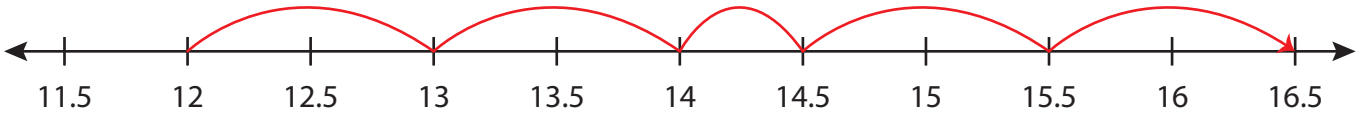

2) 1 + 0.3 + 0.9 = **2.2**

3) 9.4 + 0.2 + 1 =

4) 4.5 + 3 + 0.5 =

5) 17.6 + 1 + 3 =

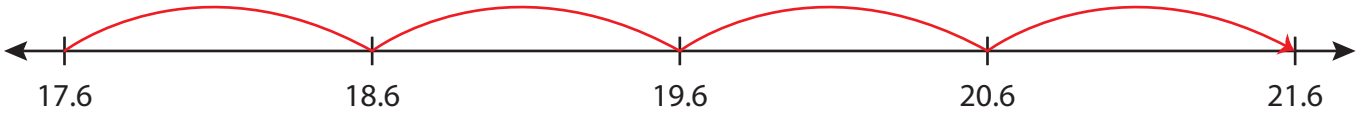

6) 8 + 0.1 + 0.3 = **8.4**

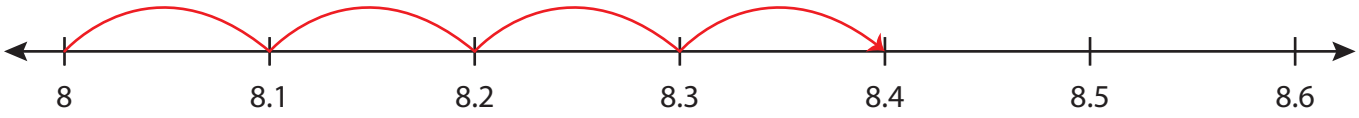

PREVIEW

Access the largest collection of worksheets for just $19.95 per year!

Members, please log in to download this worksheet.

Log in

Not a member? Please sign up to gain complete access.

Sign up

www.mathworksheets4kids.com

Name : _____

Number Line Addition

3addends-tenth: S5

Indicate hops on each number line and complete the addition sentences.

1) 7.9 + 0.4 + 0.4 = _____



2) 11 + 0.2 + 1 = _____

3) 15.1 + 1 + 0.1 =

4) 2.9 + 1.5 + 2 =

5) 10 + 1 + 0.6 =



6) 6.5 + 2 + 3 = _____

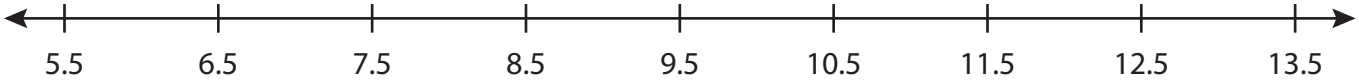

PREVIEW

Access the largest collection of worksheets for just $19.95 per year!

Members, please log in to download this worksheet.

Log in

Not a member? Please sign up to gain complete access.

Sign up

www.mathworksheets4kids.com

Name : _____

Answer key

Number Line Addition

3addends-tenth: S5

Indicate hops on each number line and complete the addition sentences.

1) 7.9 + 0.4 + 0.4 = **8.7**



2) 11 + 0.2 + 1 = **12.2**

3) 15.1 + 1 + 0.1 =

4) 2.9 + 1.5 + 2 =

5) 10 + 1 + 0.6 =

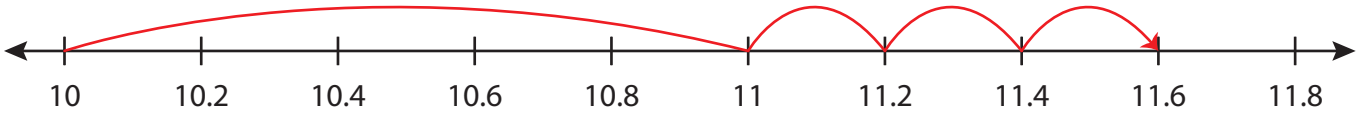

6) 6.5 + 2 + 3 = **11.5**

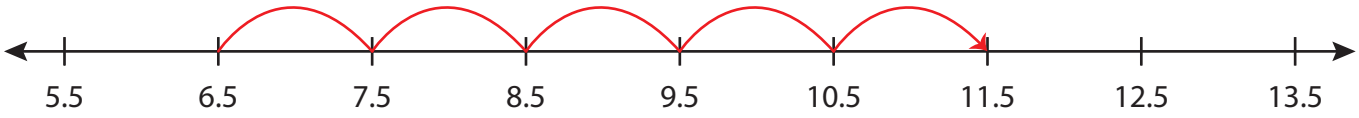

PREVIEW

Access the largest collection of worksheets for just $19.95 per year!

Members, please log in to download this worksheet.

Log in

Not a member? Please sign up to gain complete access.

Sign up

www.mathworksheets4kids.com