Name : _____

Number Line Subtraction

Tenth: S1

Read each number line and solve the problem.

1)

2.4 – 0.9 = _____

2)

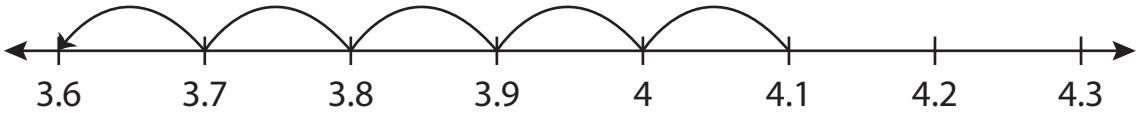

4.1 – 0.5 = _____

3)

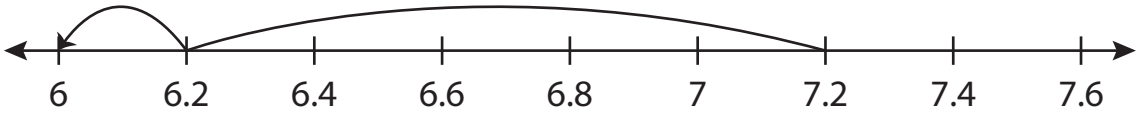

7.2 – 1.2 = _____

4)

8.6 – 4 = _____

5)

2.5 – 1.5 = _____

6)

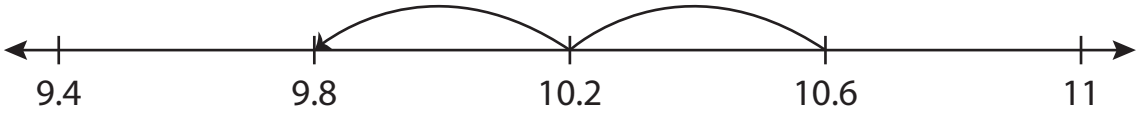

10.6 – 0.8 = _____

Name : _____

Answer key

Number Line Subtraction

Tenth: S1

Read each number line and solve the problem.

1)

2.4 – 0.9 = **1.5**

2)

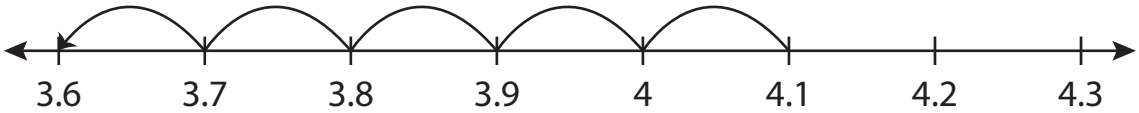

4.1 – 0.5 = **3.6**

3)

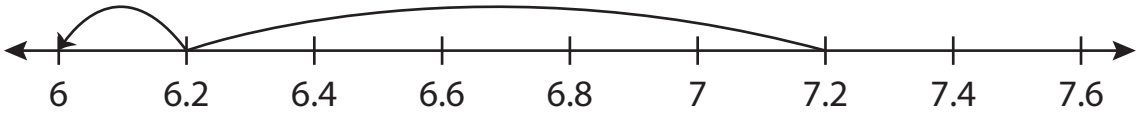

7.2 – 1.2 = **6**

4)

8.6 – 4 = **4.6**

5)

2.5 – 1.5 = **1**

6)

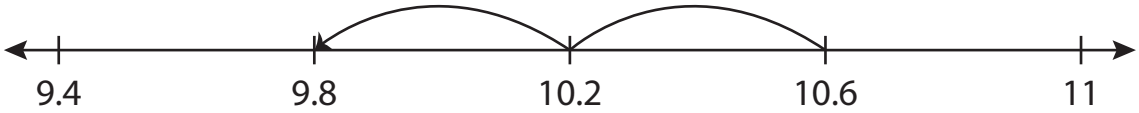

10.6 – 0.8 = **9.8**

Name : _____

Number Line Subtraction

Tenth: S2

Read each number line and solve the problem.

1) 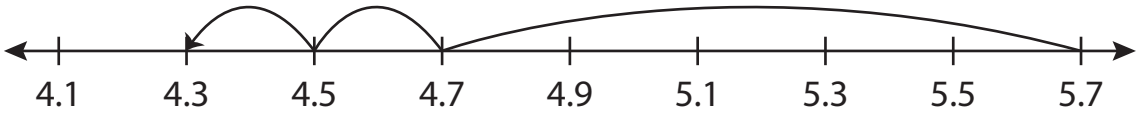

5.7 – 1.4 = _____

2)

3)

4)

5)

7.6 – 0.8 = _____

6) 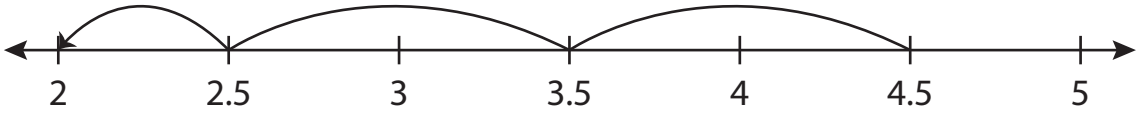

4.5 – 2.5 = _____

PREVIEW

Access the largest collection of worksheets for just $19.95 per year!

Members, please log in to download this worksheet.

Log in

Not a member? Please sign up to gain complete access.

Sign up

www.mathworksheets4kids.com

Name : _____

Answer key

Number Line Subtraction

Tenth: S2

Read each number line and solve the problem.

1) 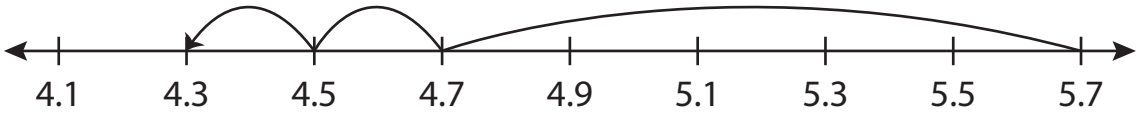

5.7 – 1.4 = **4.3**

2)

3)

4)

5)

7.6 – 0.8 = **6.8**

6) 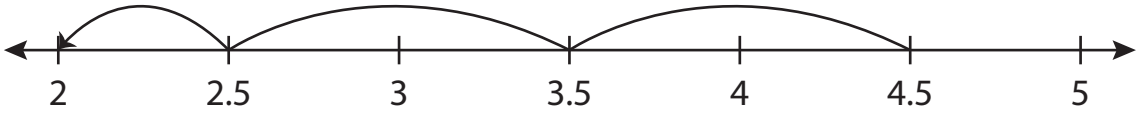

4.5 – 2.5 = **2**

PREVIEW

Access the largest collection of worksheets for just $19.95 per year!

Members, please log in to download this worksheet.

Log in

Not a member? Please sign up to gain complete access.

Sign up

www.mathworksheets4kids.com

Name : _____

Number Line Subtraction

Tenth: S3

Read each number line and solve the problem.

1)

2.8 – 0.7 = _____

2)

3)

4)

PREVIEW

Access the largest collection of worksheets for just $19.95 per year!

Members, please log in to download this worksheet.

Log in

Not a member? Please sign up to gain complete access.

Sign up

www.mathworksheets4kids.com

5) 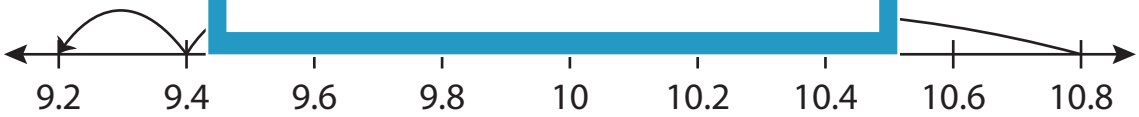

10.8 – 1.6 = _____

6) 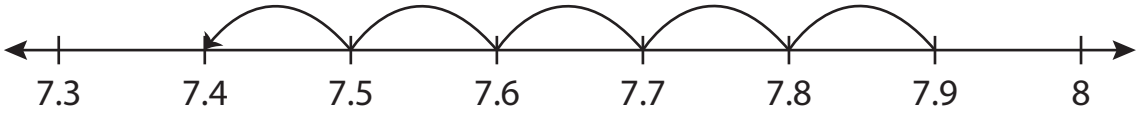

7.9 – 0.5 = _____

Name : _____

Answer key

Number Line Subtraction

Tenth: S3

Read each number line and solve the problem.

1)

2.8 – 0.7 = **2.1**

2)

3)

4)

5)

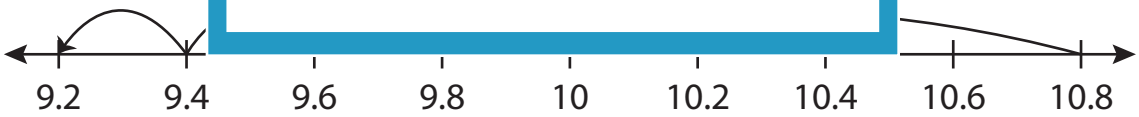

10.8 – 1.6 = **9.2**

6)

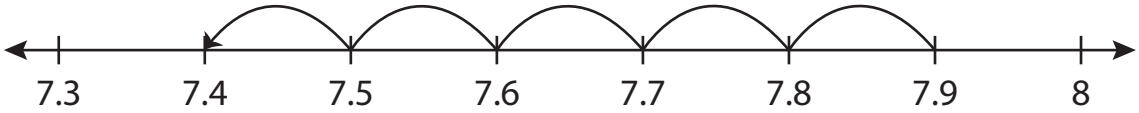

7.9 – 0.5 = **7.4**

PREVIEW

Access the largest collection of worksheets for just **$19.95** per year!

Members, please log in to download this worksheet.

Log in

Not a member? Please sign up to gain complete access.

Sign up

www.mathworksheets4kids.com

Name : _____

Number Line Subtraction

Tenth: S4

Read each number line and solve the problem.

1)

6.3 – 4 = _____

2)

3)

4)

5)

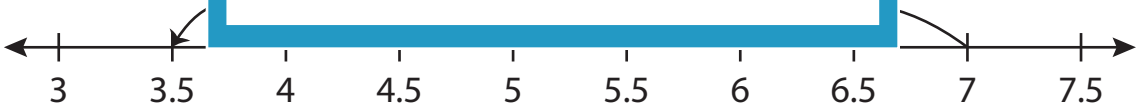

7 – 3.5 = _____

6)



5.8 – 0.9 = _____

PREVIEW

Access the largest collection of worksheets for just $19.95 per year!

Members, please log in to download this worksheet.

Log in

Not a member? Please sign up to gain complete access.

Sign up

www.mathworksheets4kids.com

Name : _____

Answer key

Number Line Subtraction

Tenth: S4

Read each number line and solve the problem.

1)

6.3 – 4 = **2.3**

2)

3)

4)

5)

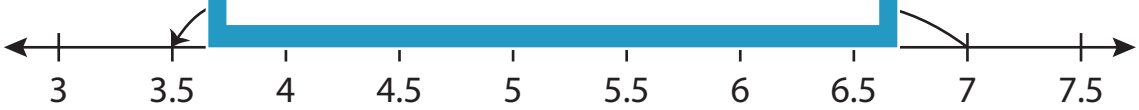

7 – 3.5 = **3.5**

6)



5.8 – 0.9 = **4.9**

PREVIEW

Access the largest collection of worksheets for just $19.95 per year!

Members, please log in to download this worksheet.

Log in

Not a member? Please sign up to gain complete access.

Sign up

www.mathworksheets4kids.com

Name : _____

Number Line Subtraction

Tenth: S5

Read each number line and solve the problem.

1)

13.6 – 3 = _____

2)

3)

4)

5)

6.2 – 0.6 = _____

6) 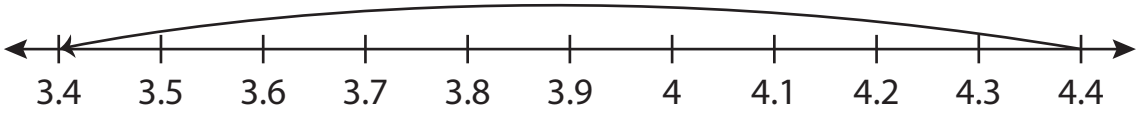

4.4 – 1 = _____

PREVIEW

Access the largest collection of worksheets for just $19.95 per year!

Members, please log in to download this worksheet.

Log in

Not a member? Please sign up to gain complete access.

Sign up

www.mathworksheets4kids.com

Name : _____

Answer key

Number Line Subtraction

Tenth: S5

Read each number line and solve the problem.

1)

13.6 – 3 = **10.6**

2)

3)

4)

5)

6.2 – 0.6 = **5.6**

6)

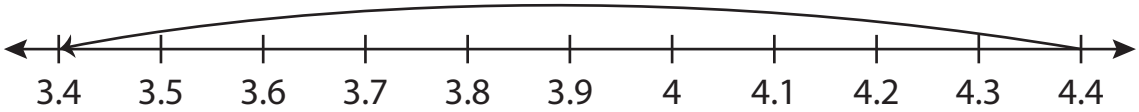

4.4 – 1 = **3.4**

PREVIEW

Access the largest collection of worksheets for just $19.95 per year!

Members, please log in to download this worksheet.

Log in

Not a member? Please sign up to gain complete access.

Sign up

www.mathworksheets4kids.com