Name : _____

Missing Fractions

Proper Fractions: S1

Complete the subtraction sentence that describes each model.

1)

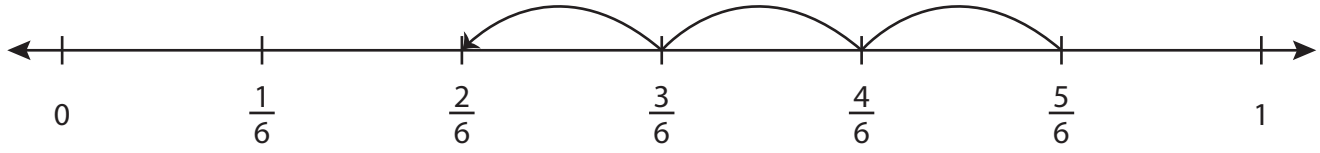

$\frac{5}{6} - \_\_\_\_ = \frac{2}{6}$

2)

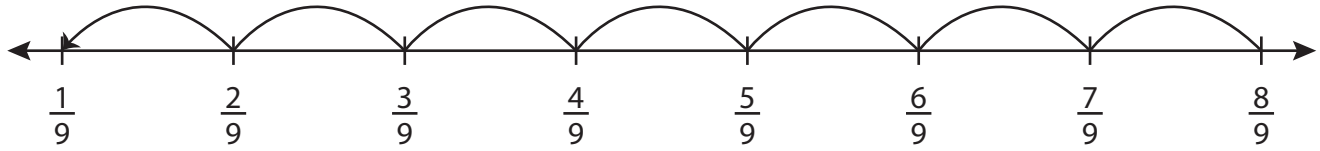

$\frac{8}{9} - \frac{7}{9} = \_\_\_\_$

3)

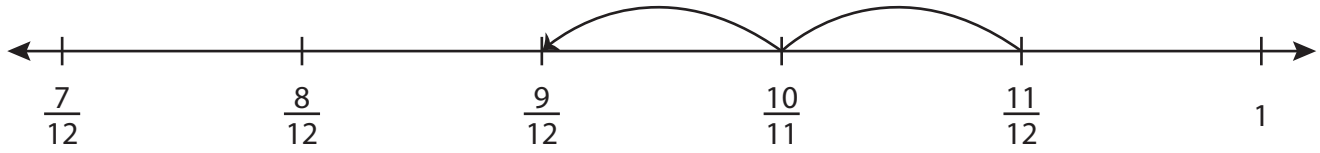

$\_\_\_\_ - \frac{2}{12} = \frac{9}{12}$

4)

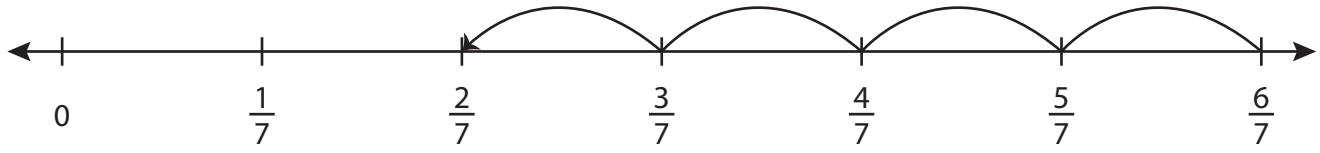

$\frac{6}{7} - \_\_\_\_ = \frac{2}{7}$

5)

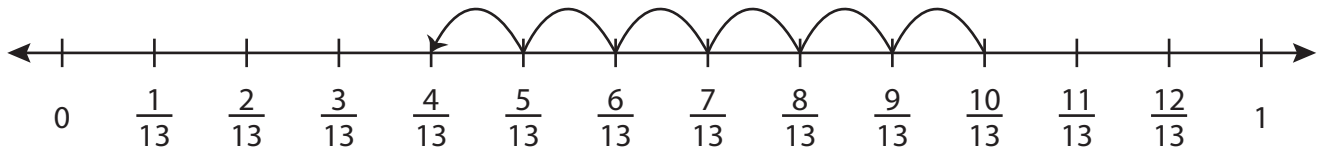

$\_\_\_\_ - \frac{6}{13} = \frac{4}{13}$

Name : _____

Answer key

Missing Fractions

Proper Fractions: S1

Complete the subtraction sentence that describes each model.

1)

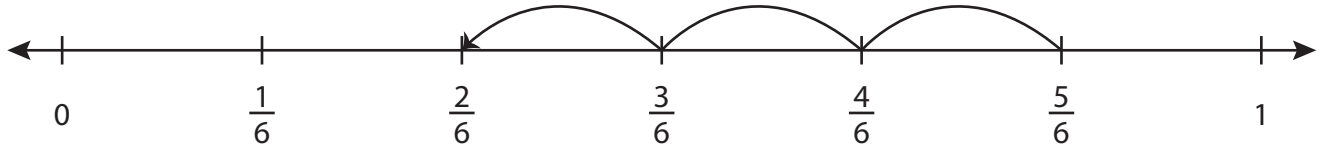

$\frac{5}{6} - \frac{\mathbf{3}}{\mathbf{6}} = \frac{2}{6}$

2)

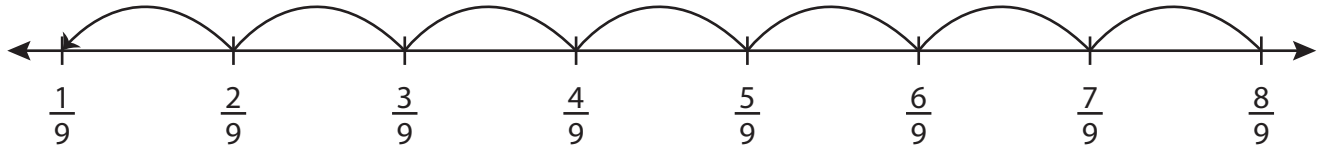

$\frac{8}{9} - \frac{7}{9} = \frac{\mathbf{1}}{\mathbf{9}}$

3)

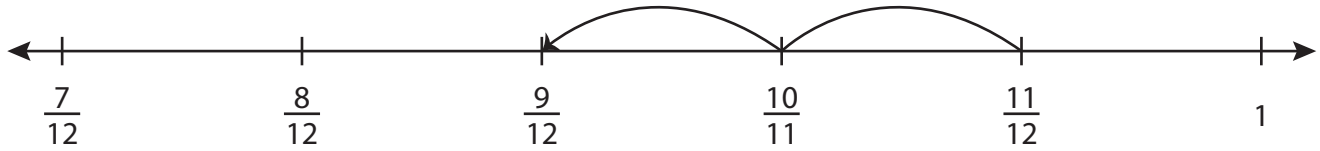

$\frac{\mathbf{11}}{\mathbf{12}} - \frac{2}{12} = \frac{9}{12}$

4)

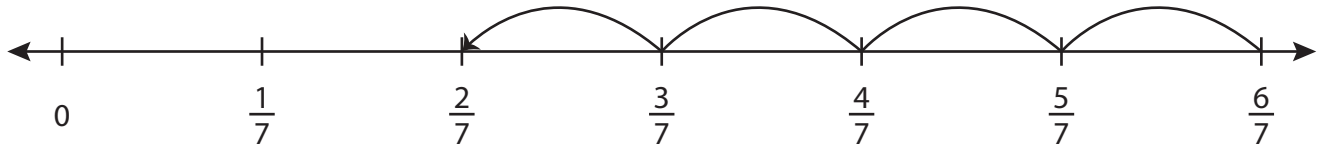

$\frac{6}{7} - \frac{\mathbf{4}}{\mathbf{7}} = \frac{2}{7}$

5)

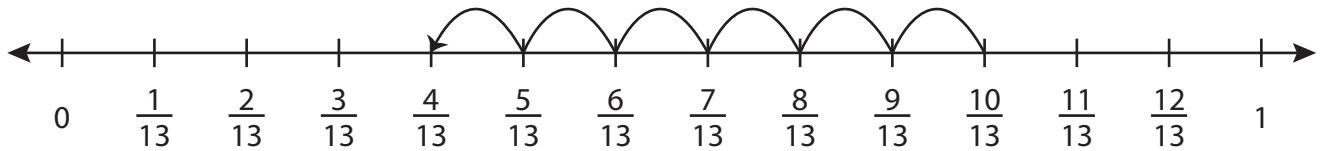

$\frac{\mathbf{10}}{\mathbf{13}} - \frac{6}{13} = \frac{4}{13}$

Name : _____

Missing Fractions

Proper Fractions: S2

Complete the subtraction sentence that describes each model.

1)

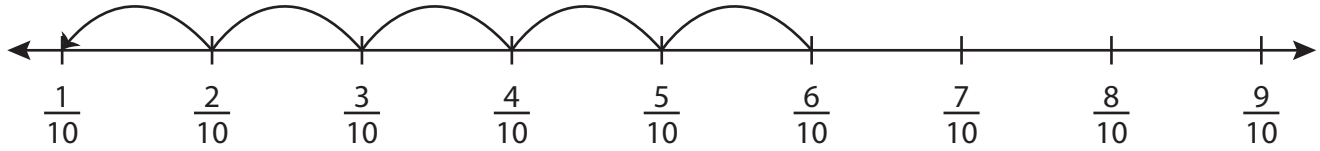

$\_\_\_\_ - \frac{5}{10} = \frac{1}{10}$

2)

3)

4)

$\frac{3}{5} - \frac{1}{5} = \_\_\_\_$

5)

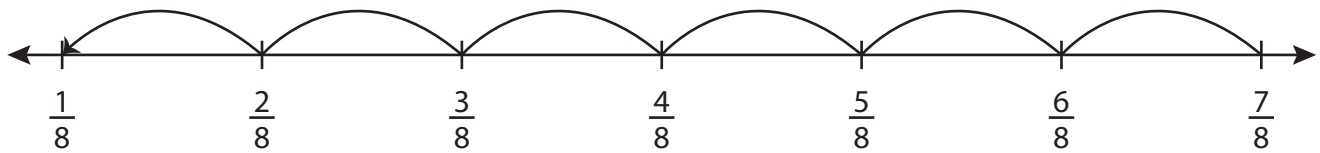

$\frac{7}{8} - \_\_\_\_ = \frac{1}{8}$

PREVIEW

Access the largest collection of worksheets for just $19.95 per year!

Members, please log in to download this worksheet.

Log in

Not a member? Please sign up to gain complete access.

Sign up

www.mathworksheets4kids.com

Name : _____

Answer key

Missing Fractions

Proper Fractions: S2

Complete the subtraction sentence that describes each model.

1)

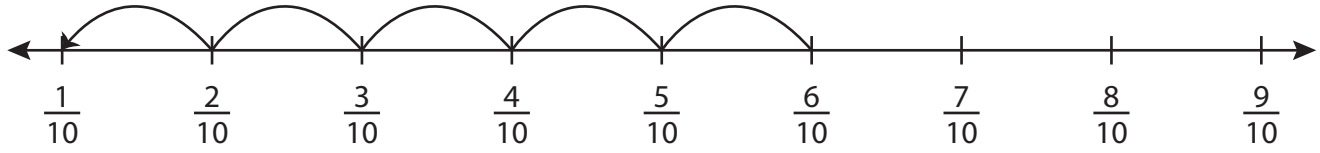

$\frac{6}{10} - \frac{5}{10} = \frac{1}{10}$

2)

3)

4)

$\frac{3}{5} - \frac{1}{5} = \frac{2}{5}$

5)

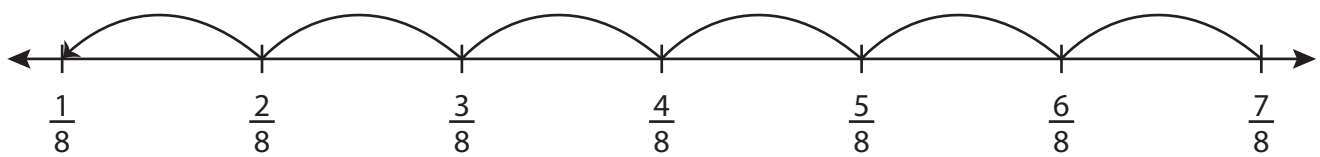

$\frac{7}{8} - \frac{6}{8} = \frac{1}{8}$

PREVIEW

Access the largest collection of worksheets for just $19.95 per year!

Members, please log in to download this worksheet.

Log in

Not a member? Please sign up to gain complete access.

Sign up

www.mathworksheets4kids.com

Name : _____

Missing Fractions

Proper Fractions: S3

Complete the subtraction sentence that describes each model.

1)

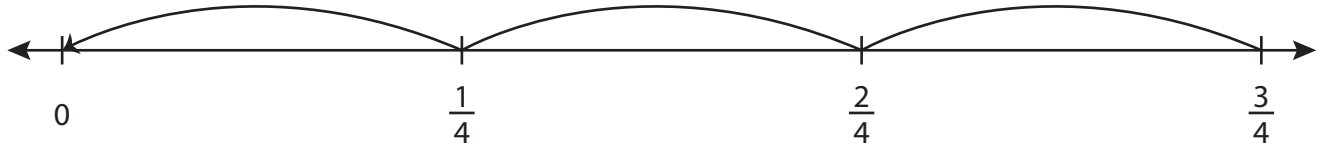

$\frac{3}{4} - \frac{3}{4} =$ _____

2)

$\frac{9}{11}$

3)

$\frac{6}{9}$

4)

_____ $- \frac{5}{12} = \frac{6}{12}$

5)

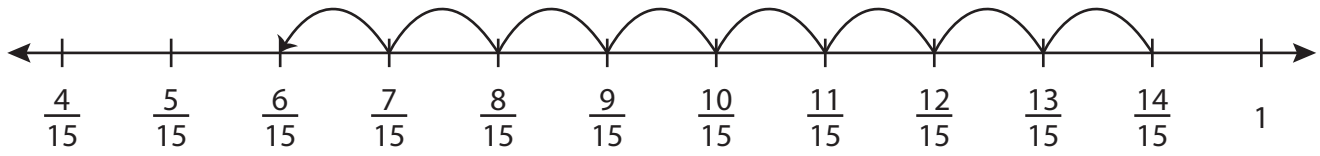

$\frac{14}{15} - \frac{8}{15} =$ _____

PREVIEW

Access the largest collection of worksheets for just $19.95 per year!

Members, please log in to download this worksheet.

Log in

Not a member? Please sign up to gain complete access.

Sign up

www.mathworksheets4kids.com

Name : _____

Answer key

Missing Fractions

Proper Fractions: S3

Complete the subtraction sentence that describes each model.

1)

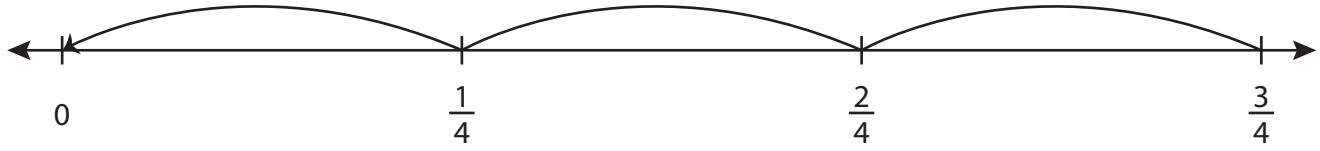

$\frac{3}{4} - \frac{3}{4} = \underline{\mathbf{0}}$

2)

$\frac{9}{11}$

3)

$\frac{6}{9}$

4)

$\underline{\mathbf{\frac{11}{12}}} - \frac{5}{12} = \frac{6}{12}$

5)

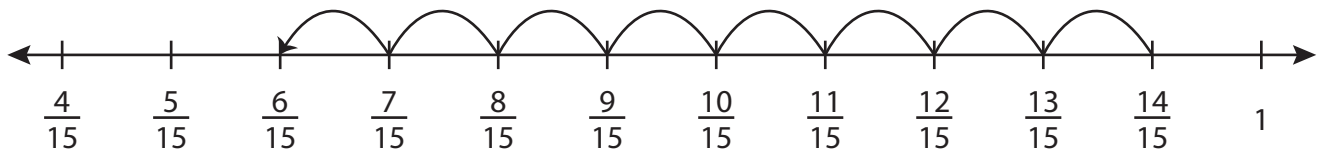

$\frac{14}{15} - \frac{8}{15} = \underline{\mathbf{\frac{6}{15} = \frac{2}{5}}}$

PREVIEW

Access the largest collection of worksheets for just $19.95 per year!

Members, please log in to download this worksheet.

Log in

Not a member? Please sign up to gain complete access.

Sign up

www.mathworksheets4kids.com

Name : _____

Missing Fractions

Proper Fractions: S4

Complete the subtraction sentence that describes each model.

1)

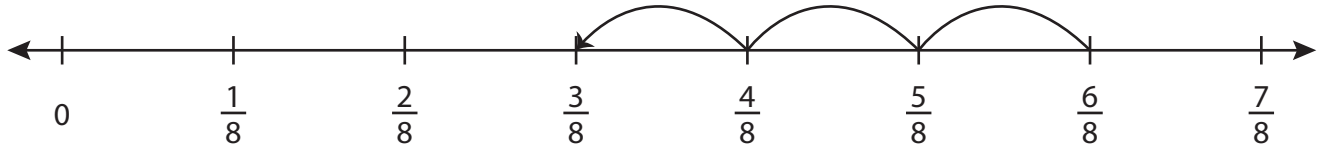

$\frac{6}{8}$ − _____ = $\frac{3}{8}$

2)

_____

3)

$\frac{10}{12}$

4)

$\frac{4}{6}$ − _____ = $\frac{2}{6}$

5)

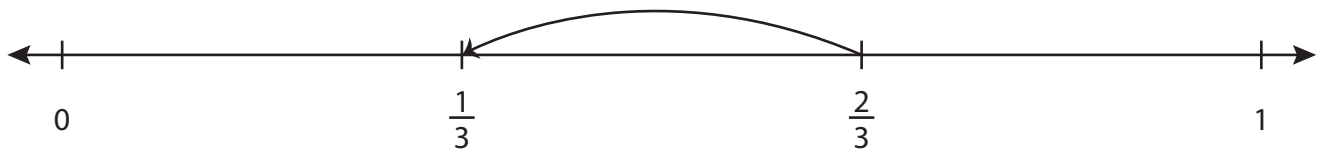

_____ − $\frac{1}{3}$ = $\frac{1}{3}$

PREVIEW

Access the largest collection of worksheets for just $19.95 per year!

Members, please log in to download this worksheet.

Log in

Not a member? Please sign up to gain complete access.

Sign up

www.mathworksheets4kids.com

Name : _____

Answer key

Missing Fractions

Proper Fractions: S4

Complete the subtraction sentence that describes each model.

1)

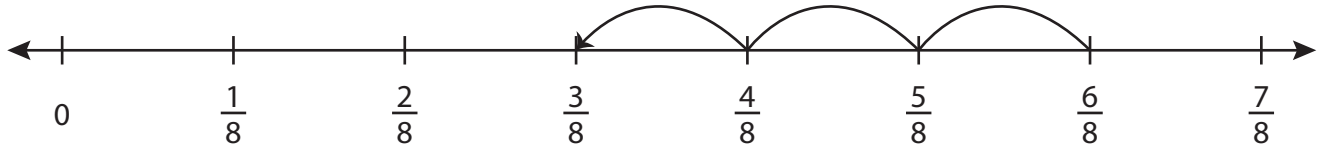

$\frac{6}{8} - \frac{3}{8} = \frac{3}{8}$

2)

$\frac{12}{15}$

3)

$\frac{10}{12}$

4)

$\frac{4}{6} - \frac{2}{6} = \frac{2}{6}$

5)

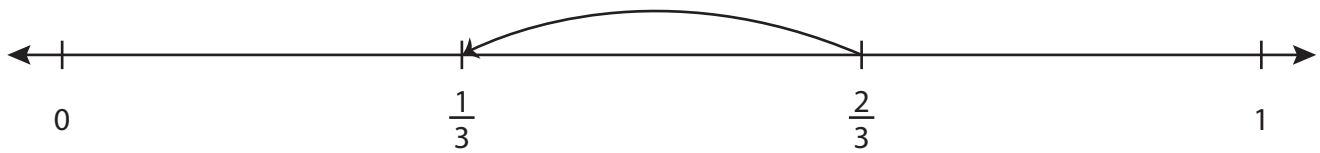

$\frac{2}{3} - \frac{1}{3} = \frac{1}{3}$

PREVIEW

Access the largest collection of worksheets for just $19.95 per year!

Members, please log in to download this worksheet.

Log in

Not a member? Please sign up to gain complete access.

Sign up

www.mathworksheets4kids.com

Name : _____

Missing Fractions

Proper Fractions: S5

Complete the subtraction sentence that describes each model.

1)

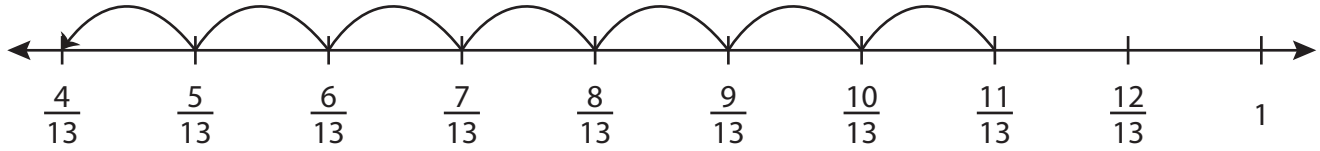

$\frac{11}{13} - \frac{7}{13} = \_\_\_\_$

2)

3)

$\frac{7}{11} - \_\_\_\_ = \_\_\_\_$

4)

$\_\_\_\_ - \frac{3}{5} = \frac{1}{5}$

5)

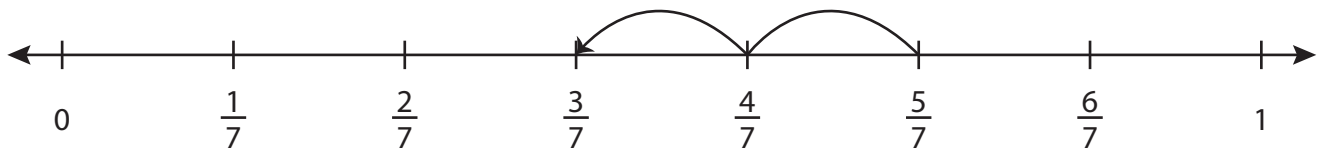

$\frac{5}{7} - \_\_\_\_ = \frac{3}{7}$

PREVIEW

Access the largest collection of worksheets for just $19.95 per year!

Members, please log in to download this worksheet.

Log in

Not a member? Please sign up to gain complete access.

Sign up

www.mathworksheets4kids.com

Name : _____

Answer key

Missing Fractions

Proper Fractions: S5

Complete the subtraction sentence that describes each model.

1)

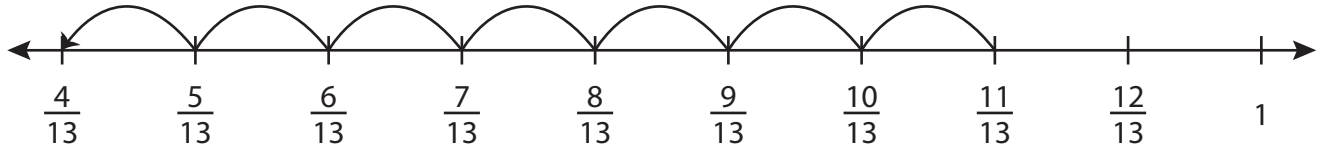

$\frac{11}{13} - \frac{7}{13} = \frac{4}{13}$

2)

$\frac{12}{14} - \frac{7}{14} = \frac{5}{14}$

3)

$\frac{7}{11} - \frac{1}{11} = \frac{6}{11}$

4)

$\frac{4}{5} - \frac{3}{5} = \frac{1}{5}$

5)

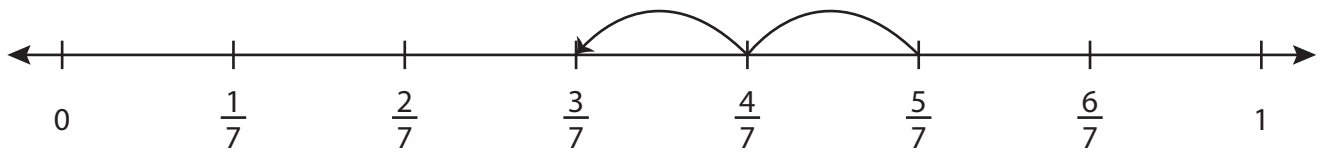

$\frac{5}{7} - \frac{2}{7} = \frac{3}{7}$

PREVIEW

Access the largest collection of worksheets for just $19.95 per year!

Members, please log in to download this worksheet.

Log in

Not a member? Please sign up to gain complete access.

Sign up

www.mathworksheets4kids.com

Name : _____

Missing Fractions

Mixed Numbers: S1

Complete the subtraction sentence that describes each model.

1)

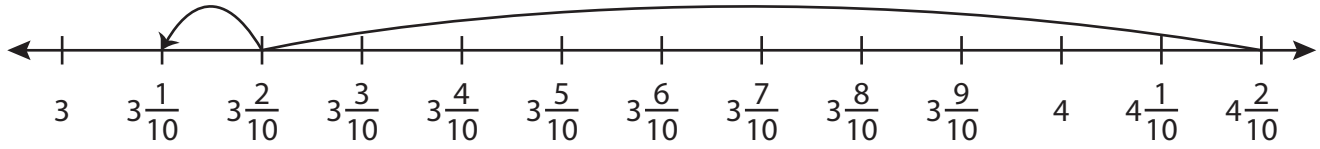

$4\frac{2}{10}$ − _____ = $3\frac{1}{10}$

2)

3)

4)

$3\frac{3}{4}$ − _____ = $1\frac{1}{4}$

5)

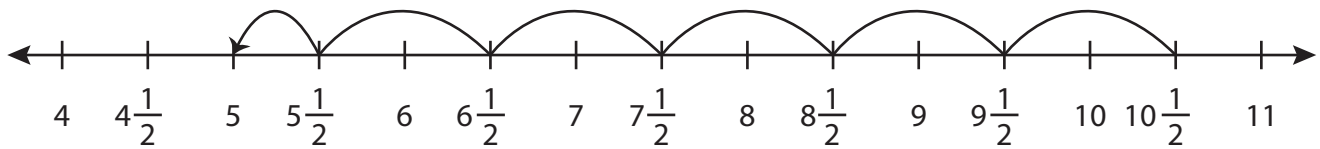

$10\frac{1}{2}$ − $5\frac{1}{2}$ = _____

PREVIEW

Access the largest collection of worksheets for just $19.95 per year!

Members, please log in to download this worksheet.

Log in

Not a member? Please sign up to gain complete access.

Sign up

www.mathworksheets4kids.com

Name : _____

Answer key

Missing Fractions

Mixed Numbers: S1

Complete the subtraction sentence that describes each model.

1)

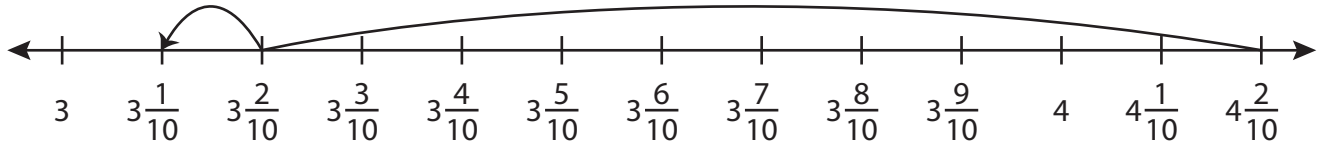

$4\frac{2}{10}$ − $1\frac{1}{10}$ = $3\frac{1}{10}$

2)

3)

4)

$3\frac{3}{4}$ − $2\frac{2}{4}$ = $1\frac{1}{4}$

5)

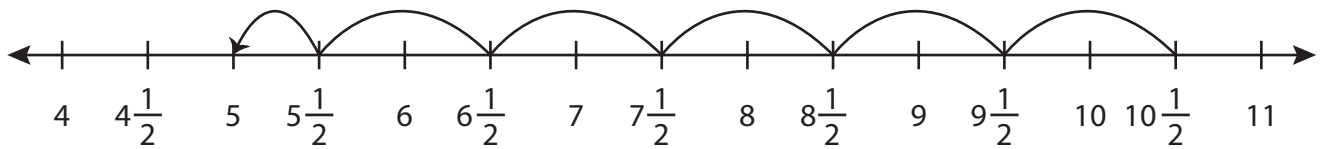

$10\frac{1}{2}$ − $5\frac{1}{2}$ = 5

PREVIEW

Access the largest collection of worksheets for just $19.95 per year!

Members, please log in to download this worksheet.

Log in

Not a member? Please sign up to gain complete access.

Sign up

www.mathworksheets4kids.com

Name : _____

Missing Fractions

Mixed Numbers: S2

Complete the subtraction sentence that describes each model.

1)

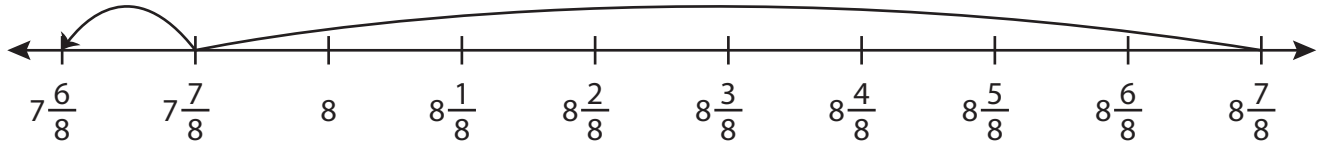

_____ − $1\frac{1}{8}$ = $7\frac{6}{8}$

2)

3)

4)

_____ − $2\frac{2}{3}$ = $4\frac{2}{3}$

5)

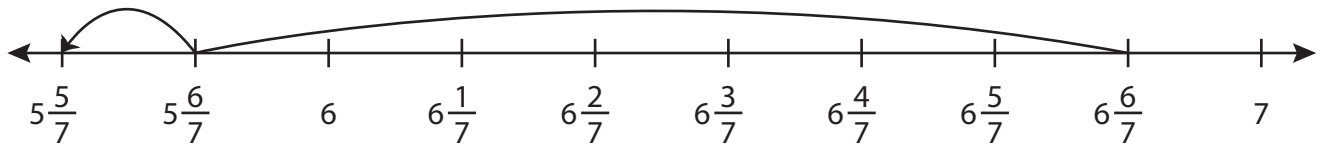

$6\frac{6}{7}$ − _____ = $5\frac{5}{7}$

PREVIEW

Access the largest collection of worksheets for just $19.95 per year!

Members, please log in to download this worksheet.

Log in

Not a member? Please sign up to gain complete access.

Sign up

www.mathworksheets4kids.com

Name : _____

Answer key

Missing Fractions

Mixed Numbers: S2

Complete the subtraction sentence that describes each model.

1)

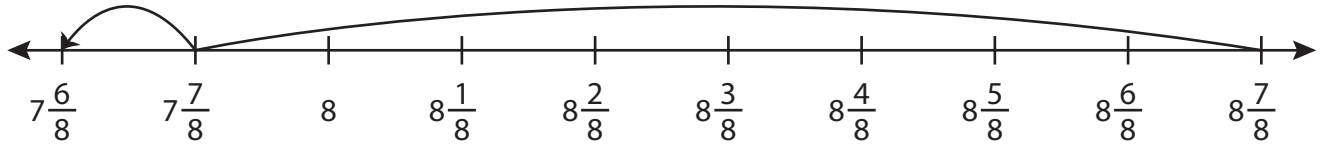

$8\frac{7}{8}$ − $1\frac{1}{8}$ = $7\frac{6}{8}$

2)

3)

4)

$7\frac{1}{3}$ − $2\frac{2}{3}$ = $4\frac{2}{3}$

5)

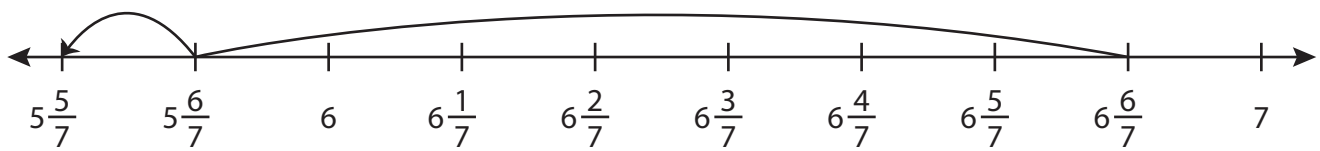

$6\frac{6}{7}$ − $1\frac{1}{7}$ = $5\frac{5}{7}$

PREVIEW

Access the largest collection of worksheets for just $19.95 per year!

Members, please log in to download this worksheet.

Log in

Not a member? Please sign up to gain complete access.

Sign up

www.mathworksheets4kids.com

Name : _____

Missing Fractions

Mixed Numbers: S3

Complete the subtraction sentence that describes each model.

1)

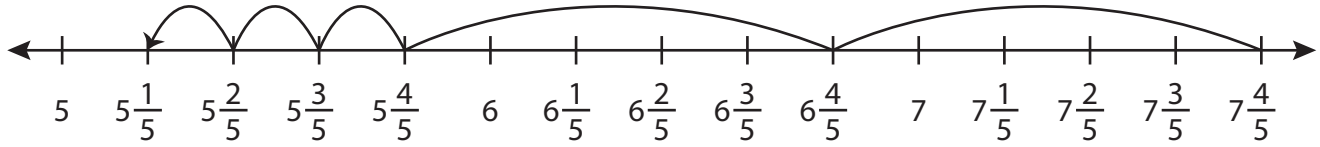

$7\frac{4}{5}$ – $2\frac{3}{5}$ = _____

2)

_____

3)

10

4)

$9\frac{5}{8}$ – $1\frac{4}{8}$ = _____

5)

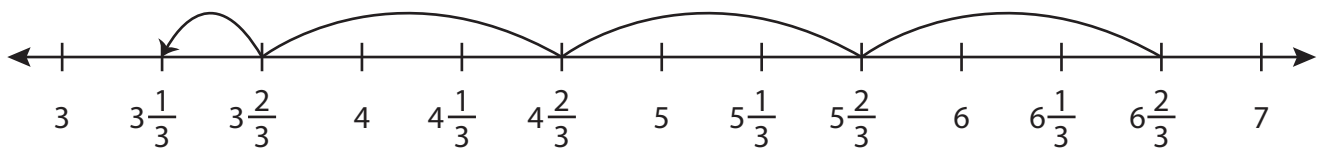

_____ – $3\frac{1}{3}$ = $3\frac{1}{3}$

PREVIEW

Access the largest collection of worksheets for just $19.95 per year!

Members, please log in to download this worksheet.

Log in

Not a member? Please sign up to gain complete access.

Sign up

www.mathworksheets4kids.com

Name : _____

Answer key

Missing Fractions

Mixed Numbers: S3

Complete the subtraction sentence that describes each model.

1)

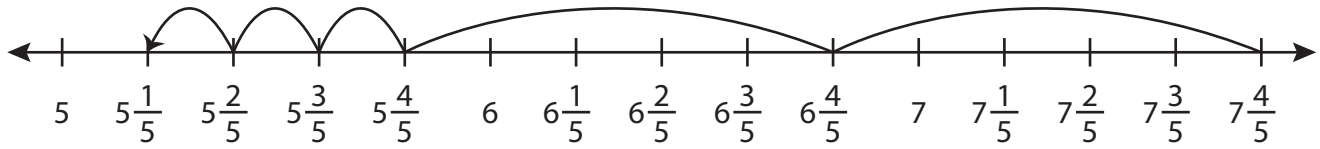

$7\frac{4}{5} - 2\frac{3}{5} = 5\frac{1}{5}$

2)

5-

3)

10

4)

$9\frac{5}{8} - 1\frac{4}{8} = 8\frac{1}{8}$

5)

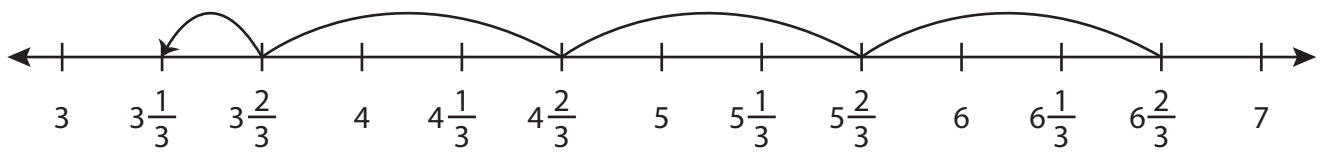

$6\frac{2}{3} - 3\frac{1}{3} = 3\frac{1}{3}$

PREVIEW

Access the largest collection of worksheets for just $19.95 per year!

Members, please log in to download this worksheet.

Log in

Not a member? Please sign up to gain complete access.

Sign up

www.mathworksheets4kids.com

Name : _____

Missing Fractions

Mixed Numbers: S4

Complete the subtraction sentence that describes each model.

1)

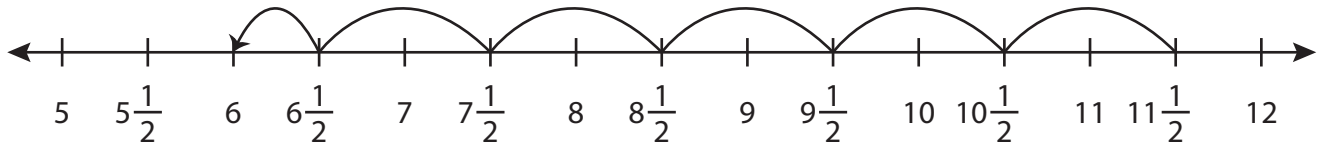

$11\frac{1}{2}$ – _____ = 6

2)

3)

4)

_____ – $1\frac{2}{10}$ = $6\frac{7}{10}$

5)

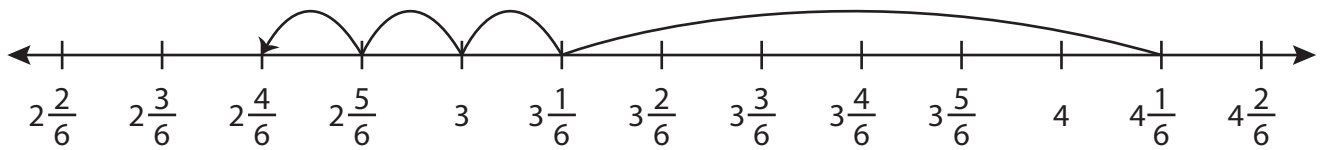

$4\frac{1}{6}$ – $1\frac{3}{6}$ = _____

PREVIEW

Access the largest collection of worksheets for just $19.95 per year!

Members, please log in to download this worksheet.

Log in

Not a member? Please sign up to gain complete access.

Sign up

www.mathworksheets4kids.com

Name : _____

Answer key

Missing Fractions

Mixed Numbers: S4

Complete the subtraction sentence that describes each model.

1)

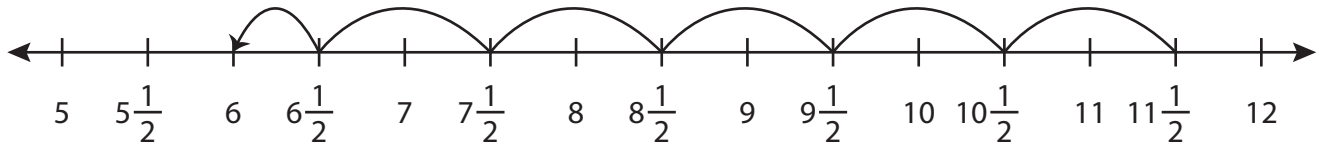

$11\frac{1}{2}$ − $\underline{5\frac{1}{2}}$ = 6

2)

3)

4)

$\underline{7\frac{9}{10}}$ − $1\frac{2}{10}$ = $6\frac{7}{10}$

5)

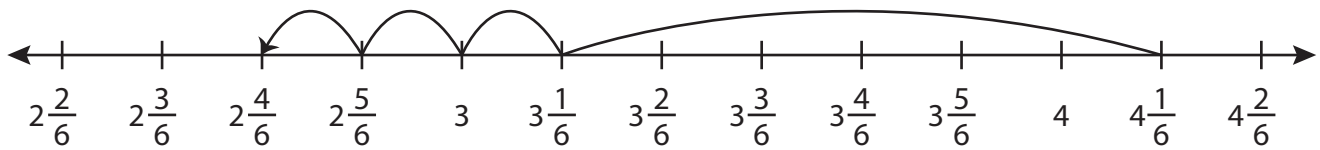

$4\frac{1}{6}$ − $1\frac{3}{6}$ = $\underline{2\frac{4}{6} = 2\frac{2}{3}}$

PREVIEW

Access the largest collection of worksheets for just $19.95 per year!

Members, please log in to download this worksheet.

Log in

Not a member? Please sign up to gain complete access.

Sign up

www.mathworksheets4kids.com

Name : _____

Missing Fractions

Mixed Numbers: S5

Complete the subtraction sentence that describes each model.

1)

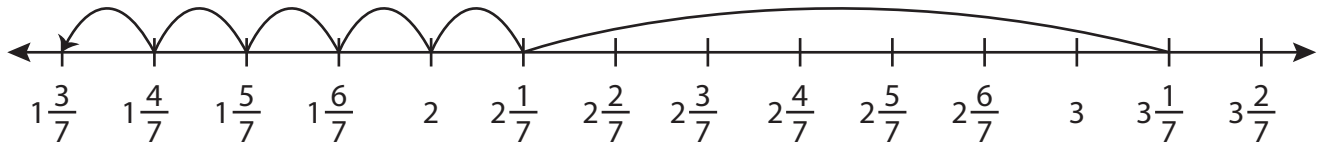

_____ − $1\frac{5}{7}$ = $1\frac{3}{7}$

2)

3)

_____

4)

$8\frac{4}{6}$ − $1\frac{2}{6}$ = _____

5)

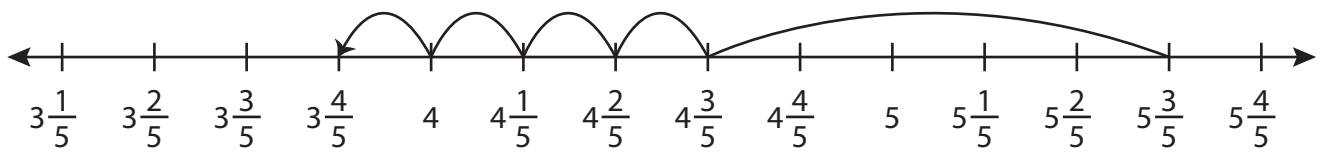

_____ − $1\frac{4}{5}$ = $3\frac{4}{5}$

PREVIEW

Access the largest collection of worksheets for just $19.95 per year!

Members, please log in to download this worksheet.

Log in

Not a member? Please sign up to gain complete access.

Sign up

www.mathworksheets4kids.com

Name : _____

Answer key

Missing Fractions

Mixed Numbers: S5

Complete the subtraction sentence that describes each model.

1)

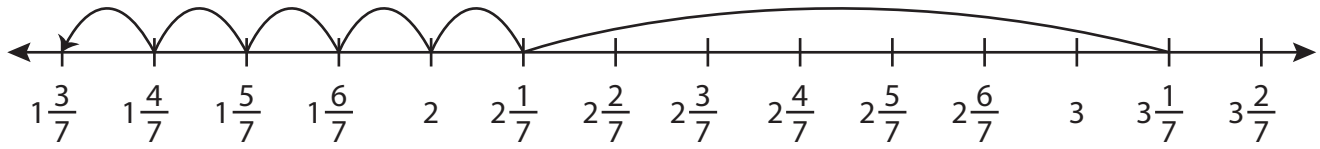

$3\frac{1}{7}$ − $1\frac{5}{7}$ = $1\frac{3}{7}$

2)

3)

4)

$8\frac{4}{6}$ − $1\frac{2}{6}$ = $7\frac{2}{6} = 7\frac{1}{3}$

5)

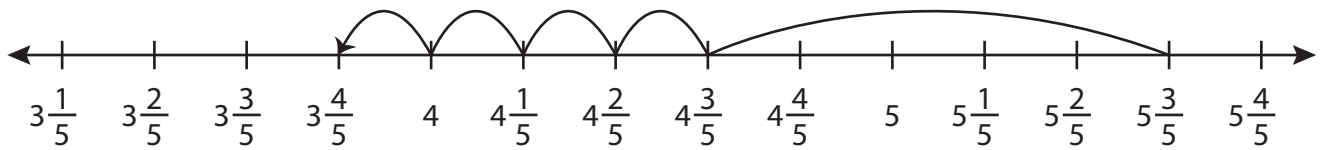

$5\frac{3}{5}$ − $1\frac{4}{5}$ = $3\frac{4}{5}$

PREVIEW

Access the largest collection of worksheets for just $19.95 per year!

Members, please log in to download this worksheet.

Log in

Not a member? Please sign up to gain complete access.

Sign up

www.mathworksheets4kids.com