Name : _____

Subtraction Sentence

Mixed Review: T1S1

Complete the subtraction sentence that describes each model.

1)

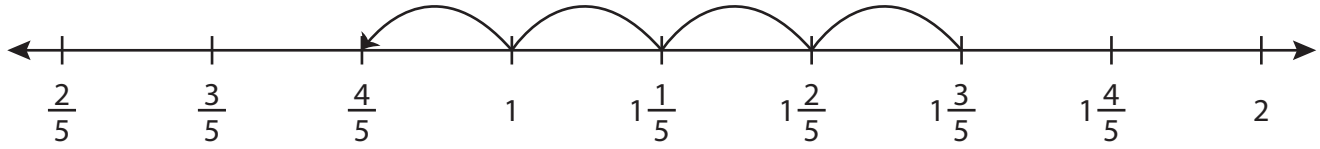

____ − ____ = ____

2)

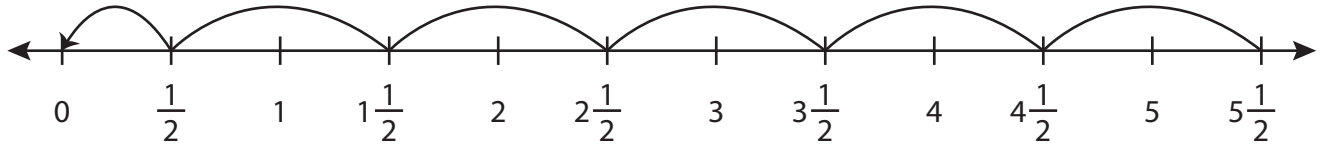

____ − ____ = ____

3)

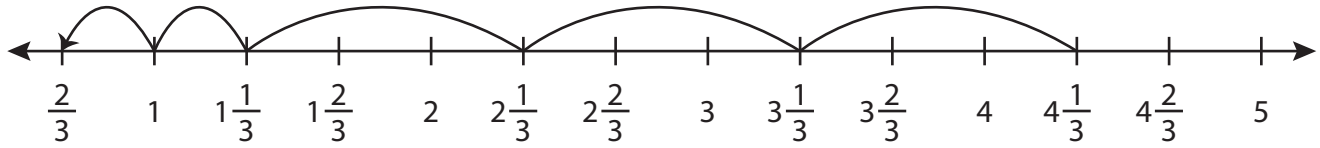

____ − ____ = ____

4)

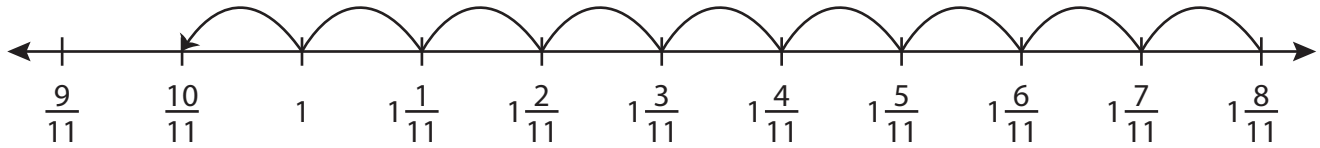

____ − ____ = ____

5)

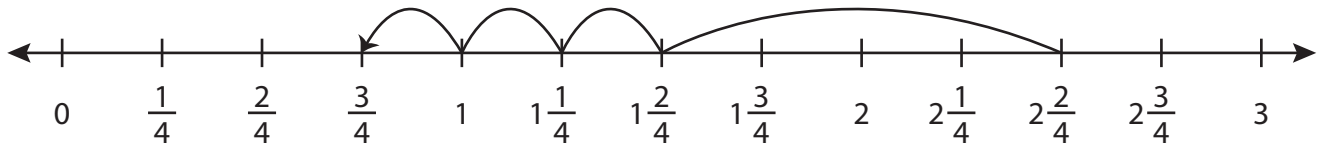

____ − ____ = ____

Name : _____

Answer key

Subtraction Sentence

Mixed Review: T1S1

Complete the subtraction sentence that describes each model.

1)

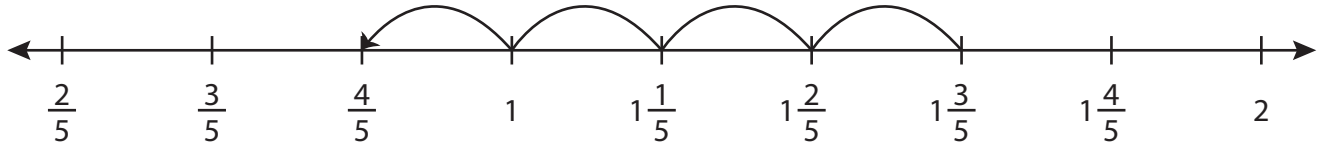

$1\frac{3}{5}$ – $\frac{4}{5}$ = $\frac{4}{5}$

2)

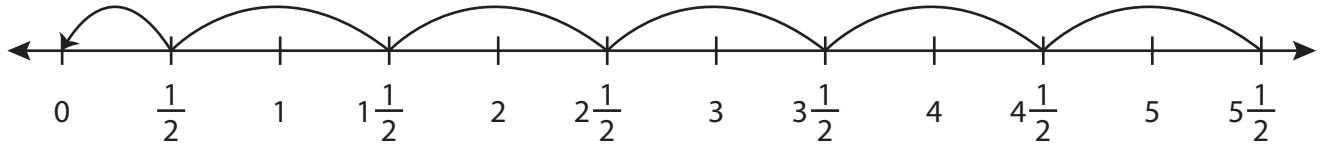

$5\frac{1}{2}$ – $5\frac{1}{2}$ = 0

3)

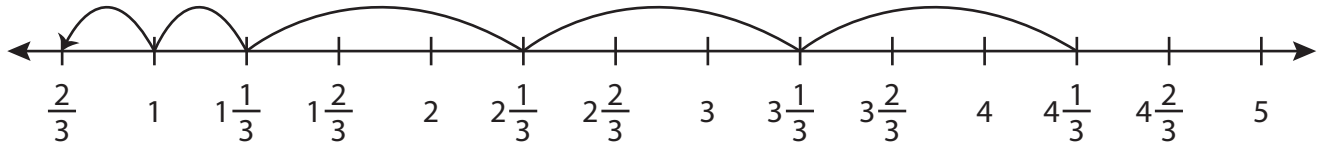

$4\frac{1}{3}$ – $3\frac{2}{3}$ = $\frac{2}{3}$

4)

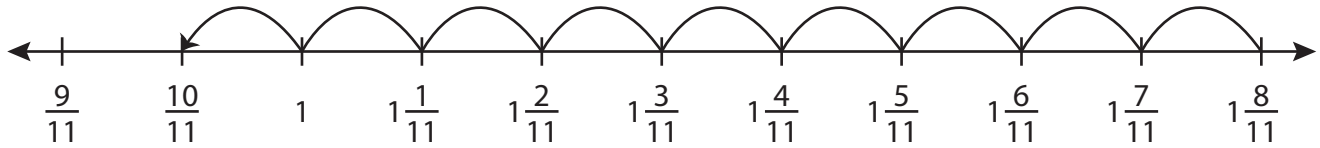

$1\frac{8}{11}$ – $\frac{9}{11}$ = $\frac{10}{11}$

5)

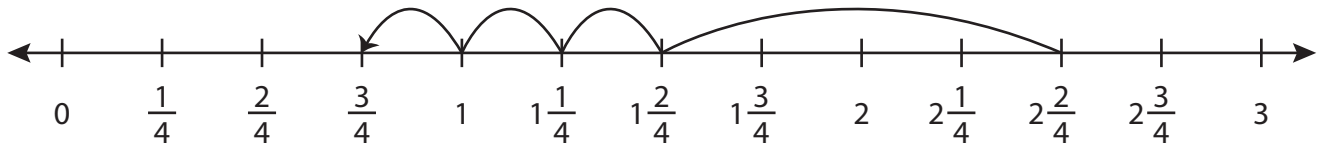

$2\frac{2}{4}$ – $1\frac{3}{4}$ = $\frac{3}{4}$

Name : _____

Subtraction Sentence

Mixed Review: T1S2

Complete the subtraction sentence that describes each model.

1)

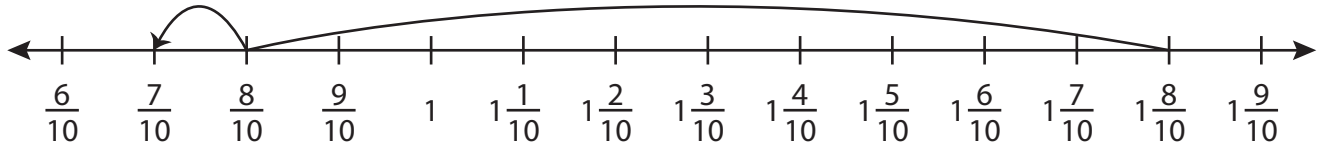

_____ − _____ = _____

2)

_____ − _____ = _____

3)

_____ − _____ = _____

4)

_____ − _____ = _____

5)

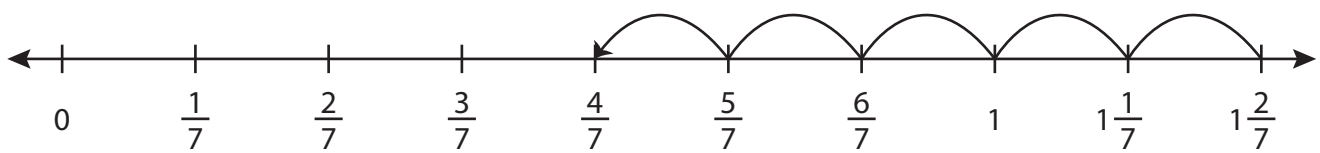

_____ − _____ = _____

PREVIEW

Access the largest collection of worksheets for just $19.95 per year!

Members, please log in to download this worksheet.

Log in

Not a member? Please sign up to gain complete access.

Sign up

www.mathworksheets4kids.com

Name : _____

Answer key

Subtraction Sentence

Mixed Review: T1S2

Complete the subtraction sentence that describes each model.

1)

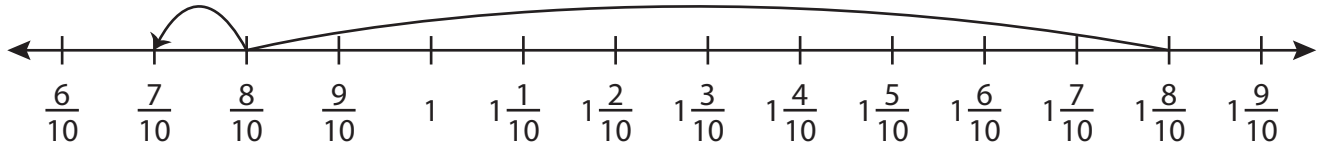

$1\frac{8}{10}$ – $1\frac{1}{10}$ = $\frac{7}{10}$

2)

3)

4)

$3\frac{2}{3}$ – $3\frac{1}{3}$ = $\frac{1}{3}$

5)

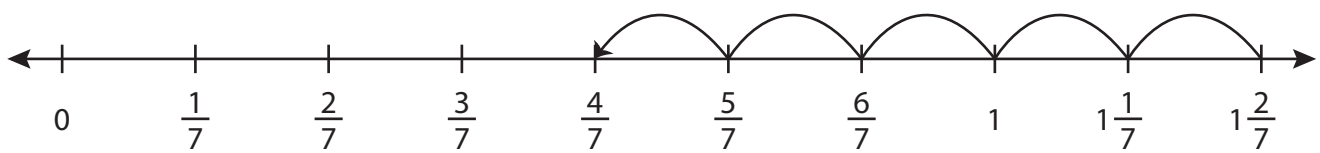

$1\frac{2}{7}$ – $\frac{5}{7}$ = $\frac{4}{7}$

PREVIEW

Access the largest collection of worksheets for just $19.95 per year!

Members, please log in to download this worksheet.

Log in

Not a member? Please sign up to gain complete access.

Sign up

www.mathworksheets4kids.com

Name : _____

Subtraction Sentence

Mixed Review: T1S3

Complete the subtraction sentence that describes each model.

1)

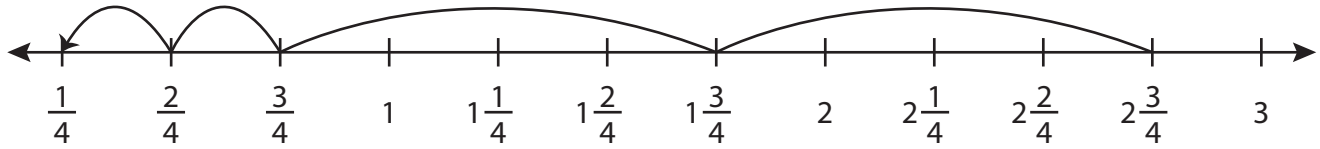

_____ − _____ = _____

2)

_____ − _____ = _____

3)

_____ − _____ = _____

4)

_____ − _____ = _____

5)

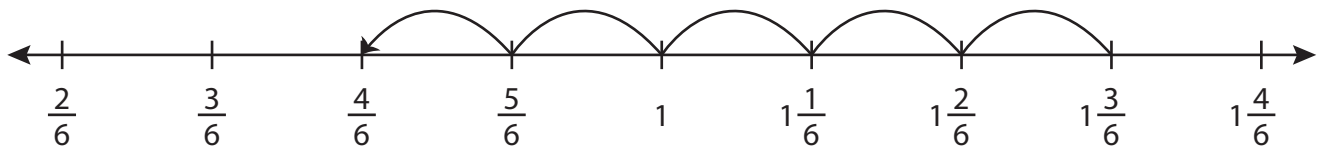

_____ − _____ = _____

PREVIEW

Access the largest collection of worksheets for just $19.95 per year!

Members, please log in to download this worksheet.

Log in

Not a member? Please sign up to gain complete access.

Sign up

www.mathworksheets4kids.com

Name : _____

Answer key

Subtraction Sentence

Mixed Review: T1S3

Complete the subtraction sentence that describes each model.

1)

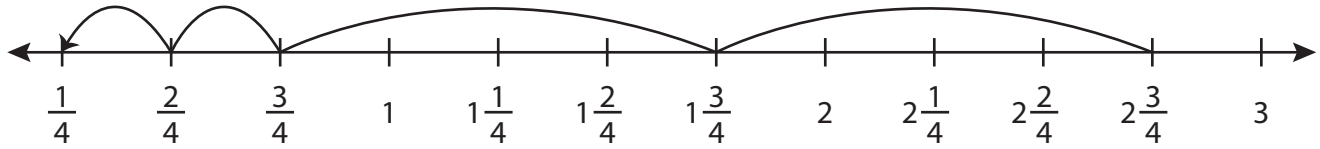

$2\frac{3}{4}$ − $2\frac{2}{4}$ = $\frac{1}{4}$

2)

3)

4)

$1\frac{1}{5}$ − $\frac{3}{5}$ = $\frac{3}{5}$

5)

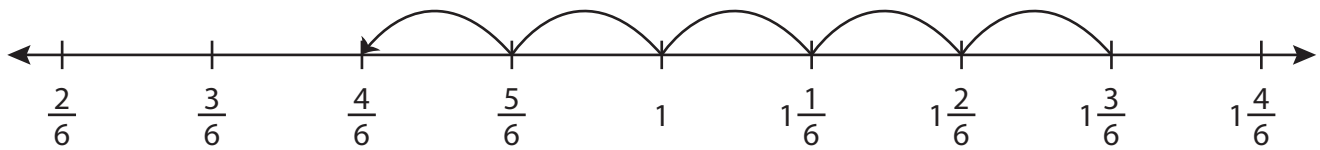

$1\frac{3}{6}$ − $\frac{5}{6}$ = $\frac{4}{6} = \frac{2}{3}$

PREVIEW

Access the largest collection of worksheets for just $19.95 per year!

Members, please log in to download this worksheet.

Log in

Not a member? Please sign up to gain complete access.

Sign up

www.mathworksheets4kids.com

Name : _____

Subtraction Sentence

Mixed Review: T1S4

Complete the subtraction sentence that describes each model.

1)

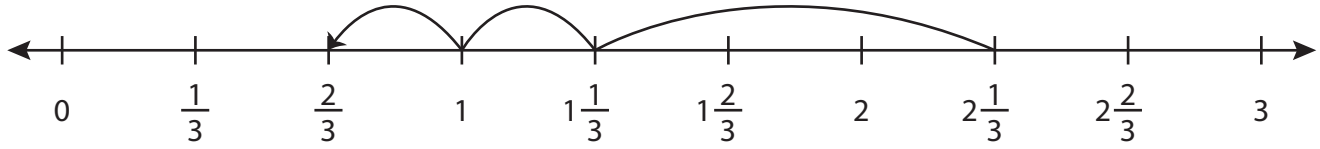

_____ − _____ = _____

2)

_____ − _____ = _____

3)

_____ − _____ = _____

4)

_____ − _____ = _____

5)

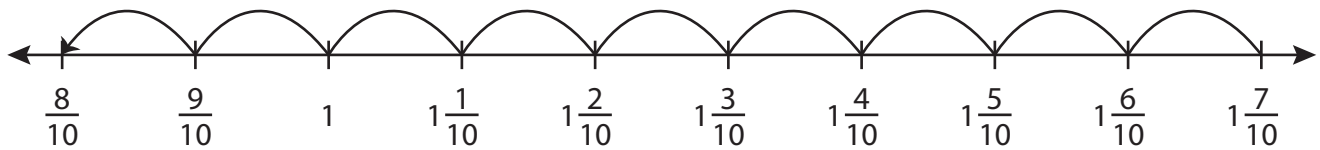

_____ − _____ = _____

PREVIEW

Access the largest collection of worksheets for just $19.95 per year!

Members, please log in to download this worksheet.

Log in

Not a member? Please sign up to gain complete access.

Sign up

www.mathworksheets4kids.com

Name : _____

Answer key

Subtraction Sentence

Mixed Review: T1S4

Complete the subtraction sentence that describes each model.

1)

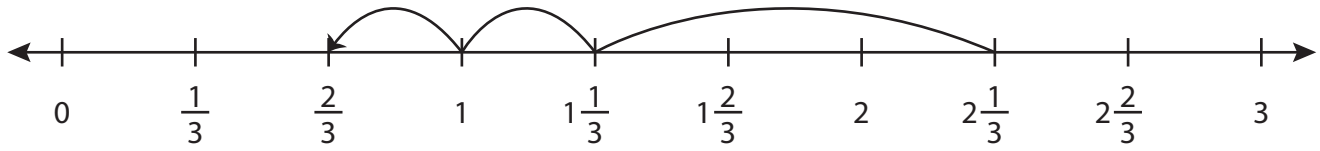

$2\frac{1}{3}$ − $1\frac{2}{3}$ = $\frac{2}{3}$

2)

1

3)

3

4)

$1\frac{1}{8}$ − $\frac{6}{8}$ = $\frac{3}{8}$

5)

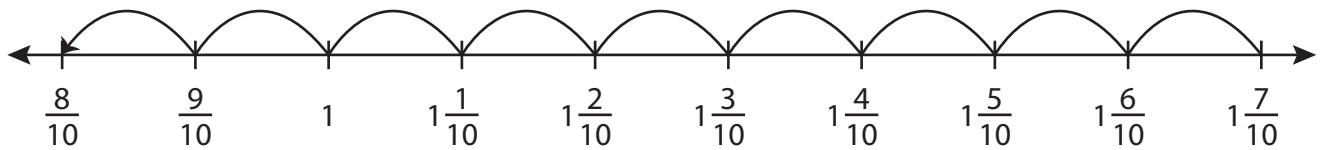

$1\frac{7}{10}$ − $\frac{9}{10}$ = $\frac{8}{10} = \frac{4}{5}$

PREVIEW

Access the largest collection of worksheets for just $19.95 per year!

Members, please log in to download this worksheet.

Log in

Not a member? Please sign up to gain complete access.

Sign up

www.mathworksheets4kids.com

Name : _____

Subtraction Sentence

Mixed Review: T1S5

Complete the subtraction sentence that describes each model.

1)

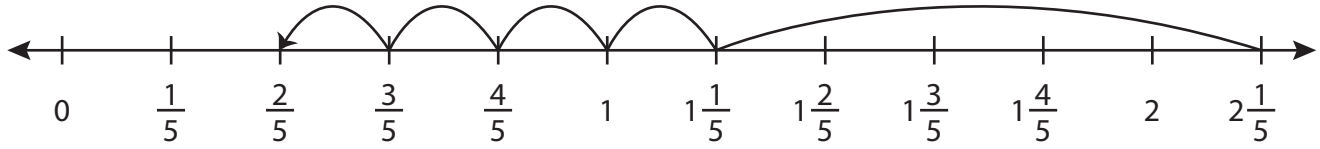

_____ – _____ = _____

2)

_____ – _____ = _____

3)

_____ – _____ = _____

4)

_____ – _____ = _____

5)

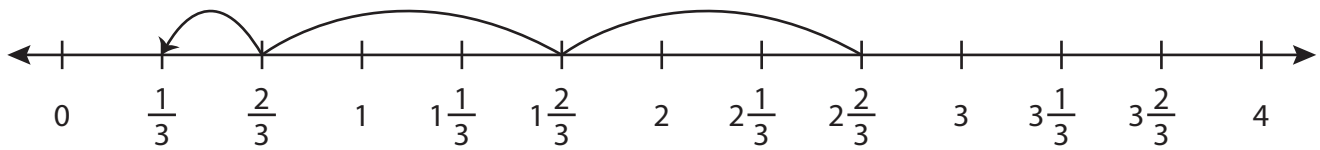

_____ – _____ = _____

PREVIEW

Access the largest collection of worksheets for just $19.95 per year!

Members, please log in to download this worksheet.

Log in

Not a member? Please sign up to gain complete access.

Sign up

www.mathworksheets4kids.com

Name : _____

Answer key

Subtraction Sentence

Mixed Review: T1S5

Complete the subtraction sentence that describes each model.

1)

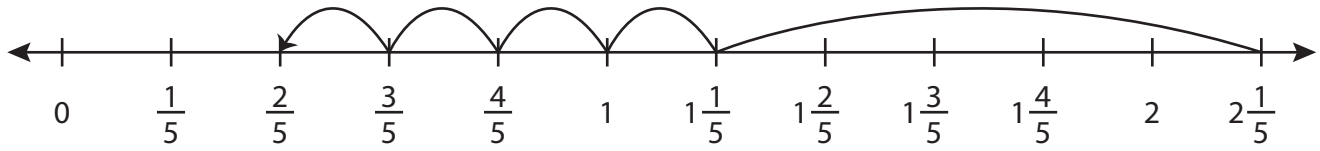

$2\frac{1}{5}$ − $1\frac{4}{5}$ = $\frac{2}{5}$

2)

3)

4)

$1\frac{8}{12}$ − $\frac{10}{12}$ = $\frac{10}{12} = \frac{5}{6}$

5)

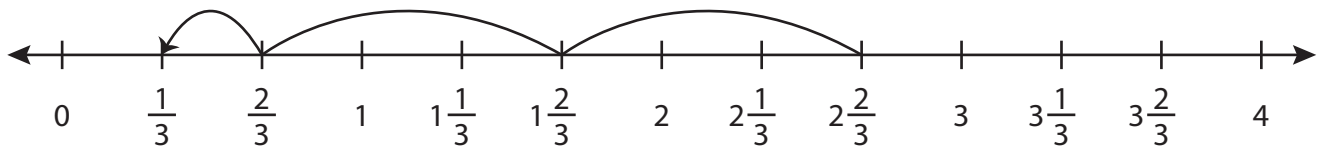

$2\frac{2}{3}$ − $2\frac{1}{3}$ = $\frac{1}{3}$

PREVIEW

Access the largest collection of worksheets for just $19.95 per year!

Members, please log in to download this worksheet.

Log in

Not a member? Please sign up to gain complete access.

Sign up

www.mathworksheets4kids.com