Name : _____ Score : _____

Number Line Multiplication - MCQ

Sheet 1

Identify the correct multiplication sentence for each number line.

1)

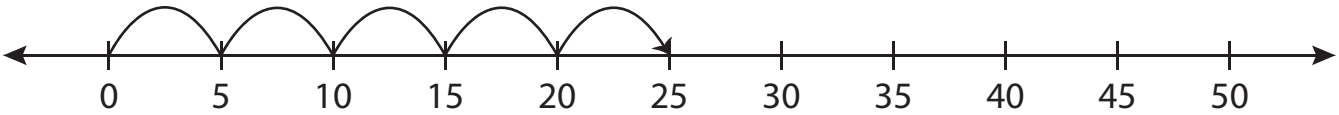

a) $6 \times 5 = 30$ b) $2 \times 5 = 10$ c) $5 \times 5 = 25$ d) $8 \times 5 = 40$

2)

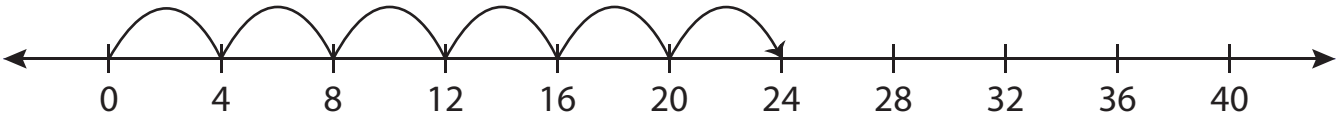

a) $8 \times 3 = 24$ b) $6 \times 4 = 24$ c) $2 \times 12 = 24$ d) $6 \times 6 = 36$

3)

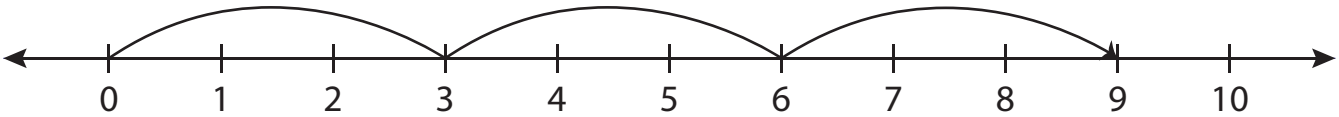

a) $3 \times 3 = 9$ b) $1 \times 3 = 3$ c) $9 \times 3 = 27$ d) $1 \times 9 = 9$

4)

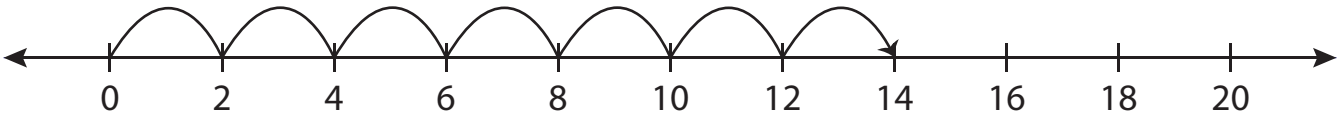

a) $9 \times 2 = 18$ b) $7 \times 2 = 14$ c) $2 \times 8 = 16$ d) $14 \times 2 = 28$

5)

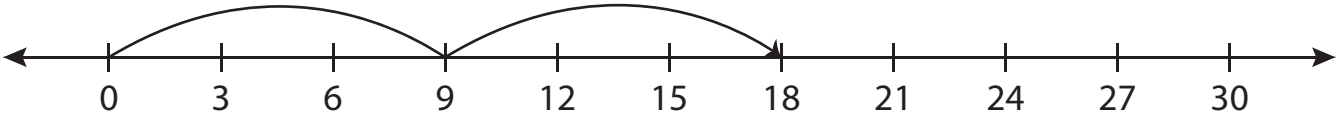

a) $3 \times 6 = 18$ b) $3 \times 9 = 27$ c) $8 \times 2 = 16$ d) $2 \times 9 = 18$

6)

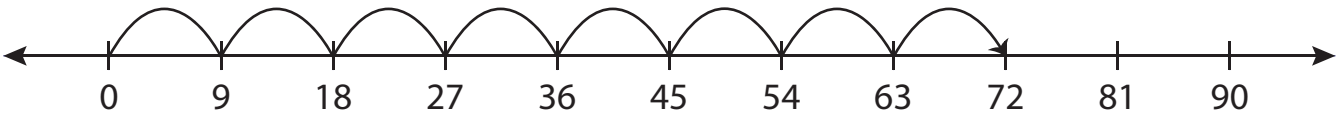

a) $6 \times 12 = 72$ b) $3 \times 9 = 27$ c) $8 \times 9 = 72$ d) $9 \times 7 = 63$

Name : _____ Score : _____

Answer key

Number Line Multiplication - MCQ

Sheet 1

Identify the correct multiplication sentence for each number line.

1)

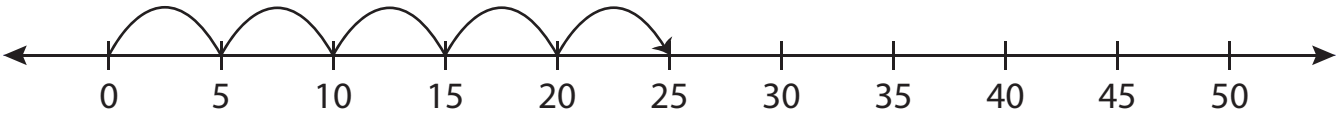

a) $6 \times 5 = 30$ b) $2 \times 5 = 10$ c) $5 \times 5 = 25$ d) $8 \times 5 = 40$

2)

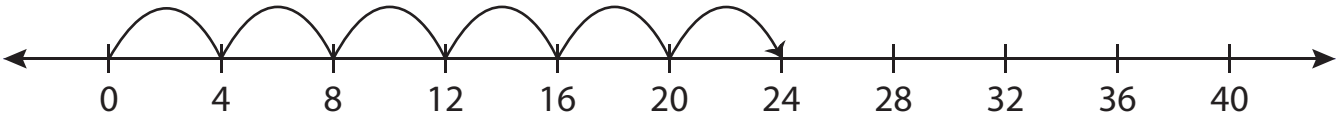

a) $8 \times 3 = 24$ b) $6 \times 4 = 24$ c) $2 \times 12 = 24$ d) $6 \times 6 = 36$

3)

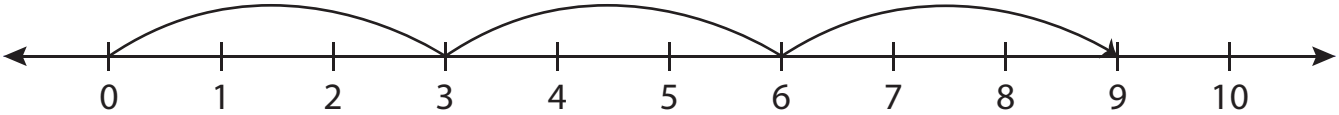

a) $3 \times 3 = 9$ b) $1 \times 3 = 3$ c) $9 \times 3 = 27$ d) $1 \times 9 = 9$

4)

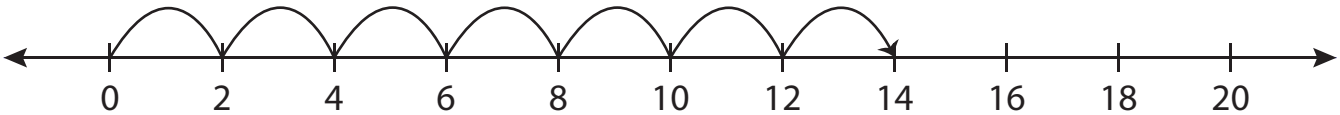

a) $9 \times 2 = 18$ b) $7 \times 2 = 14$ c) $2 \times 8 = 16$ d) $14 \times 2 = 28$

5)

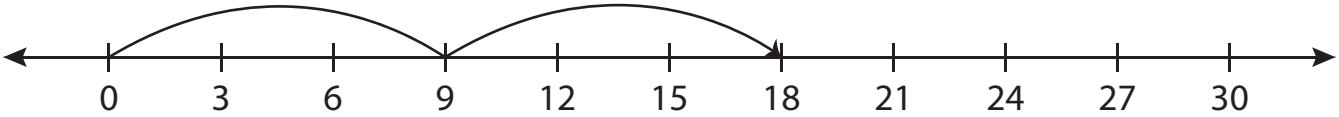

a) $3 \times 6 = 18$ b) $3 \times 9 = 27$ c) $8 \times 2 = 16$ d) $2 \times 9 = 18$

6)

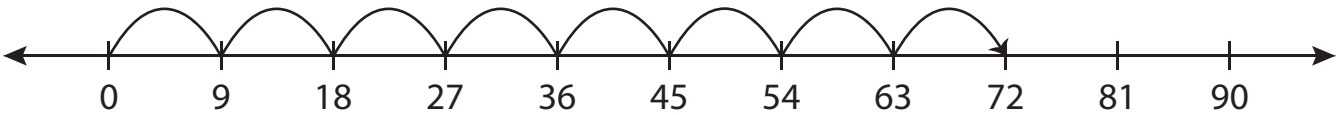

a) $6 \times 12 = 72$ b) $3 \times 9 = 27$ c) $8 \times 9 = 72$ d) $9 \times 7 = 63$

Name : _____ Score : _____

Number Line Multiplication - MCQ

Sheet 2

Identify the correct multiplication sentence for each number line.

1) 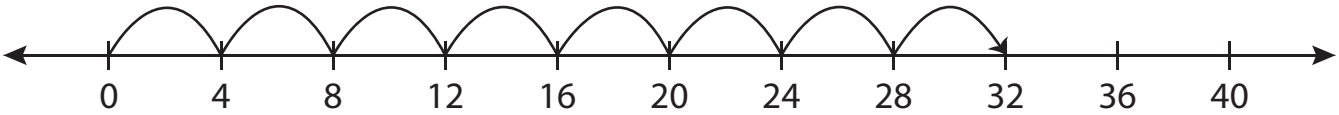

a) $8 \times 6 = 48$ b) $7 \times 4 = 28$ c) $2 \times 16 = 32$ d) $8 \times 4 = 32$

2)

a) $2 \times 2 = 4$ d) $2 \times 4 = 8$

3)

a) $9 \times 9 = 81$ d) $21 \times 3 = 63$

4)

a) $9 \times 1 = 9$ d) $5 \times 3 = 15$

5) 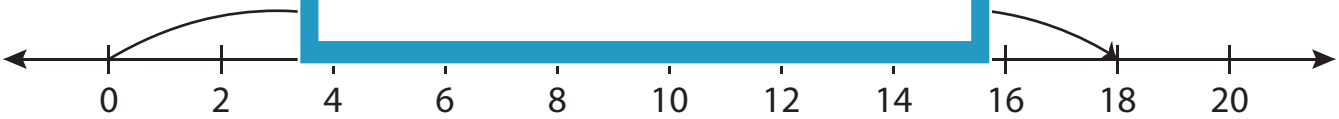

a) $3 \times 6 = 18$ b) $9 \times 2 = 18$ c) $3 \times 9 = 27$ d) $2 \times 6 = 12$

6) 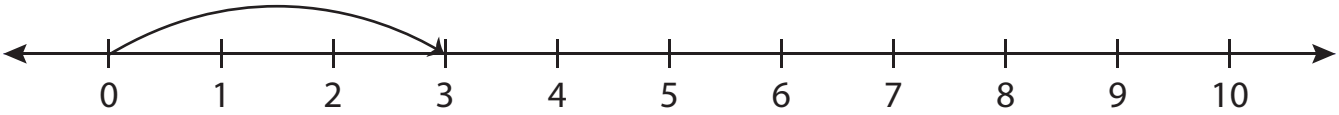

a) $3 \times 3 = 9$ b) $8 \times 1 = 8$ c) $1 \times 6 = 6$ d) $1 \times 3 = 3$

PREVIEW

Access the largest collection of worksheets for just $19.95 per year!

Members, please log in to download this worksheet.

Log in

Not a member? Please sign up to gain complete access.

Sign up

www.mathworksheets4kids.com

Name : _____ Score : _____

Answer key

Number Line Multiplication - MCQ

Sheet 2

Identify the correct multiplication sentence for each number line.

1) 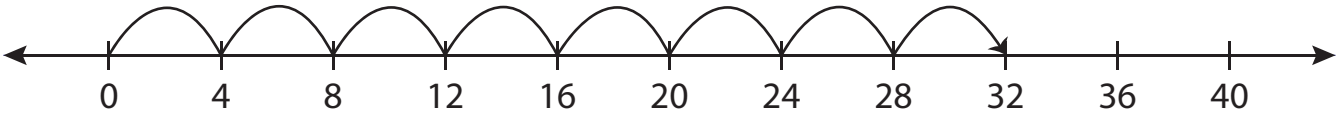

a) $8 \times 6 = 48$ b) $7 \times 4 = 28$ c) $2 \times 16 = 32$ ✓ d) $8 \times 4 = 32$

2)

✓ a) $2 \times 2 = 4$ d) $2 \times 4 = 8$

3)

a) $9 \times 9 = 81$ d) $21 \times 3 = 63$

4)

a) $9 \times 1 = 9$ d) $5 \times 3 = 15$

5) 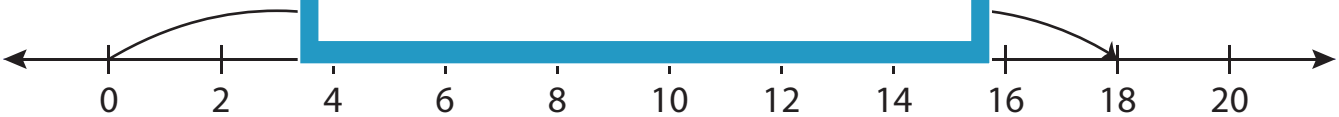

✓ a) $3 \times 6 = 18$ b) $9 \times 2 = 18$ c) $3 \times 9 = 27$ d) $2 \times 6 = 12$

6) 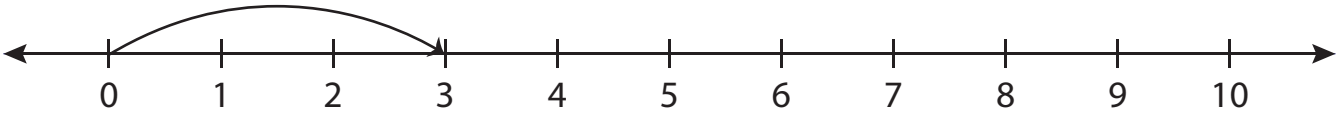

a) $3 \times 3 = 9$ b) $8 \times 1 = 8$ c) $1 \times 6 = 6$ ✓ d) $1 \times 3 = 3$

PREVIEW

Access the largest collection of worksheets for just $19.95 per year!

Members, please log in to download this worksheet.

Log in

Not a member? Please sign up to gain complete access.

Sign up

www.mathworksheets4kids.com

Name : _____ Score : _____

Number Line Multiplication - MCQ

Sheet 3

Identify the correct multiplication sentence for each number line.

1) 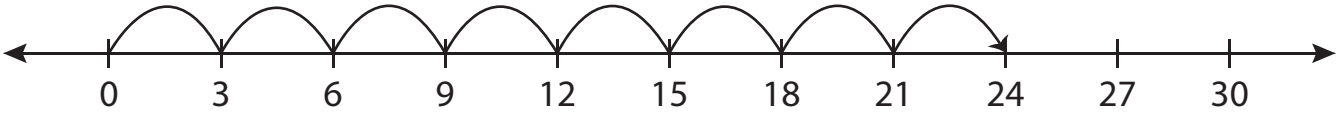

a) $6 \times 4 = 24$ b) $8 \times 3 = 24$ c) $4 \times 3 = 12$ d) $6 \times 5 = 30$

2)

a) $6 \times 3 = 18$ d) $6 \times 6 = 36$

3)

a) $10 \times 5 = 50$ d) $7 \times 9 = 63$

4)

a) $2 \times 4 = 8$ d) $4 \times 1 = 4$

5) 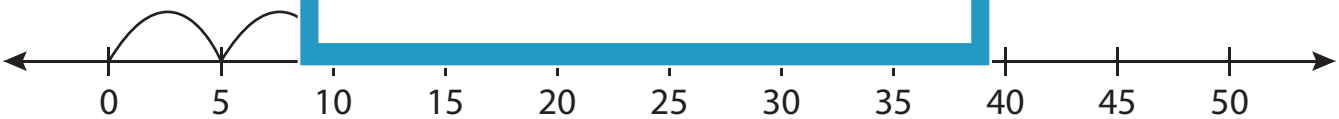

a) $2 \times 10 = 20$ b) $4 \times 5 = 20$ c) $20 \times 1 = 20$ d) $2 \times 15 = 30$

6) 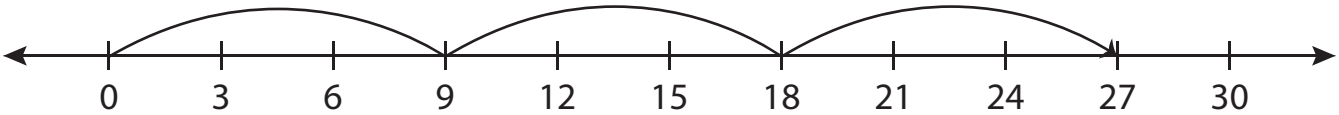

a) $3 \times 9 = 27$ b) $3 \times 3 = 9$ c) $3 \times 7 = 21$ d) $9 \times 9 = 81$

PREVIEW

Access the largest collection of worksheets for just $19.95 per year!

Members, please log in to download this worksheet.

Log in

Not a member? Please sign up to gain complete access.

Sign up

www.mathworksheets4kids.com

Name : _____ Score : _____

Answer key

Number Line Multiplication - MCQ

Sheet 3

Identify the correct multiplication sentence for each number line.

1)

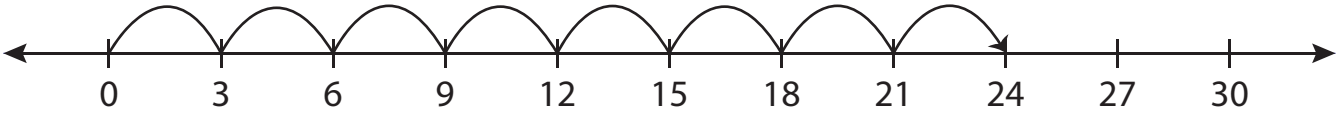

a) $6 \times 4 = 24$ b) $8 \times 3 = 24$ c) $4 \times 3 = 12$ d) $6 \times 5 = 30$

2)

a) $6 \times 3 = 18$ d) $6 \times 6 = 36$

3)

a) $10 \times 5 = 50$ d) $7 \times 9 = 63$

4)

a) $2 \times 4 = 8$ d) $4 \times 1 = 4$

5)

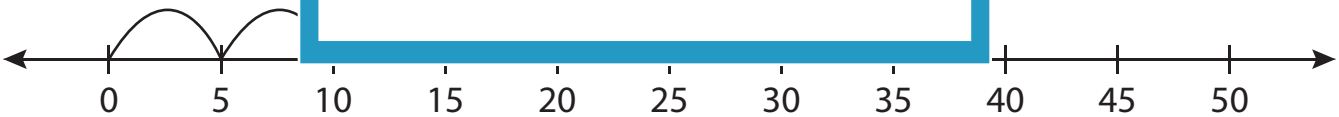

a) $2 \times 10 = 20$ b) $4 \times 5 = 20$ c) $20 \times 1 = 20$ d) $2 \times 15 = 30$

6)

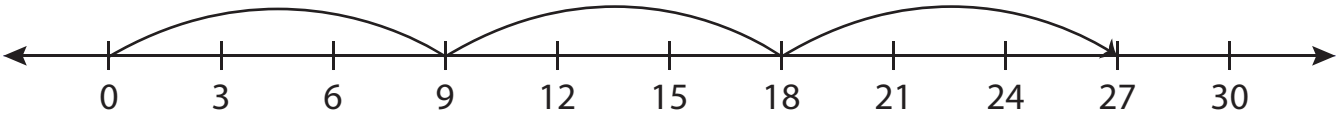

a) $3 \times 9 = 27$ b) $3 \times 3 = 9$ c) $3 \times 7 = 21$ d) $9 \times 9 = 81$

PREVIEW

Access the largest collection of worksheets for just $19.95 per year!

Members, please log in to download this worksheet.

Log in

Not a member? Please sign up to gain complete access.

Sign up

www.mathworksheets4kids.com

Name : _____ Score : _____

Number Line Multiplication - MCQ

Sheet 4

Identify the correct multiplication sentence for each number line.

1) 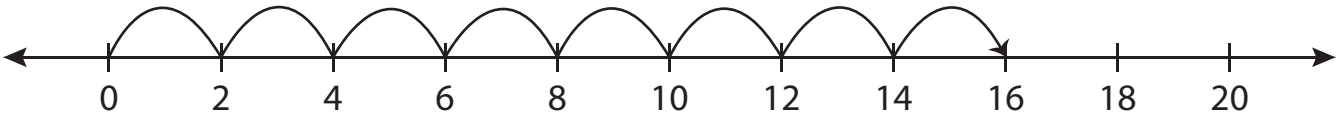

a) $8 \times 2 = 16$ b) $8 \times 4 = 32$ c) $4 \times 4 = 16$ d) $4 \times 5 = 20$

2)

a) $3 \times 27 = 81$ d) $2 \times 9 = 18$

3)

a) $6 \times 3 = 18$ d) $2 \times 3 = 6$

4)

a) $2 \times 9 = 18$ d) $2 \times 7 = 14$

5) 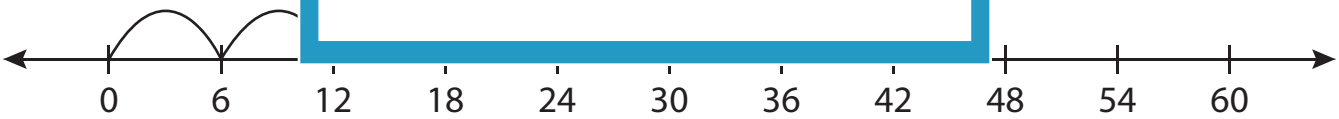

a) $3 \times 14 = 42$ b) $21 \times 2 = 42$ c) $7 \times 6 = 42$ d) $7 \times 4 = 28$

6) 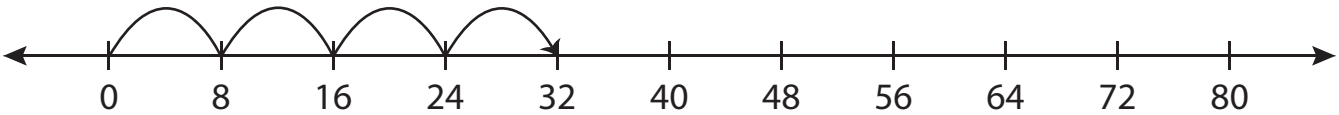

a) $3 \times 8 = 24$ b) $4 \times 8 = 32$ c) $16 \times 2 = 32$ d) $4 \times 2 = 8$

PREVIEW

Access the largest collection of worksheets for just $19.95 per year!

Members, please log in to download this worksheet.

Log in

Not a member? Please sign up to gain complete access.

Sign up

www.mathworksheets4kids.com

Name : _____ Score : _____

Answer key

Number Line Multiplication - MCQ

Sheet 4

Identify the correct multiplication sentence for each number line.

1)

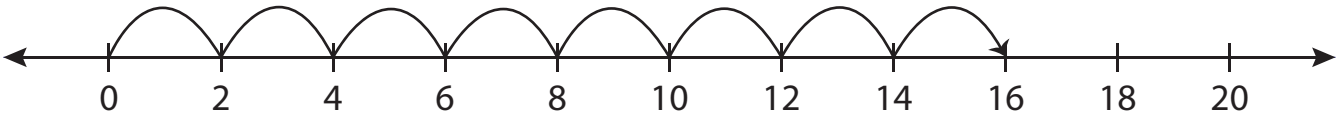

a) $8 \times 2 = 16$ b) $8 \times 4 = 32$ c) $4 \times 4 = 16$ d) $4 \times 5 = 20$

2)

a) $3 \times 27 = 81$ d) $2 \times 9 = 18$

3)

a) $6 \times 3 = 18$ d) $2 \times 3 = 6$

4)

a) $2 \times 9 = 18$ d) $2 \times 7 = 14$

5)

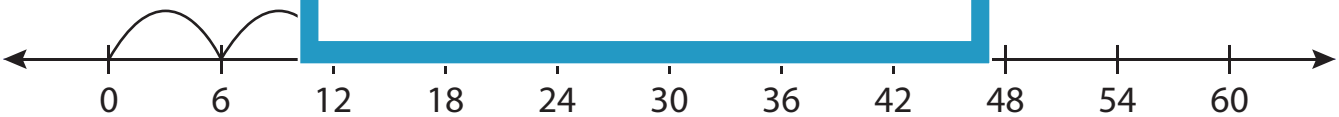

a) $3 \times 14 = 42$ b) $21 \times 2 = 42$ c) $7 \times 6 = 42$ d) $7 \times 4 = 28$

6)

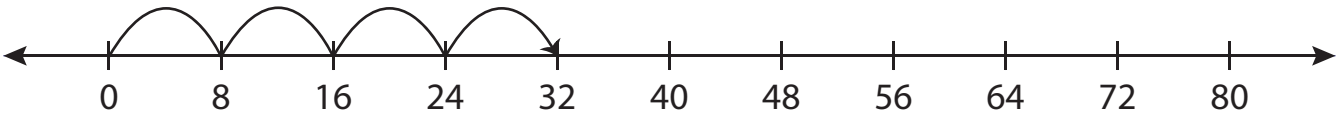

a) $3 \times 8 = 24$ b) $4 \times 8 = 32$ c) $16 \times 2 = 32$ d) $4 \times 2 = 8$

PREVIEW

Access the largest collection of worksheets for just $19.95 per year!

Members, please log in to download this worksheet.

Log in

Not a member? Please sign up to gain complete access.

Sign up

www.mathworksheets4kids.com

Name : _____ Score : _____

Number Line Multiplication - MCQ

Sheet 5

Identify the correct multiplication sentence for each number line.

1) 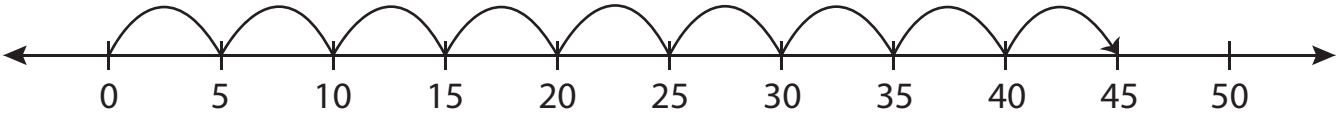

a) $9 \times 5 = 45$ b) $3 \times 15 = 45$ c) $9 \times 4 = 36$ d) $10 \times 5 = 50$

2)

a) $8 \times 2 = 16$ d) $4 \times 4 = 16$

3)

a) $12 \times 4 = 48$ d) $2 \times 24 = 48$

4)

a) $7 \times 2 = 14$ d) $9 \times 2 = 18$

5)

a) $9 \times 2 = 18$ b) $2 \times 5 = 10$ c) $10 \times 2 = 20$ d) $10 \times 1 = 10$

6) 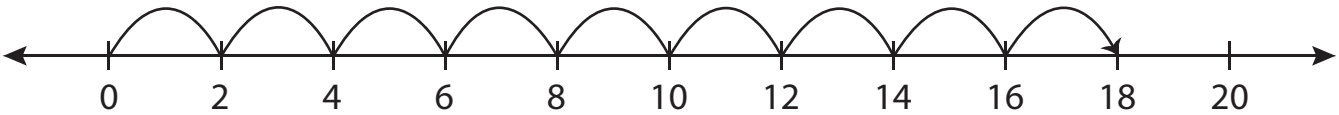

a) $3 \times 6 = 18$ b) $8 \times 2 = 16$ c) $2 \times 6 = 12$ d) $9 \times 2 = 18$

PREVIEW

Access the largest collection of worksheets for just $19.95 per year!

Members, please log in to download this worksheet.

Log in

Not a member? Please sign up to gain complete access.

Sign up

www.mathworksheets4kids.com

Name : _____ Score : _____

Answer key

Number Line Multiplication - MCQ

Sheet 5

Identify the correct multiplication sentence for each number line.

1)

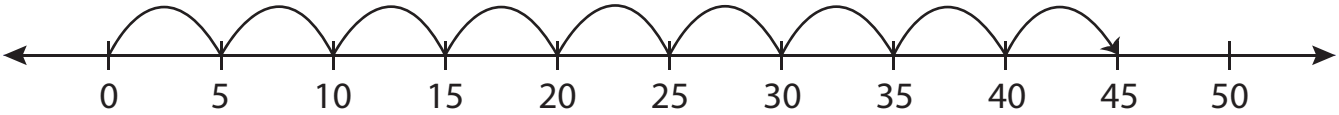

a) $9 \times 5 = 45$ b) $3 \times 15 = 45$ c) $9 \times 4 = 36$ d) $10 \times 5 = 50$

2)

a) $8 \times 2 = 16$ d) $4 \times 4 = 16$

3)

a) $12 \times 4 = 48$ d) $2 \times 24 = 48$

4)

a) $7 \times 2 = 14$ d) $9 \times 2 = 18$

5)

a) $9 \times 2 = 18$ b) $2 \times 5 = 10$ c) $10 \times 2 = 20$ d) $10 \times 1 = 10$

6)

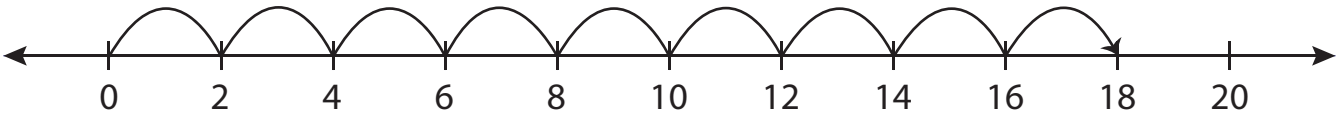

a) $3 \times 6 = 18$ b) $8 \times 2 = 16$ c) $2 \times 6 = 12$ d) $9 \times 2 = 18$

PREVIEW

Access the largest collection of worksheets for just $19.95 per year!

Members, please log in to download this worksheet.

Log in

Not a member? Please sign up to gain complete access.

Sign up

www.mathworksheets4kids.com