Name : _____

Pythagorean Theorem

Sheet 1

Determine the missing length in each right triangle using the Pythagorean theorem. Round the answer to the nearest tenth.

1)

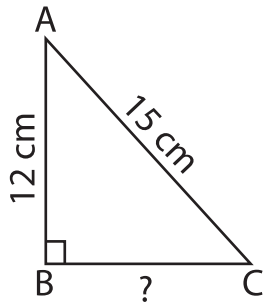

BC = _____

2)

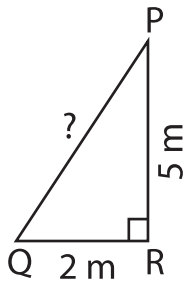

PQ = _____

3)

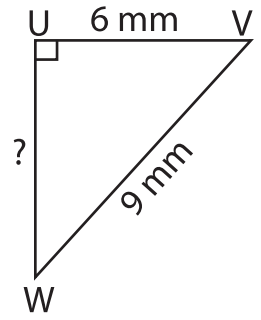

UW = _____

4)

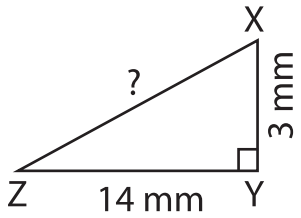

XZ = _____

5)

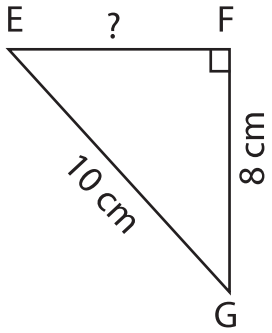

EF = _____

6)

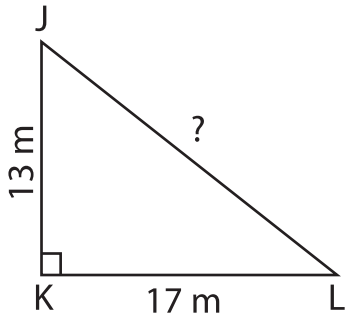

JL = _____

7)

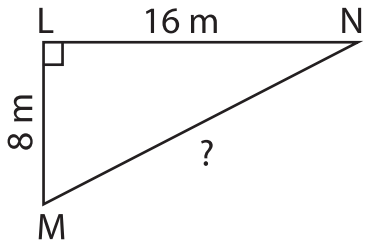

MN = _____

8)

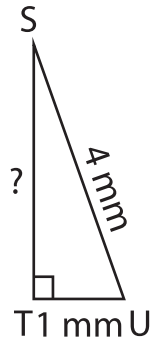

ST = _____

9)

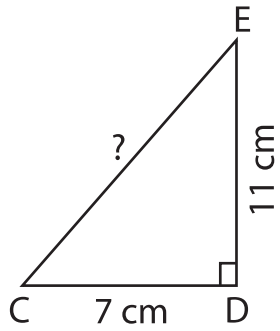

CE = _____