Name : _____

Quadrilateral-Area

L1DS2

Find the area of each shape. Round the answer to 2 decimal places.

1)

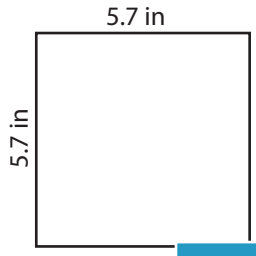

Area = _____

2)

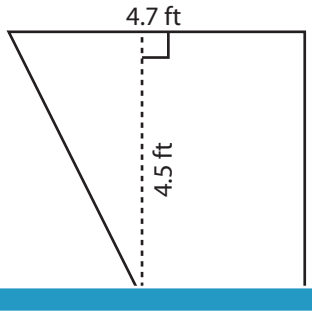

3)

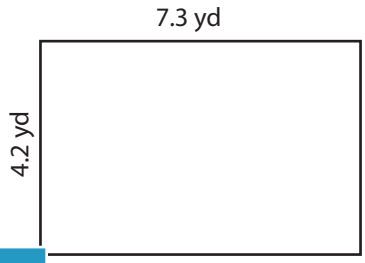

Area = _____

4)

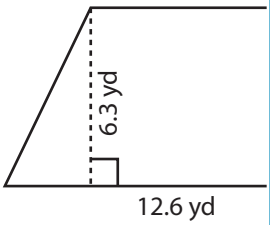

Area = _____

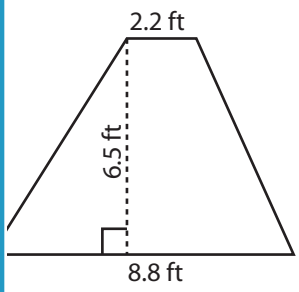

Area = _____

7)

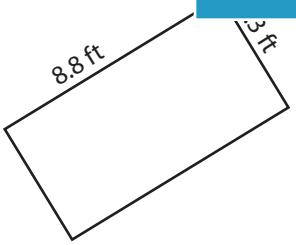

Area = _____

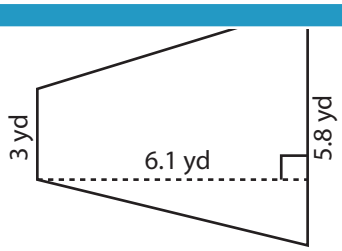

Area = _____



Area = _____

PREVIEW

Access the largest collection of worksheets for just $19.95 per year!

Members, please log in to download this worksheet.

Log in

Not a member? Please sign up to gain complete access.

Sign up

www.mathworksheets4kids.com

Name : _____

Answer key

Quadrilateral-Area

L1DS2

Find the area of each shape. Round the answer to 2 decimal places.

1)

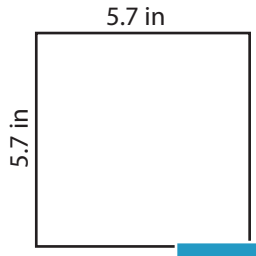

Area = **32.49 i**

2)

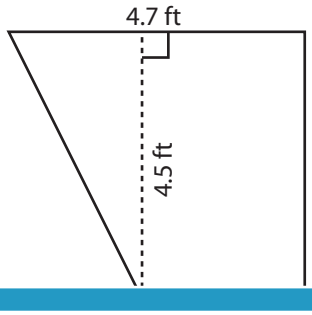

3)

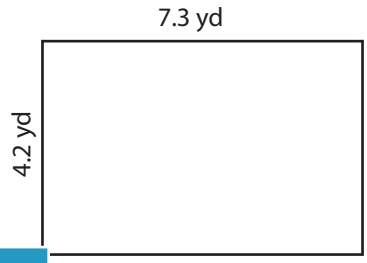

rea = **30.66 yd²**

4)

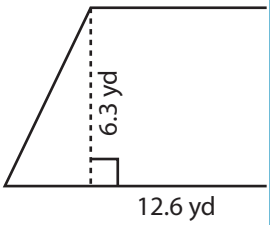

Area = **79.38 y**

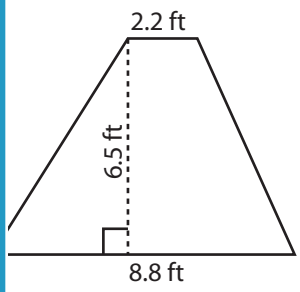

rea = **35.75 ft²**

PREVIEW

Access the largest collection of worksheets for just $19.95 per year!

Members, please log in to download this worksheet.

Log in

Not a member? Please sign up to gain complete access.

Sign up

www.mathworksheets4kids.com

7)

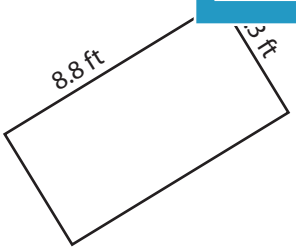

Area = **29.04 ft²**

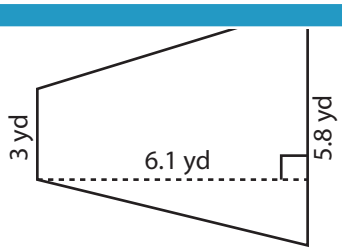

Area = **26.84 yd²**



Area = **70.56 in²**