Name : _____

MS1

Parallelogram - Area

Find the area of each parallelogram.

1)

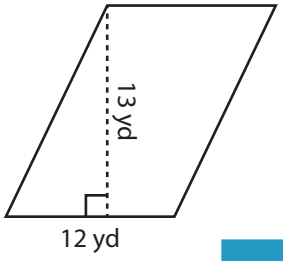

Area = _____

2)

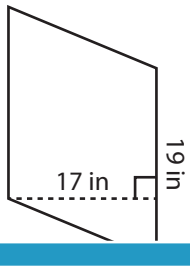

3)

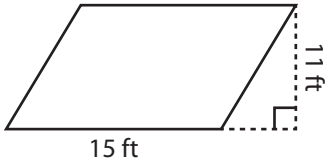

Area = _____

4)

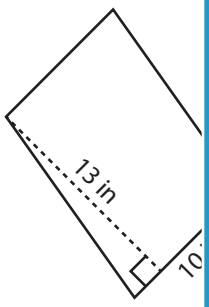

Area = _____

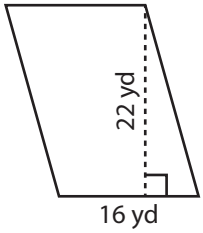

Area = _____

PREVIEW

Access the largest collection of worksheets for just $19.95 per year!

Members, please log in to download this worksheet.

Log in

Not a member? Please sign up to gain complete access.

Sign up

www.mathworksheets4kids.com

7)

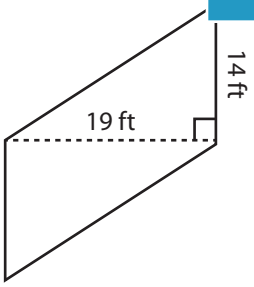

Area = _____

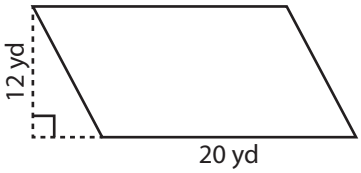

Area = _____

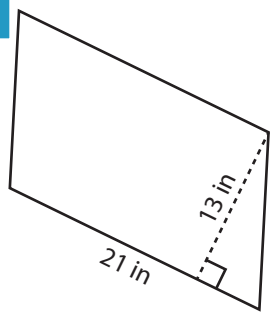

Area = _____

Name : _____

Answer key

MS1

Parallelogram - Area

Find the area of each parallelogram.

1)

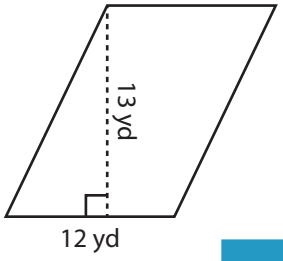

Area = **156 y**

2)

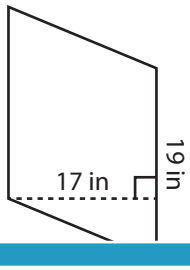

3)

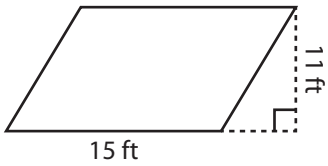

rea = **165 ft²**

4)

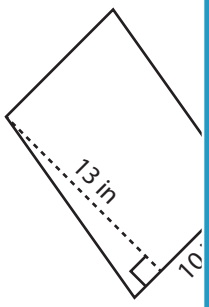

Area = **130 i**

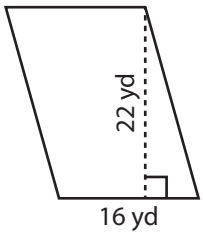

rea = **352 yd²**

7)

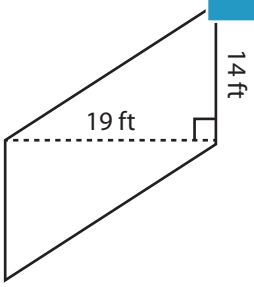

Area = **266 ft²**

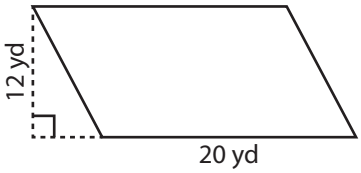

Area = **240 yd²**

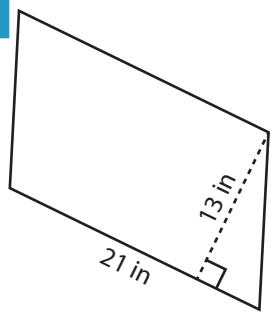

Area = **273 in²**

PREVIEW

Access the largest collection of worksheets for just **$19.95** per year!

Members, please log in to download this worksheet.

Log in

Not a member? Please sign up to gain complete access.

Sign up

www.mathworksheets4kids.com

Name : _____

MS2

Parallelogram - Area

Find the area of each parallelogram.

1)

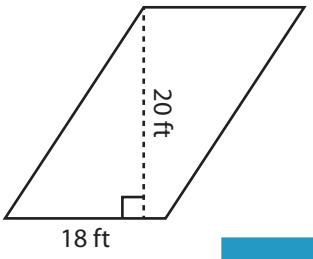

Area = _____

2)

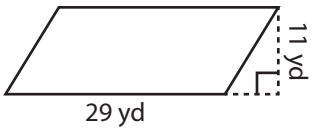

3)

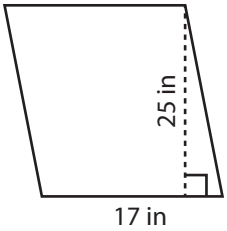

rea = _____

4)

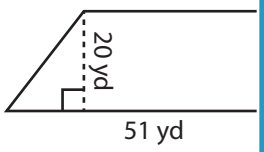

Area = _____

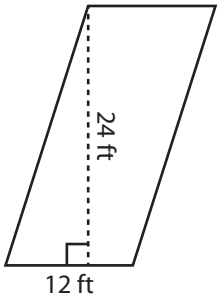

rea = _____

PREVIEW

Access the largest collection of worksheets for just $19.95 per year!

Members, please log in to download this worksheet.

Log in

Not a member? Please sign up to gain complete access.

Sign up

www.mathworksheets4kids.com

7)

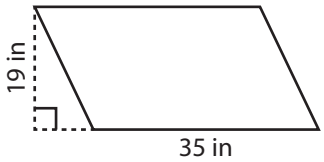

Area = _____

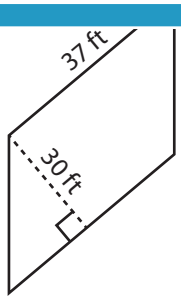

Area = _____

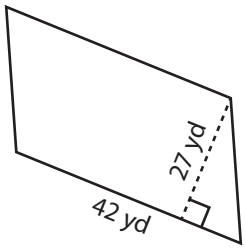

Area = _____

Name : _____

Answer key

MS2

Parallelogram - Area

Find the area of each parallelogram.

1)

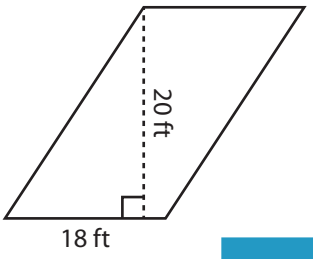

Area = 360 f

2)

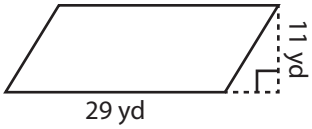

3)

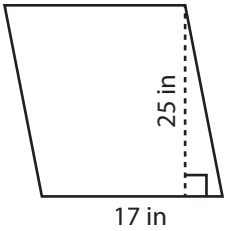

rea = 425 in²

4)

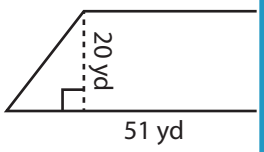

Area = 1020 y

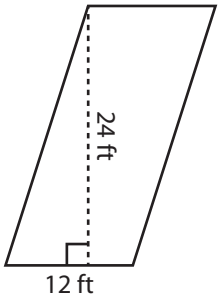

rea = 288 ft²

7)

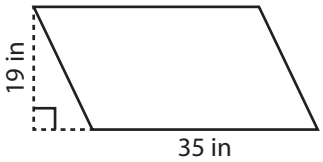

Area = 665 in²

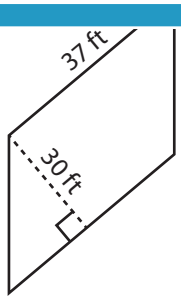

Area = 1110 ft²

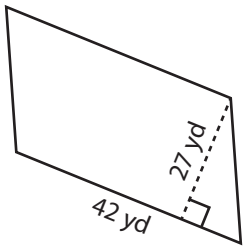

Area = 1134 yd²

PREVIEW

Access the largest collection of worksheets for just $19.95 per year!

Members, please log in to download this worksheet.

Log in

Not a member? Please sign up to gain complete access.

Sign up

www.mathworksheets4kids.com

Name : _____

MS3

Parallelogram - Area

Find the area of each parallelogram.

1)

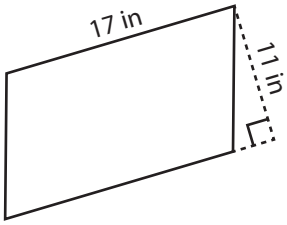

Area = _____

2)

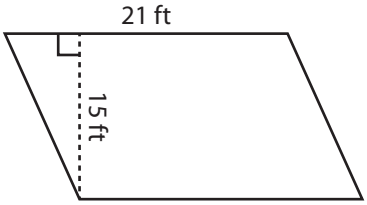

3)

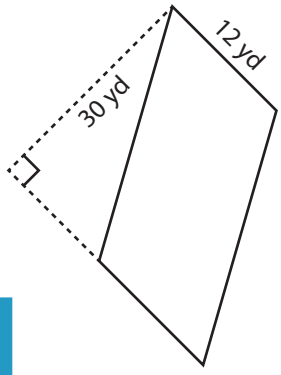

Area = _____

PREVIEW

Access the largest collection of worksheets for just $19.95 per year!

Members, please log in to download this worksheet.

Log in

Not a member? Please sign up to gain complete access.

Sign up

www.mathworksheets4kids.com

4)

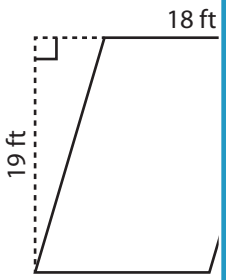

Area = _____

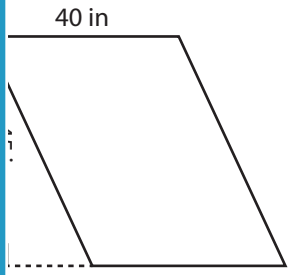

Area = _____

7)

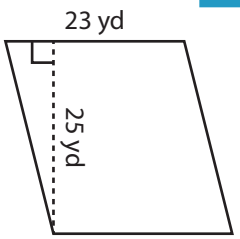

Area = _____

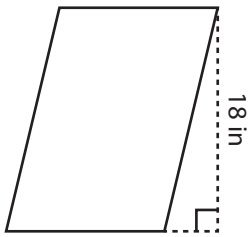

Area = _____

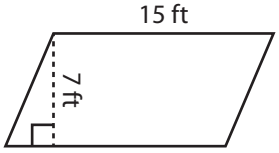

Area = _____

Name : _____

Answer key

MS3

Parallelogram - Area

Find the area of each parallelogram.

1)

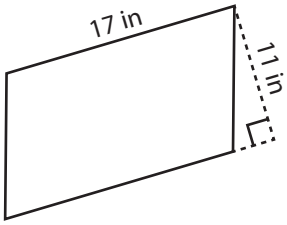

Area = **187 i**

2)

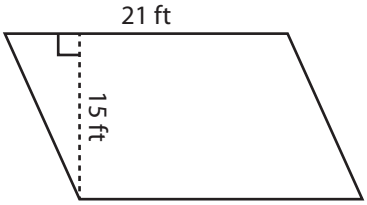

3)

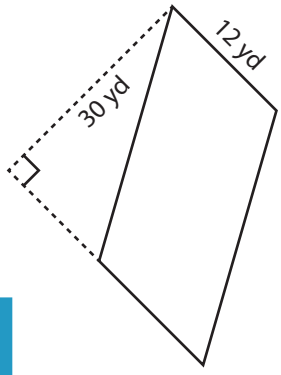

rea = **360 yd²**

4)

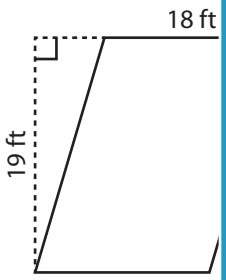

Area = **342 f**

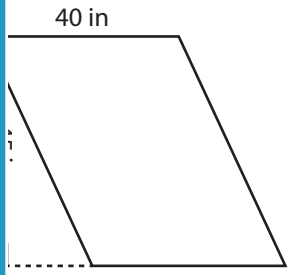

rea = **1800 in²**

7)

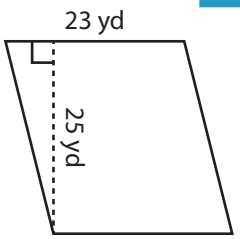

Area = **575 yd²**

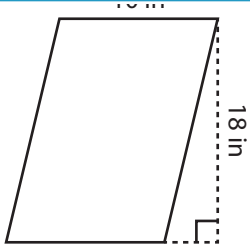

Area = **180 in²**

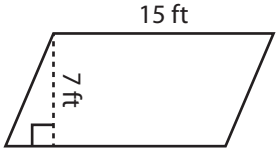

Area = **105 ft²**

PREVIEW

Access the largest collection of worksheets for just **$19.95** per year!

Members, please log in to download this worksheet.

Log in

Not a member? Please sign up to gain complete access.

Sign up

www.mathworksheets4kids.com