Name: _____ Score: _____

Reading Thermometers

Sheet 1

Write the temperature shown on each thermometer:

1)

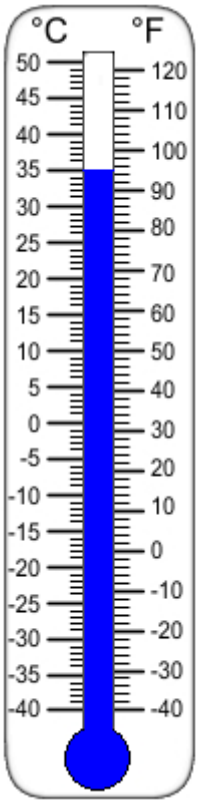

_____ °C

2)



_____ °C

3)

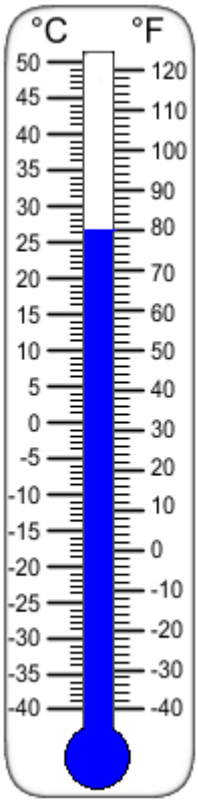

_____ °F

4)

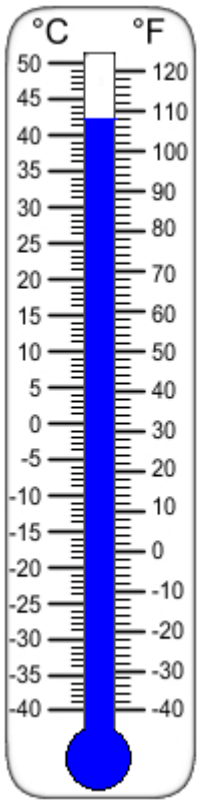

_____ °F

5)



_____ °C

6)

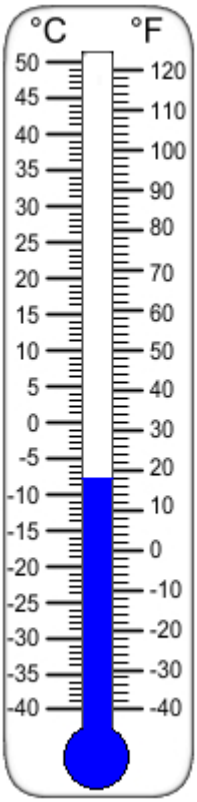

_____ °F

7)

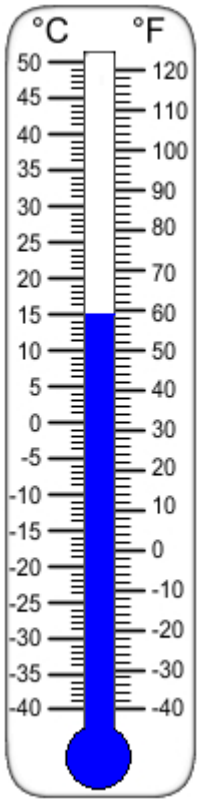

_____ °C

8)

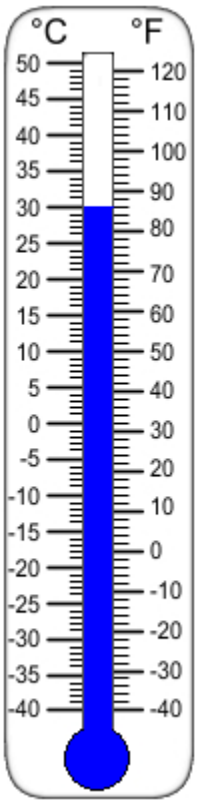

_____ °F

Name: _____ Score: _____

Answer key

Reading Thermometers

Sheet 1

Write the temperature shown on each thermometer:

1)

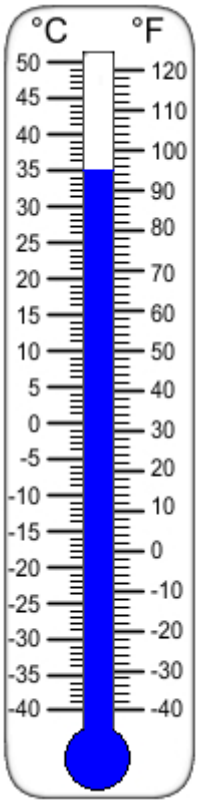

35 °C

2)



—12 °C

3)

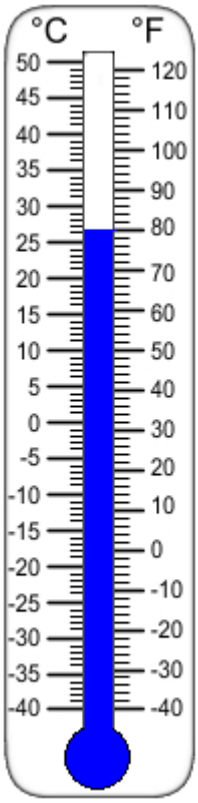

80 °F

4)

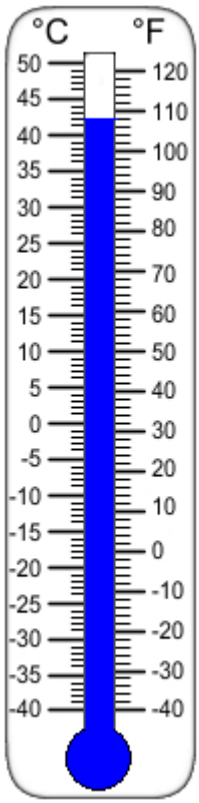

108 °F

5)



—28 °C

6)

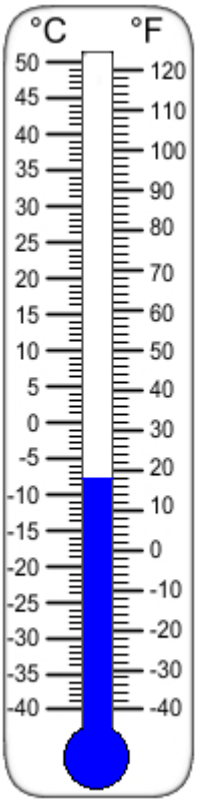

18 °F

7)

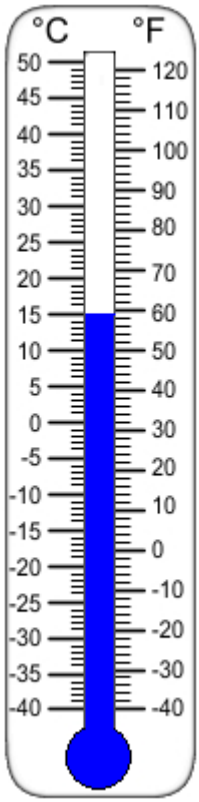

15 °C

8)

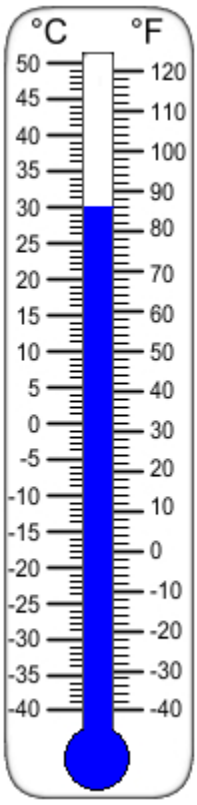

86 °F

Name: _____ Score: _____

Reading Thermometers

Sheet 2

Write the temperature shown on each thermometer:

1)



_____ °F

2)

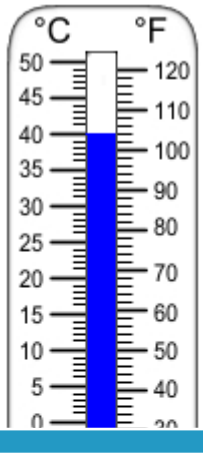

3)



4)



_____ °C

5)

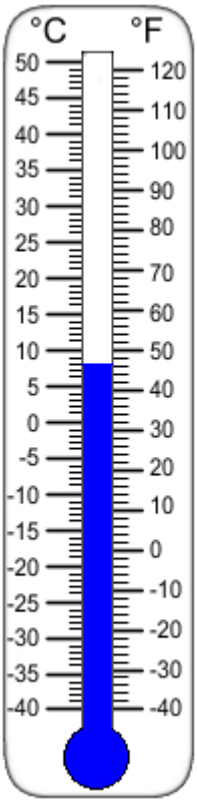

_____ °C

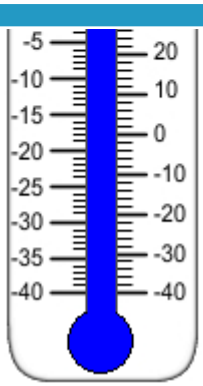

_____ °F

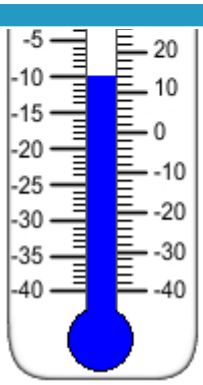

_____ °C

8)

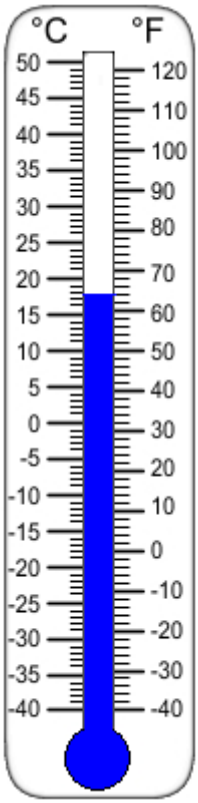

_____ °F

PREVIEW

Access the largest collection of worksheets for just $19.95 per year!

Members, please log in to download this worksheet.

Log in

Not a member? Please sign up to gain complete access.

Sign up

www.mathworksheets4kids.com

Name: _____ Score: _____

Answer key

Reading Thermometers

Sheet 2

Write the temperature shown on each thermometer:

1)



—10 °F

2)

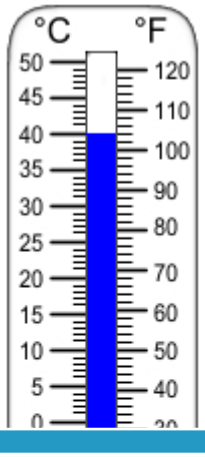

3)



4)



-18 °C

5)

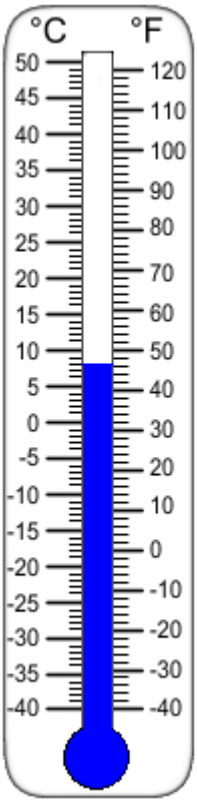

8 °C

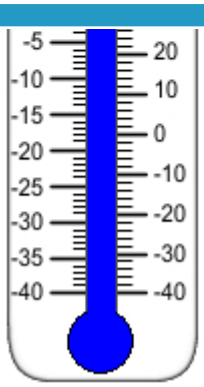

120 °F

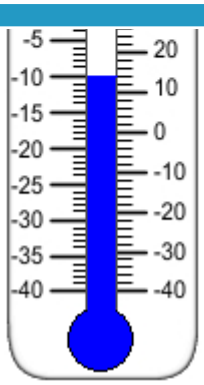

—10 °C

8)

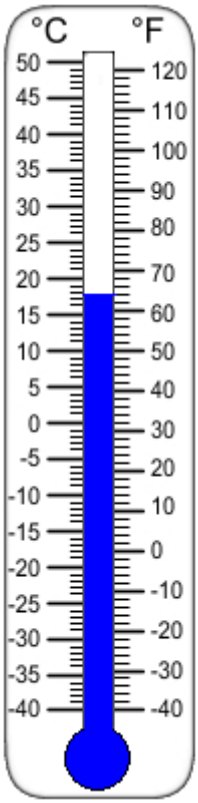

64 °F

PREVIEW

Access the largest collection of worksheets for just $19.95 per year!

Members, please log in to download this worksheet.

Log in

Not a member? Please sign up to gain complete access.

Sign up

www.mathworksheets4kids.com

Name: _____ Score: _____

Reading Thermometers

Sheet 3

Write the temperature shown on each thermometer:

1)

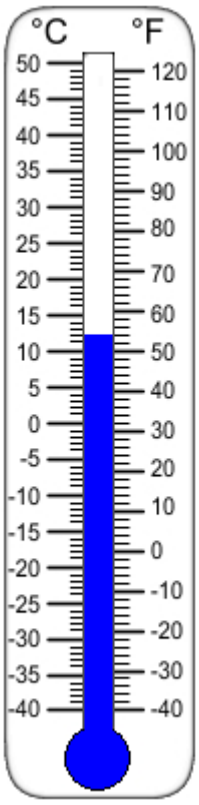

_____ °C

2)

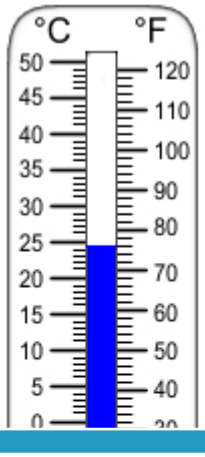

3)



4)

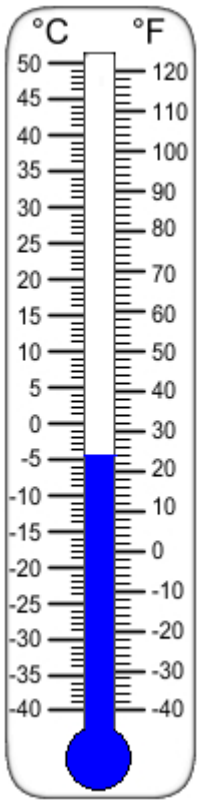

_____ °F

5)

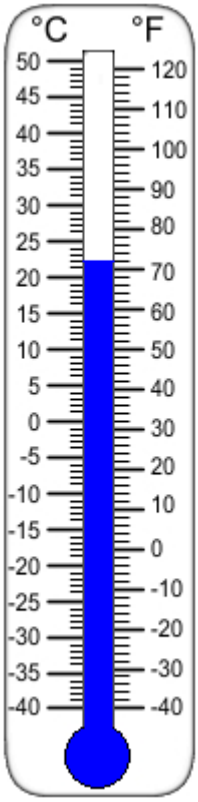

_____ °F

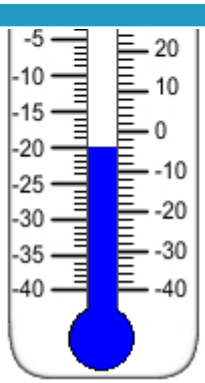

_____ °C

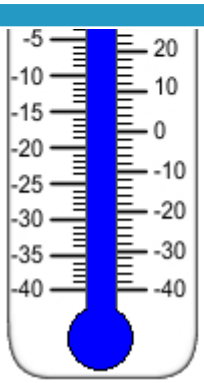

_____ °F

8)



_____ °C

PREVIEW

Access the largest collection of worksheets for just $19.95 per year!

Members, please log in to download this worksheet.

Log in

Not a member? Please sign up to gain complete access.

Sign up

www.mathworksheets4kids.com

Name: _____ Score: _____

Answer key

Reading Thermometers

Sheet 3

Write the temperature shown on each thermometer:

1)

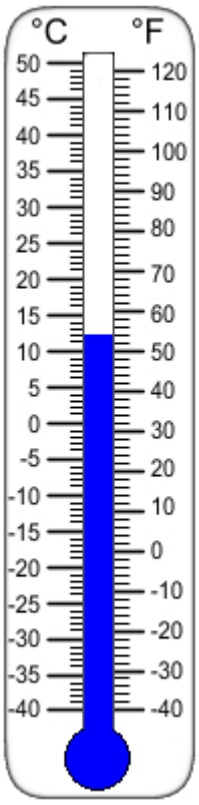

12 °C

2)

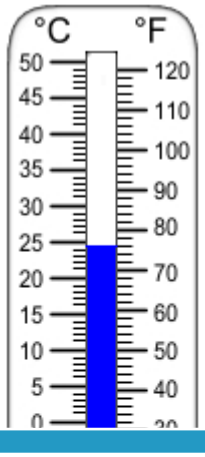

3)



4)

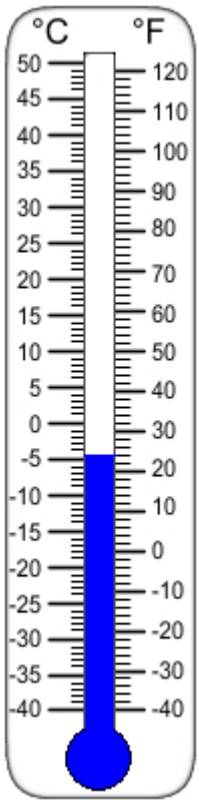

24 °F

PREVIEW

Access the largest collection of worksheets for just $19.95 per year!

Members, please log in to download this worksheet.

Log in

Not a member? Please sign up to gain complete access.

Sign up

www.mathworksheets4kids.com

5)

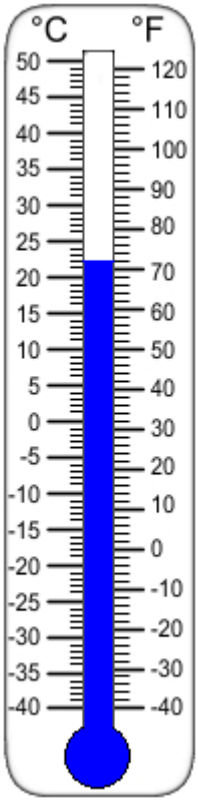

22 °C

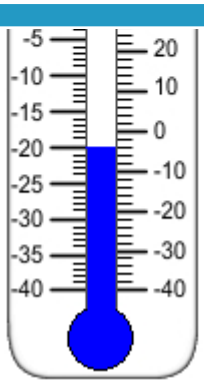

−4 °F

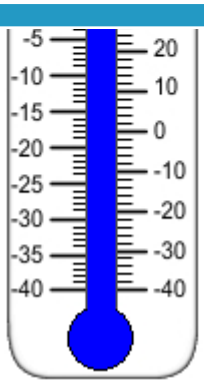

110 °F

8)



−32 °C