Name: _____ Score: _____

Drawing Hands - Half Hours

Sheet 3

Draw hands on each clock for the time given below:

1)

Time: **2:00**

2)

3)

7:30

4)

Time: **11:00**

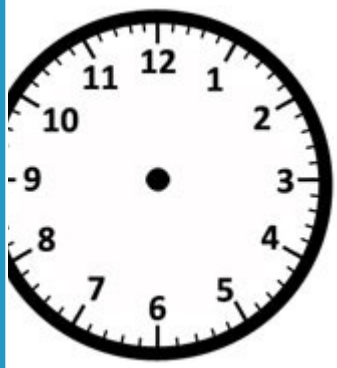

6:30

7) 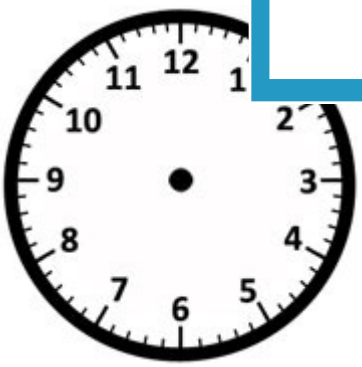

Time: **8:30**

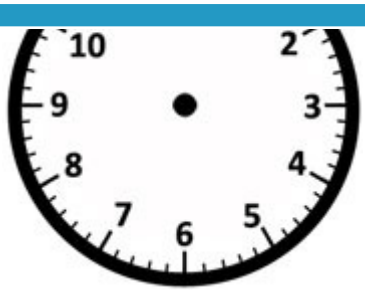

Time: **1:30**

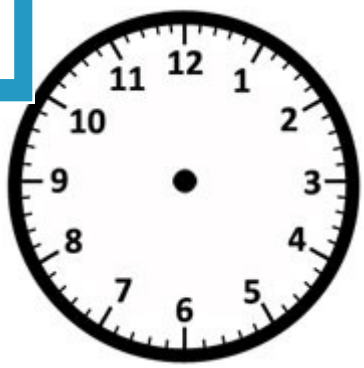

Time: **4:00**

PREVIEW

Access the largest collection of worksheets for just $19.95 per year!

Members, please log in to download this worksheet.

Log in

Not a member? Please sign up to gain complete access.

Sign up

www.mathworksheets4kids.com

Name: _____ Score: _____

Answer key

Drawing Hands - Half Hours

Sheet 3

Draw hands on each clock for the time given below:

1)

Time: **2:00**

2)

3)

7:30

4)

Time: **11:00**

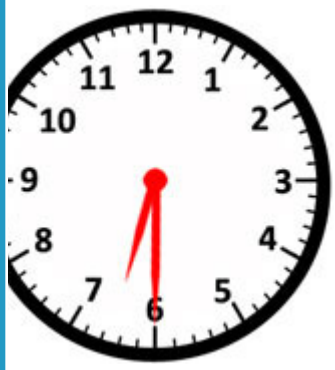

6:30

7)

Time: **8:30**

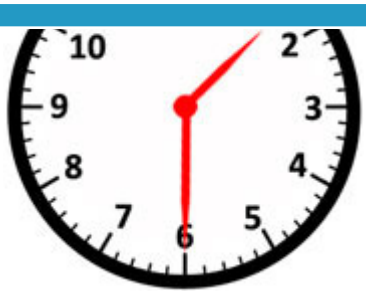

Time: **1:30**

Time: **4:00**

PREVIEW

Access the largest collection of worksheets for just $19.95 per year!

Members, please log in to download this worksheet.

Log in

Not a member? Please sign up to gain complete access.

Sign up

www.mathworksheets4kids.com