Name : _____ Score : _____

Sides & Angles: S1

Identifying Triangles

Identify each triangle based on both sides and angles.

1)

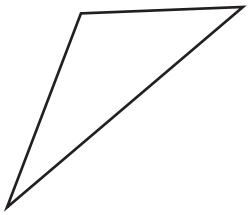

Scalene obtuse triangle

2)

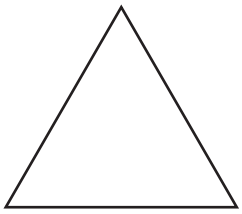

_____

3)

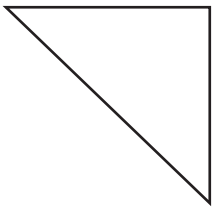

_____

4)

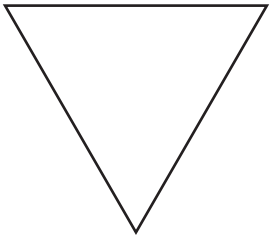

_____

5)

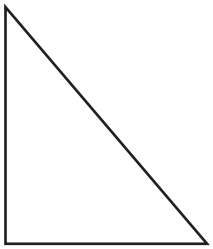

_____

6)



_____

7)

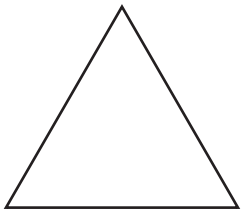

_____

8)

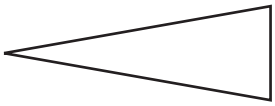

_____

9)

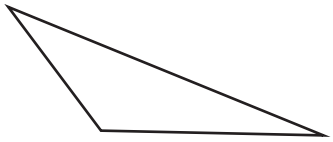

_____

10)

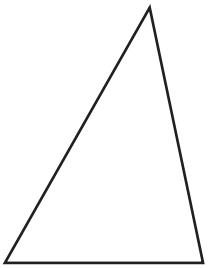

_____

11)



_____

12)

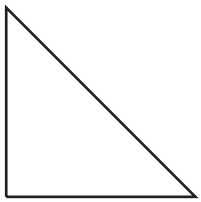

_____

Name : _____ Score : _____

Answer key

Sides & Angles: S1

Identifying Triangles

Identify each triangle based on both sides and angles.

1)

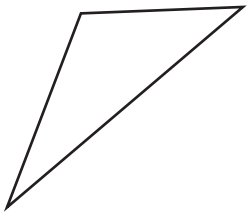

Scalene obtuse triangle

2)

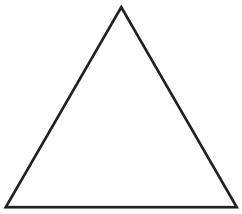

Equilateral acute triangle

3)

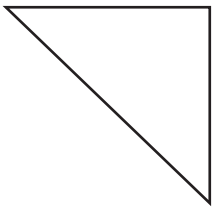

Isosceles right triangle

4)

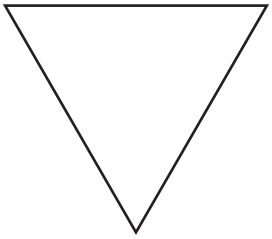

Equilateral acute triangle

5)

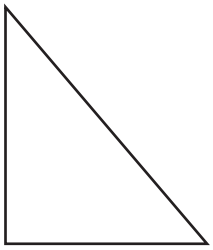

Scalene right triangle

6)



Isosceles acute triangle

7)

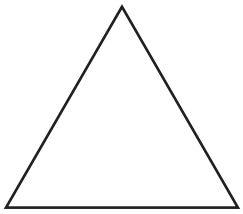

Equilateral acute triangle

8)

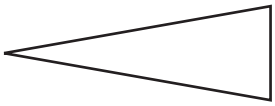

Isosceles acute triangle

9)

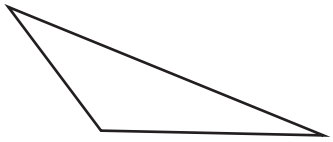

Scalene obtuse triangle

10)

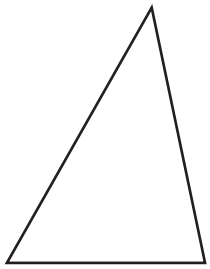

Scalene acute triangle

11)



Equilateral acute triangle

12)

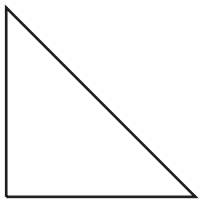

Isosceles right triangle

Name : _____ Score : _____

Sides & Angles: S2

Identifying Triangles

Identify each triangle based on both sides and angles.

1)

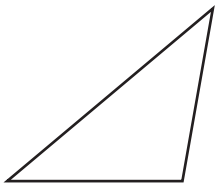

Isosceles obtuse triangle

2)

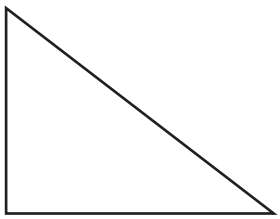

_____

3)

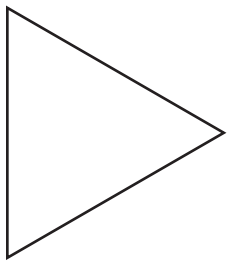

_____

4)

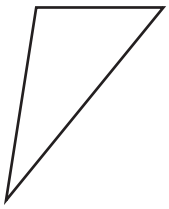

_____

5)

_____

6)

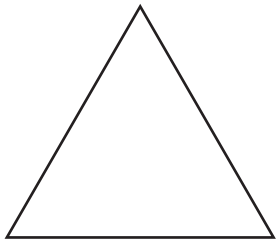

_____

7)

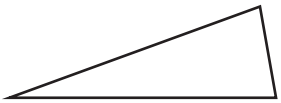

_____

8)

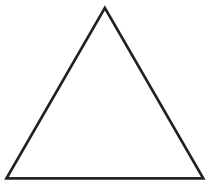

_____

9)

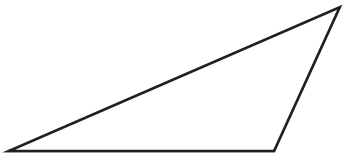

_____

10)

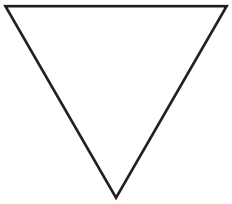

_____

11)

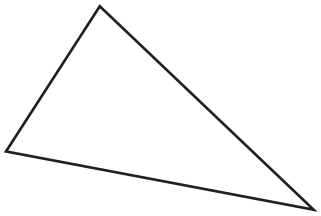

_____

12)

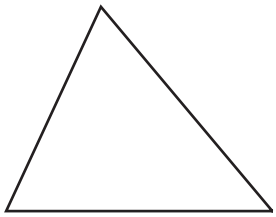

_____

Name : _____ Score : _____

Answer key

Sides & Angles: S2

Identifying Triangles

Identify each triangle based on both sides and angles.

1)

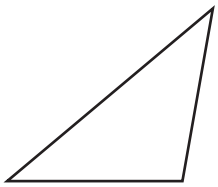

Isosceles obtuse triangle

2)

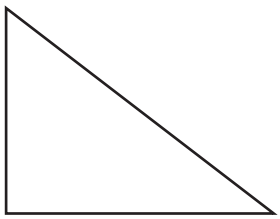

Scalene right triangle

3)

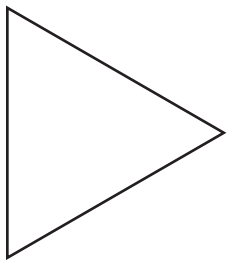

Equilateral acute triangle

4)

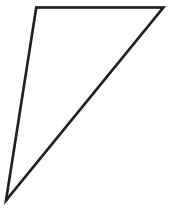

Scalene obtuse triangle

5)

Isosceles obtuse triangle

6)

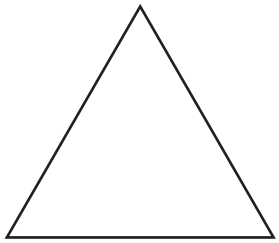

Equilateral acute triangle

7)

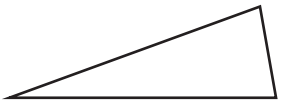

Isosceles acute triangle

8)

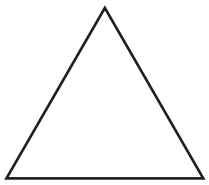

Equilateral acute triangle

9)

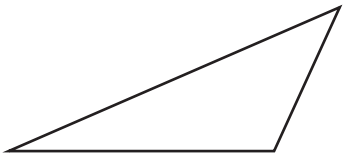

Scalene obtuse triangle

10)

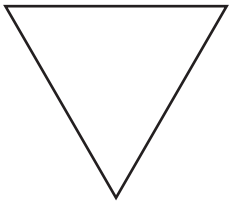

Equilateral acute triangle

11)

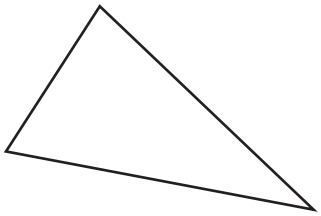

Scalene acute triangle

12)

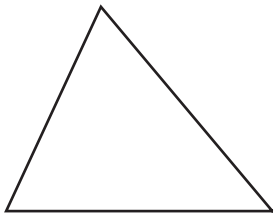

Isosceles acute triangle

Name : _____ Score : _____

Sides & Angles: S3

Identifying Triangles

Identify each triangle based on both sides and angles.

1) 

Equilateral acute triangle

2) 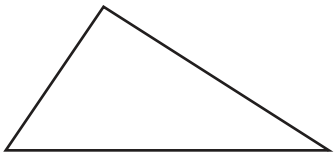

_____

3)

_____

4) 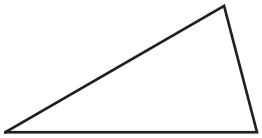

_____

5) 

_____

6) 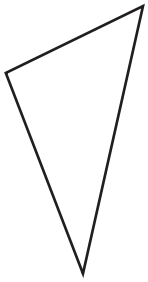

_____

7) 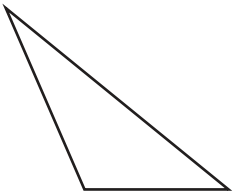

_____

8) 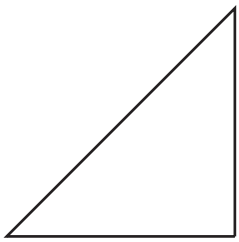

_____

9) 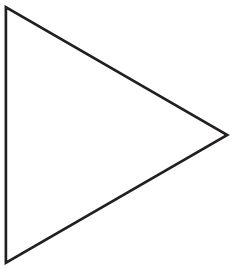

_____

10) 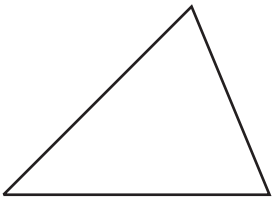

_____

11) 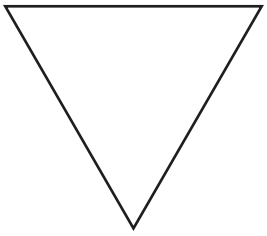

_____

12) 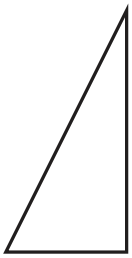

_____

Name : _____ Score : _____

Answer key

Sides & Angles: S3

Identifying Triangles

Identify each triangle based on both sides and angles.

1)



Equilateral acute triangle

2)

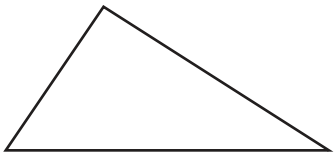

Scalene right triangle

3)

Isosceles acute triangle

4)

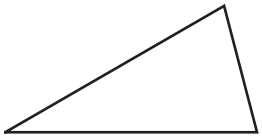

Isosceles acute triangle

5)



Equilateral acute triangle

6)

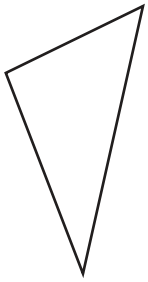

Scalene obtuse triangle

7)

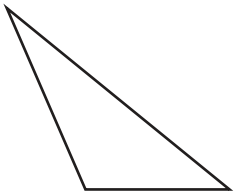

Scalene obtuse triangle

8)

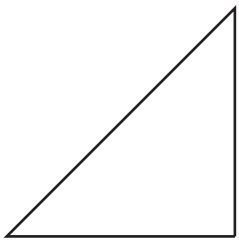

Isosceles right triangle

9)

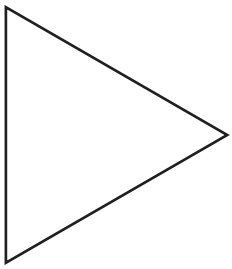

Equilateral acute triangle

10)

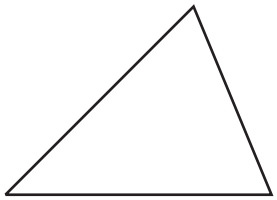

Isosceles acute triangle

11)

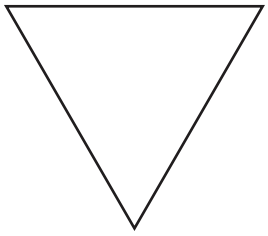

Equilateral acute triangle

12)

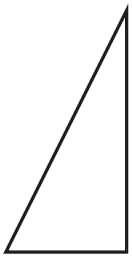

Scalene right triangle