Name : _____ Score : _____

# Shading - Venn Diagram

L2S1

Shade the given region.

1) $(A \cap C)'$

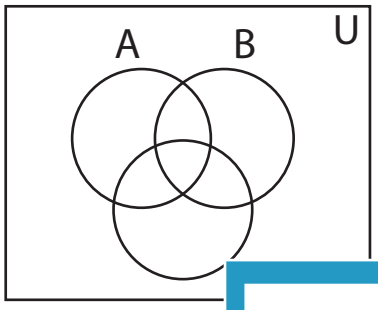


2) $C' - B'$

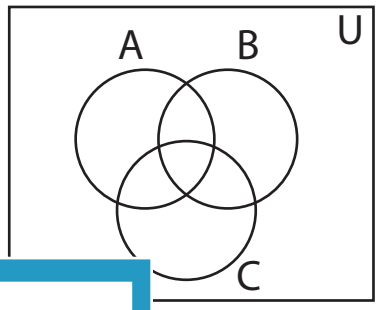


3) $B - C$

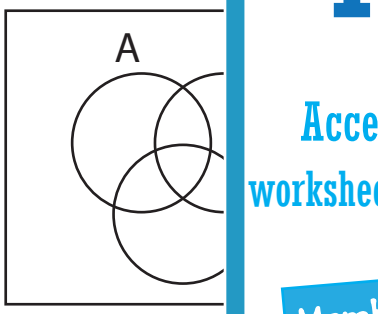


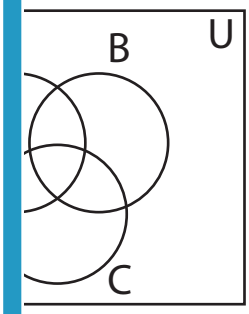


5) $B' - A$

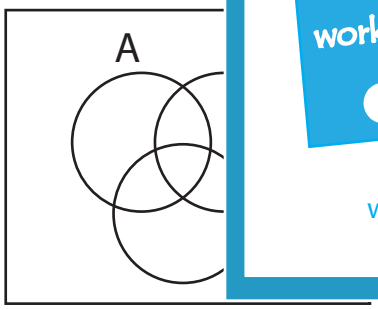


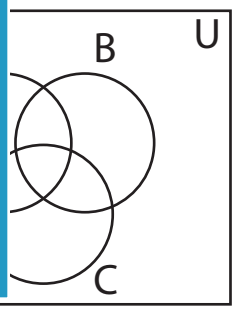


7) $A - B'$

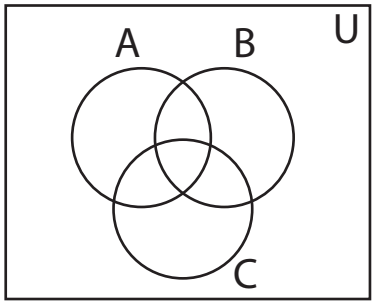


8) $B \cup C$

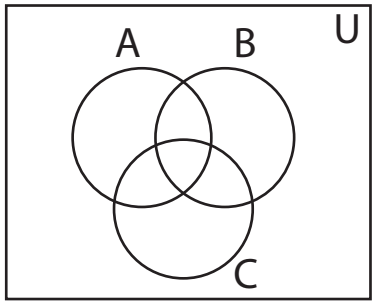


PREVIEW

Access the largest collection of worksheets for just $19.95 per year!

Members, please log in to download this worksheet.

Log in

Not a member? Please sign up to gain complete access.

Sign up

www.mathworksheets4kids.com

Name : _____ Score : _____

**Answer key**

# Shading - Venn Diagram

L2S1

Shade the given region.

1) $(A \cap C)'$

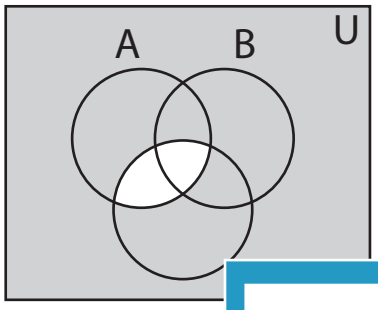


2) $C' - B'$

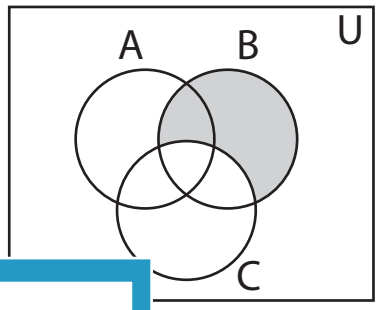


3) $B - C$

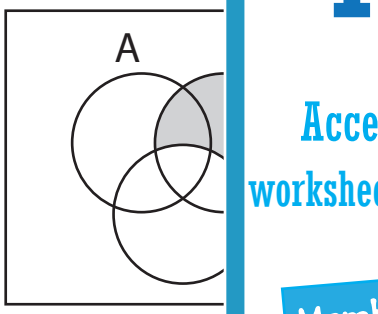


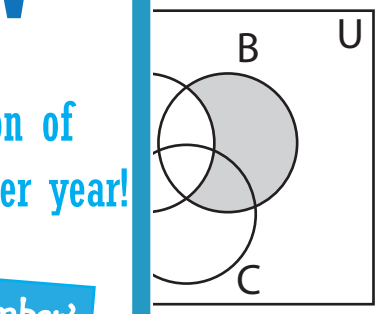


5) $B' - A$

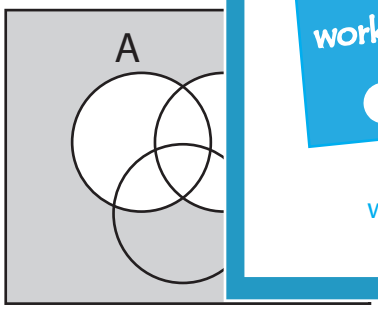


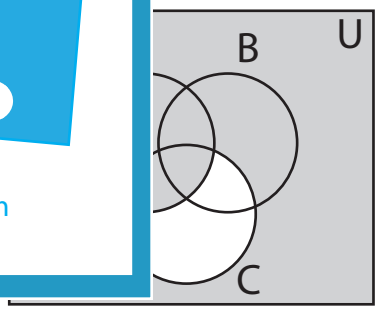


7) $A - B'$

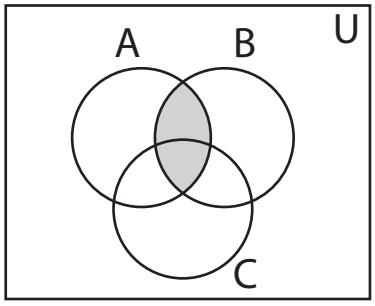


8) $B \cup C$

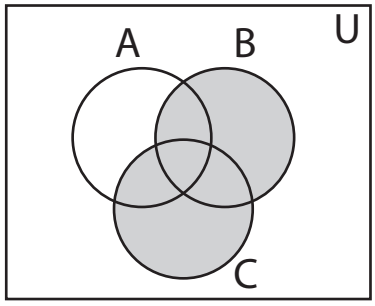



PREVIEW

Access the largest collection of worksheets for just $19.95 per year!

Members, please log in to download this worksheet.

Log in

Not a member? Please sign up to gain complete access.

Sign up

www.mathworksheets4kids.com

Name : _____ Score : _____

# Shading - Venn Diagram

L2S2

Shade the given region.

1) C – A′

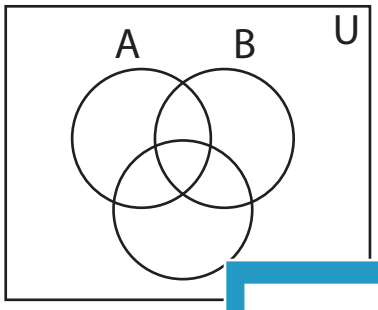


2) C′

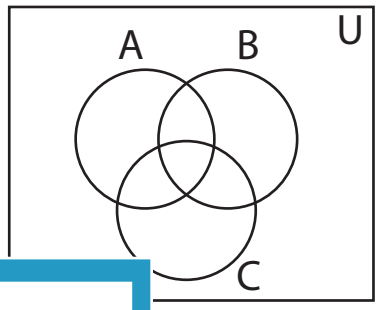


3) A′ – B

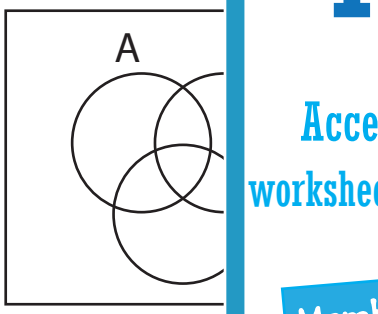


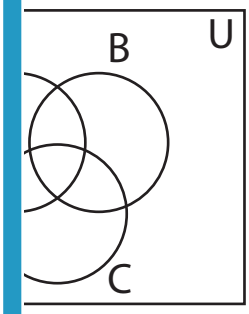


5) B′ ∩ C′

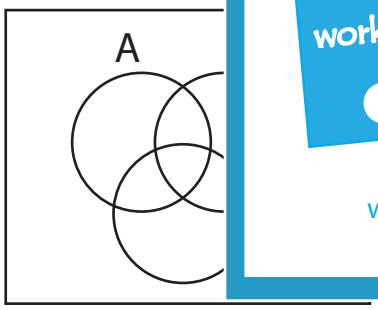


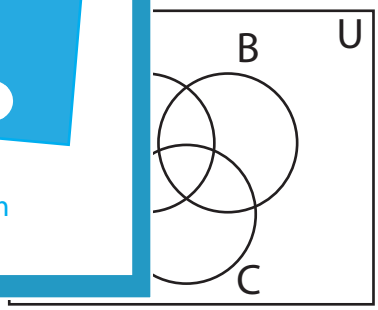


7) (C – B)′

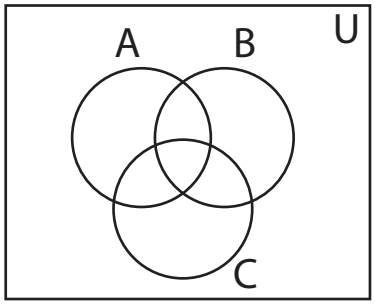


8) A ∪ B′

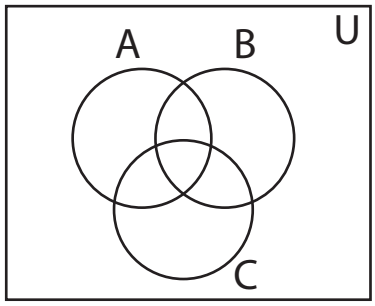


PREVIEW

Access the largest collection of worksheets for just $19.95 per year!

Members, please log in to download this worksheet.

Log in

Not a member? Please sign up to gain complete access.

Sign up

www.mathworksheets4kids.com

Name : _____ Score : _____

**Answer key**

# Shading - Venn Diagram

L2S2

Shade the given region.

1) C – A′

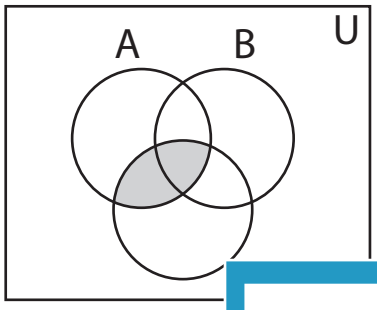


2) C′

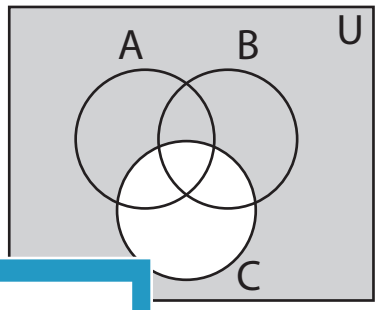


3) A′ – B

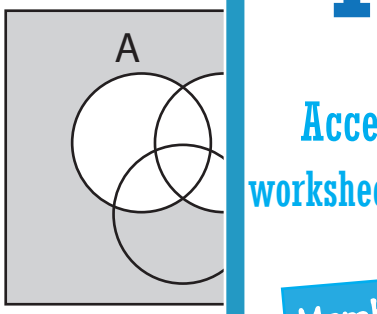


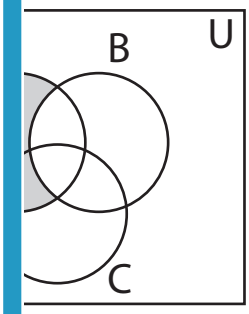


5) B′ ∩ C′

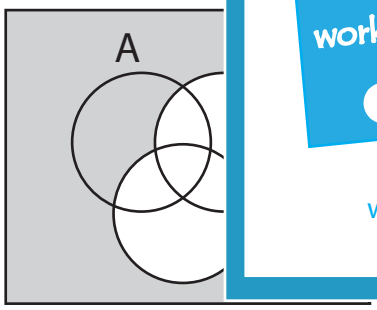


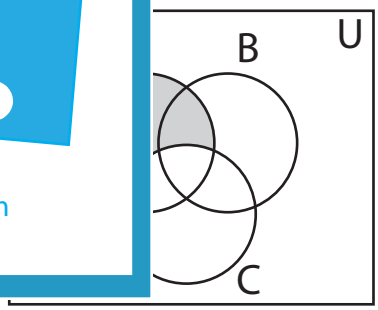


7) (C – B)′

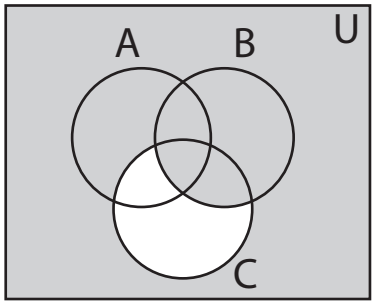


8) A U B′

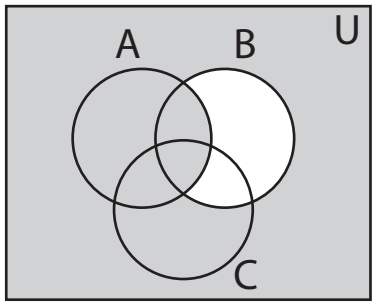



PREVIEW

Access the largest collection of worksheets for just $19.95 per year!

Members, please log in to download this worksheet.

Log in

Not a member? Please sign up to gain complete access.

Sign up

www.mathworksheets4kids.com

Name : _____ Score : _____

# Shading - Venn Diagram

L2S3

Shade the given region.

1) B – A

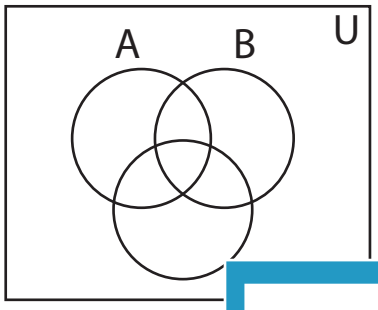


2) (A – B)′

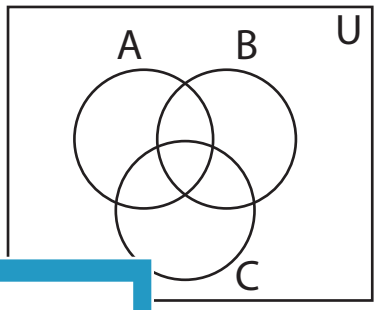


3) A′ U B′

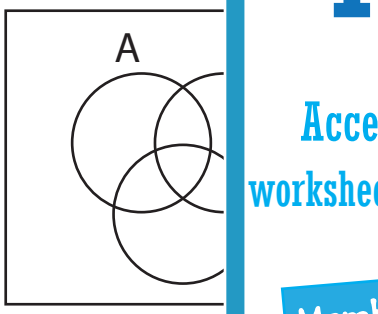


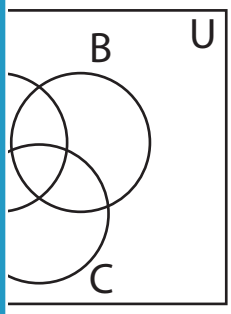


5) A – C′

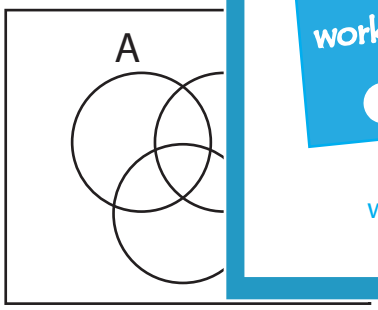


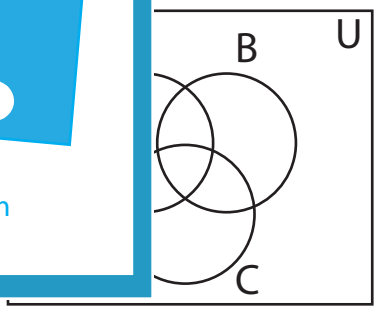



PREVIEW

Access the largest collection of worksheets for just $19.95 per year!

Members, please log in to download this worksheet.

Log in

Not a member? Please sign up to gain complete access.

Sign up

www.mathworksheets4kids.com


7) B

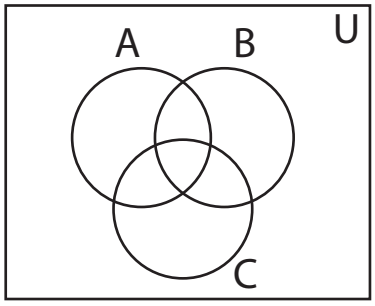


8) B′ – C

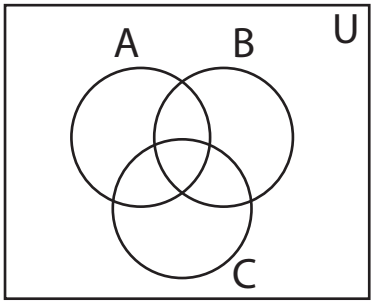

Name : _____ Score : _____

**Answer key**

# Shading - Venn Diagram

L2S3

Shade the given region.

1) B – A

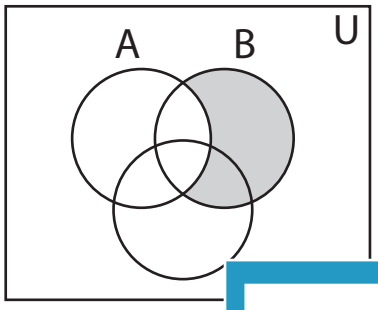


2) (A – B)′

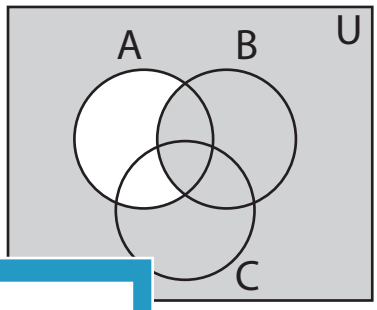


3) A′ U B′

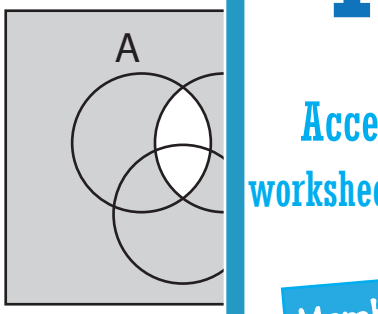


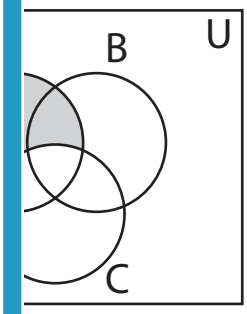


5) A – C′

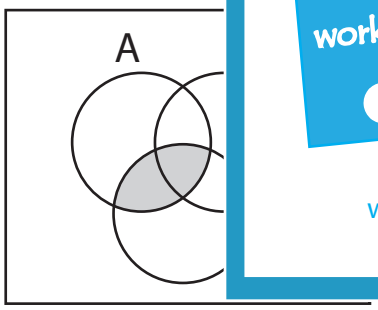


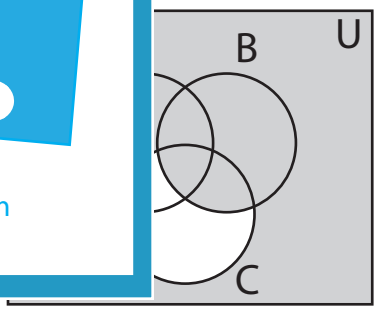


7) B

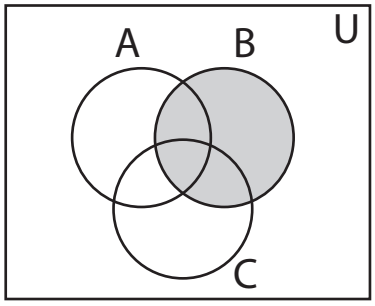


8) B′ – C

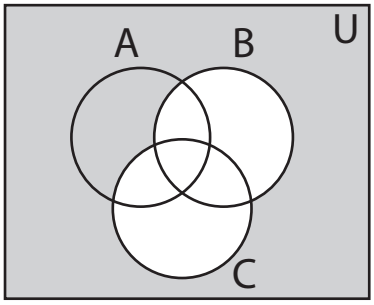



PREVIEW

Access the largest collection of worksheets for just $19.95 per year!

Members, please log in to download this worksheet.

Log in

Not a member? Please sign up to gain complete access.

Sign up

www.mathworksheets4kids.com

Name : _____ Score : _____

# Shading - Venn Diagram

L2S4

Shade the given region.

1) A′ U C

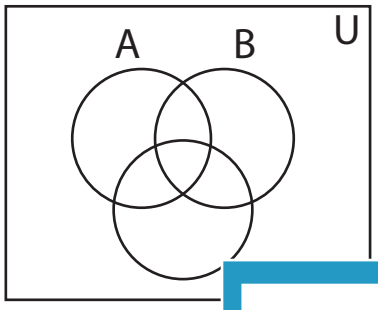


2) A′ – C′

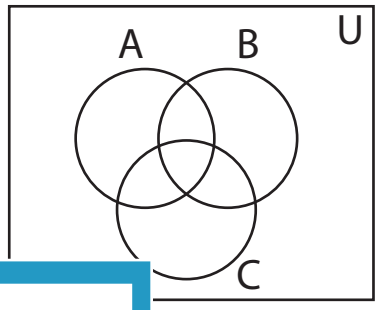


3) (B – C)′

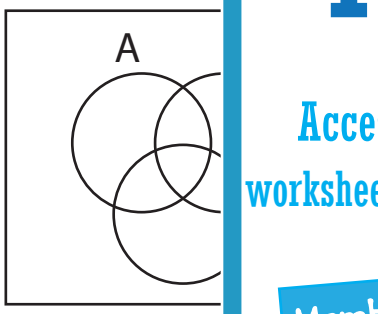


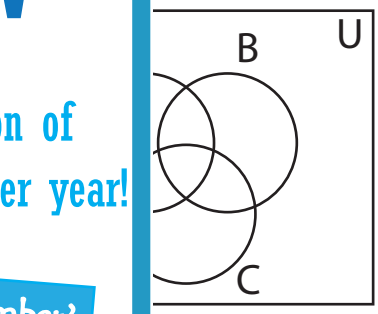


5) A′ – C

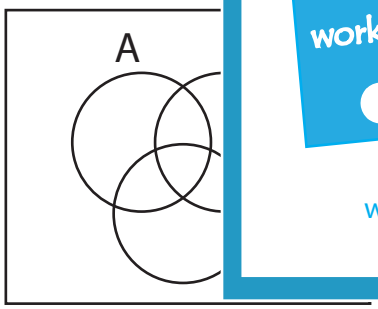


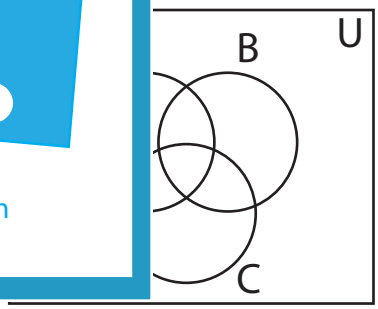


7) B′ – C′

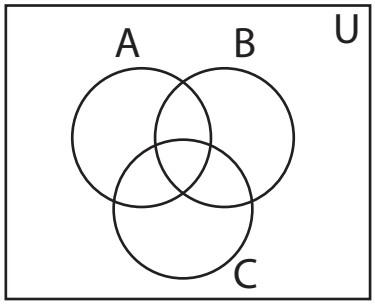


8) C – B′

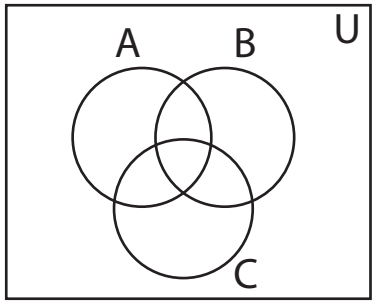


PREVIEW

Access the largest collection of worksheets for just $19.95 per year!

Members, please log in to download this worksheet.

Log in

Not a member? Please sign up to gain complete access.

Sign up

www.mathworksheets4kids.com

Name : _____ Score : _____

**Answer key**

## Shading - Venn Diagram

L2S4

Shade the given region.

1) A′ U C

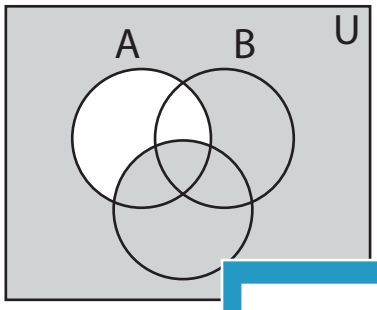


2) A′ – C′

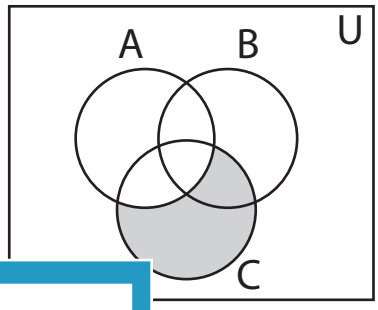


3) (B – C)′

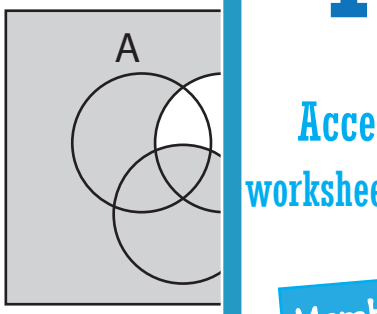


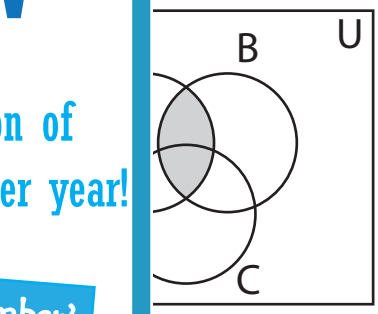


5) A′ – C

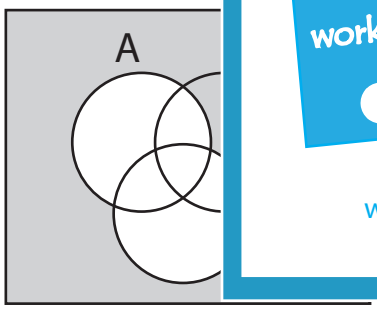


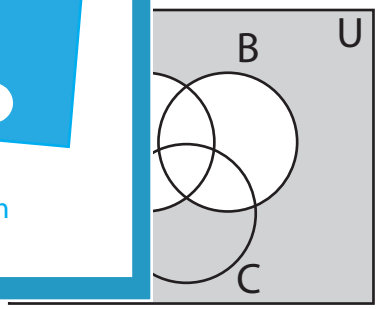


7) B′ – C′

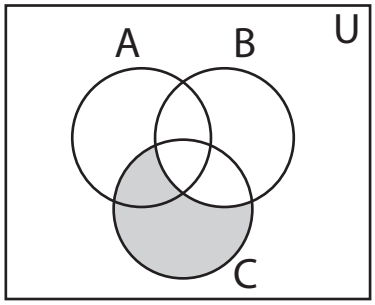


8) C – B′

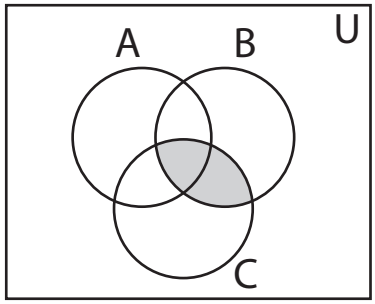



PREVIEW

Access the largest collection of worksheets for just $19.95 per year!

Members, please log in to download this worksheet.

Log in

Not a member? Please sign up to gain complete access.

Sign up

www.mathworksheets4kids.com

Name : _____ Score : _____

# Shading - Venn Diagram

L2S5

Shade the given region.

1) (C′ – A)′

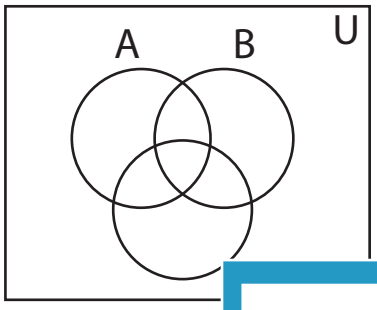


2) B′

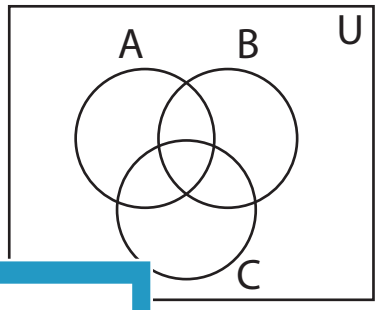


3) (A – C′)′

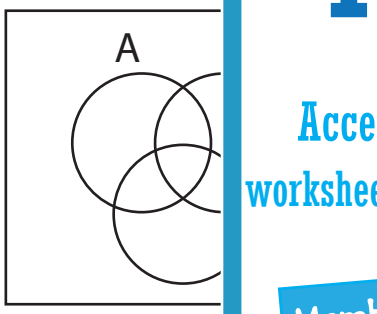


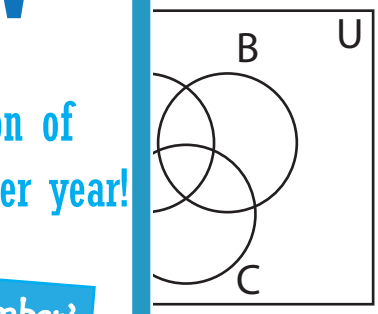


5) A ∩ B′

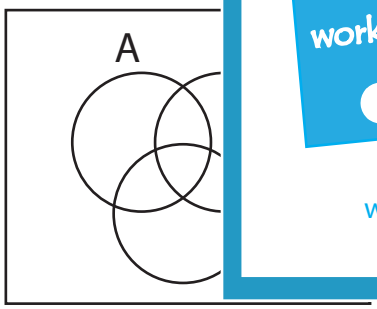


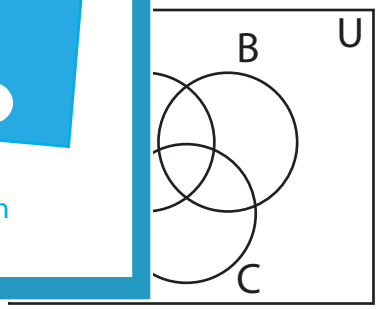


7) C′ – A

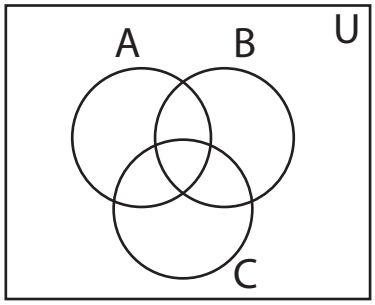


8) (B ∩ C)′

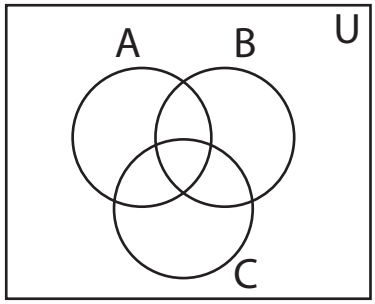


PREVIEW

Access the largest collection of worksheets for just $19.95 per year!

Members, please log in to download this worksheet.

Log in

Not a member? Please sign up to gain complete access.

Sign up

www.mathworksheets4kids.com

Name : _____ Score : _____

**Answer key**

## Shading - Venn Diagram

L2S5

Shade the given region.

1) $(C' - A)'$

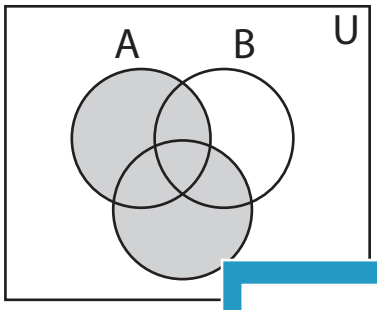


2) $B'$

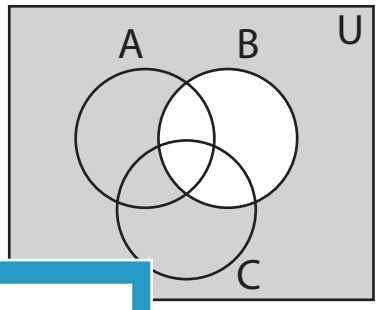


3) $(A - C')'$

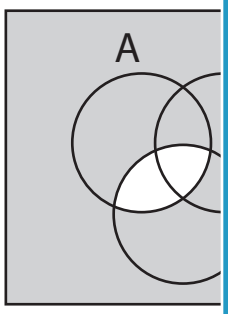


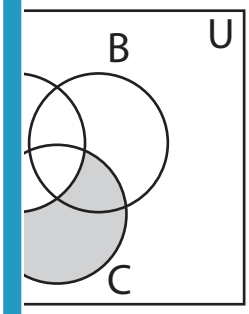


5) $A \cap B'$

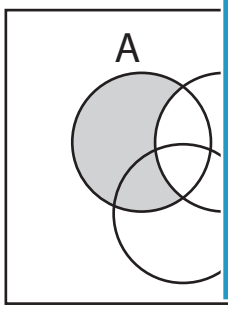


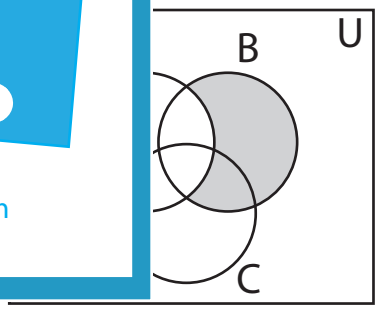


7) $C' - A$

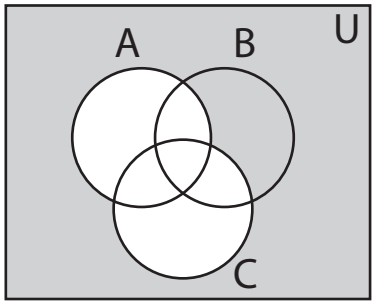


8) $(B \cap C)'$

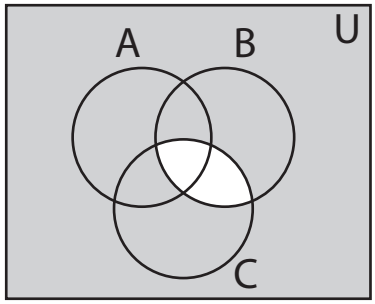



PREVIEW

Access the largest collection of worksheets for just $19.95 per year!

Members, please log in to download this worksheet.

Log in

Not a member? Please sign up to gain complete access.

Sign up

www.mathworksheets4kids.com