Name : _____

Volume - Cylinder

Integers: ES1

A) Find the volume of each cylinder. (use $\pi = 3.14$)

1)

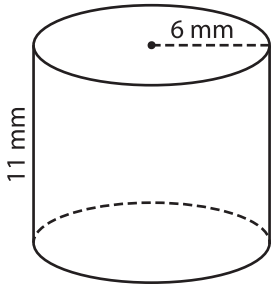

Volume = _____

2)

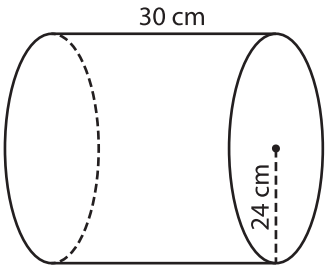

Volume = _____

3)

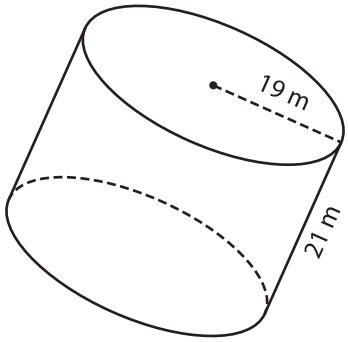

Volume = _____

B) Find the volume of each cylinder from the given parameters. (use $\pi = 3.14$)

4) height = 9 cm ; radius = 3 cm

Volume = _____

5) radius = 13 m ; height = 8 m

Volume = _____

6) radius = 16 mm ; height = 27 mm

Volume = _____

7) height = 15 cm ; radius = 10 cm

Volume = _____

8) A cylindrical flower vase is 11 cm tall. Find the volume of the vase if the radius is 4 cm. (use $\pi = 3.14$)

_____