Name : _____

Volume - Rectangular Prism

ES1

A) Find the volume of each rectangular prism.

1)

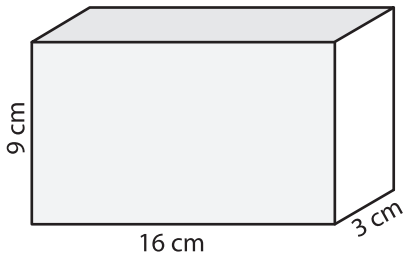

Volume = _____

2)

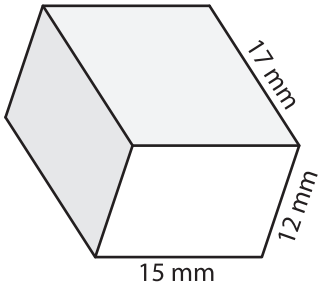

Volume = _____

3)

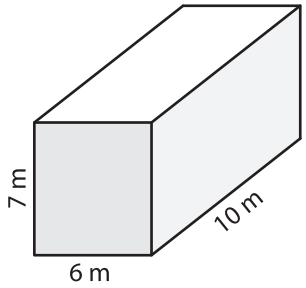

Volume = _____

B) Find the volume of each rectangular prism from the given parameters.

4) length = 19 mm ; width = 17 mm ; height = 13 mm

Volume = _____

5) height = 14 cm ; length = 11 cm ; width = 8 cm

Volume = _____

6) width = 3 m ; height = 16 m ; length = 18 m

Volume = _____

7) length = 20 mm ; height = 9 mm ; width = 7 mm

Volume = _____

8) A rectangular prism has a length of 12 cm, a width of 4 cm and a height of 8 cm. What is the volume of the prism?

_____