Name : _____

Volume - Rectangular Prism

ES3

A) Find the volume of each rectangular prism.

1)

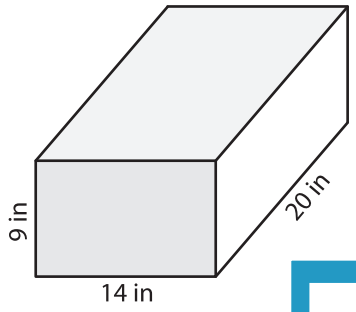

2)

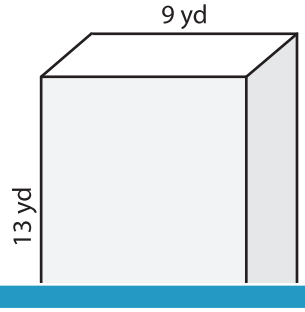

3)

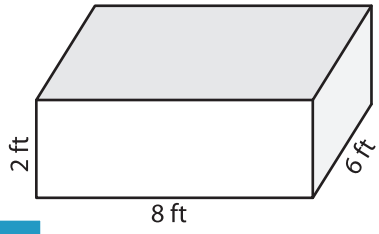

Volume = _____ ume = _____

B) Find the volume of e eters.

4) height = 4 yd ; length = = 12 in ; length = 11 in

Volume = _____ _____

6) height = 16 ft ; width = th = 4 yd ; height = 17 yd

Volume = _____ Volume = _____

8) The length, width and height of a rectangular prism are 18 inches, 10 inches and 15 inches respectively. What is its volume?

_____

PREVIEW

Gain complete access to the largest collection of worksheets in all subjects!

Members, please log in to download this worksheet.

Not a member? Please sign up to gain complete access.

www.mathworksheets4kids.com