Name : _____

Polygon - Unknown Sides

Sheet 2

Find the value of x and the indicated side lengths.

1)

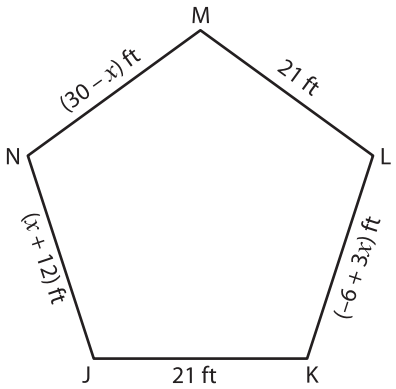

Perimeter = 105 ft ; x = _____

KL = _____ ; MN = _____

2)

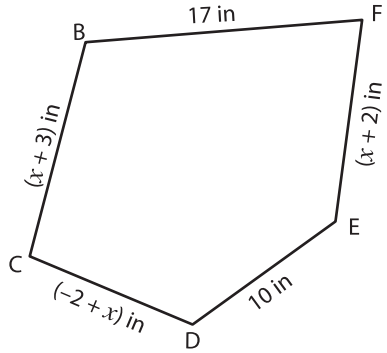

Perimeter = 66 in ; x = _____

= _____ ; BC = _____

3)

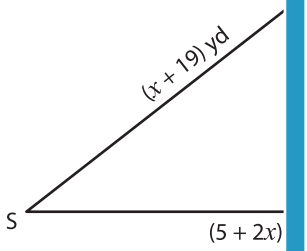

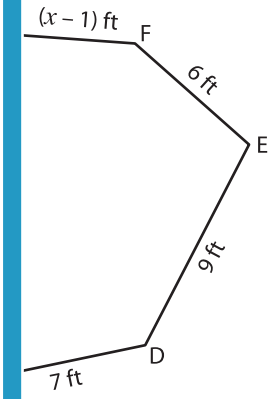

Perimeter = 101 yd

t ; x = _____

ST = _____ ; RT = _____

= _____ ; FG = _____

5)

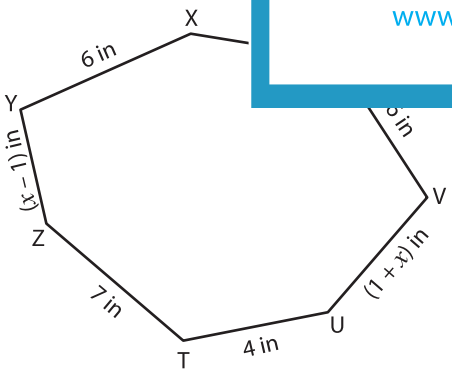

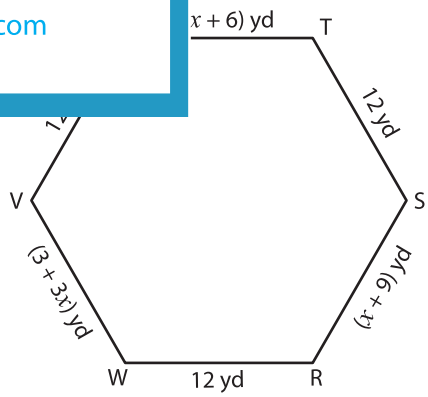

Perimeter = 35 in ; x = _____

YZ = _____ ; UV = _____ ; WX = _____

Perimeter = 72 yd ; x = _____

RS = _____ ; TU = _____ ; VW = _____

PREVIEW

Gain complete access to the largest collection of worksheets in all subjects!

Members, please log in to download this worksheet.

Not a member? Please sign up to gain complete access.

www.mathworksheets4kids.com