Name : _____

Angles in Polygon

Sheet 2

Find the measures of the indicated angles.

1)

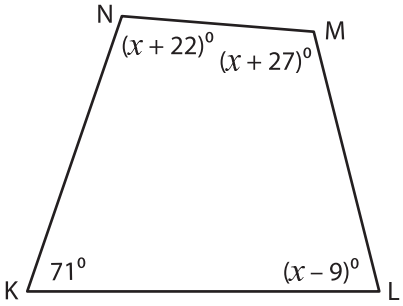

Sum of the interior angles = _____ ; x = _____

m∠L = _____ ; m∠N = _____

2)

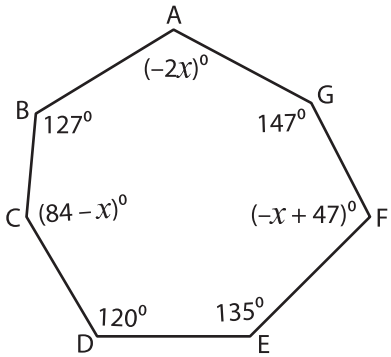

Sum of the interior angles = _____ ; x = _____

m∠C = _____ ; m∠F = _____

3)

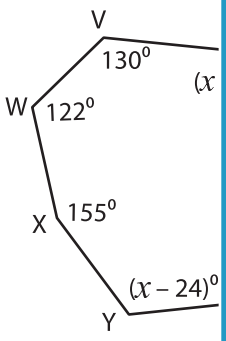

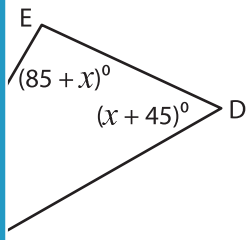

Sum of the interior angles = _____ ; x = _____

m∠Y = _____ ; m∠T = _____

m∠E = _____ ; m∠F = _____

5)

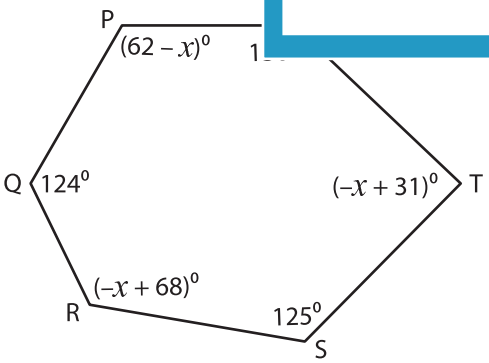

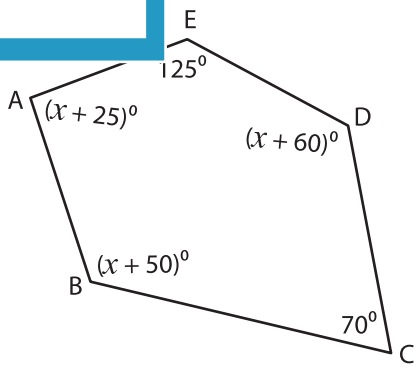

Sum of the interior angles = _____ ; x = _____

m∠P = _____ ; m∠T = _____ ; m∠R = _____

Sum of the interior angles = _____ ; x = _____

m∠A = _____ ; m∠B = _____ ; m∠D = _____

PREVIEW

Gain complete access to the largest collection of worksheets in all subjects!

Members, please log in to download this worksheet.

Not a member? Please sign up to gain complete access.

www.mathworksheets4kids.com