Name : _____

Triangle - Finding Base/Height

Sheet 1

A) Find the missing measure of each triangle.

1)

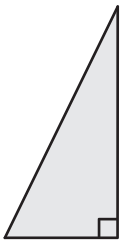

432 in

Area = 156 yd^2

height = _____

2)

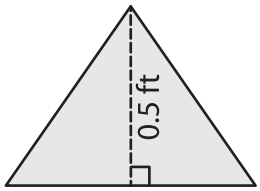

Area = 24 in^2

3)

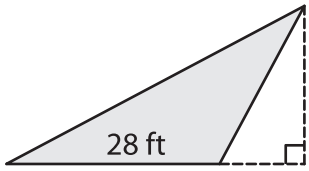

Area = 42 yd^2

ght = _____ ft

B) Find the missing measu

4) Area = 228 ft^2 , height = 32 yd

base = _____ yd

6) Area = 729 in^2 , base = 1 3 yd

height = _____ ft

8) The base of a triangle is area is 330 square yards?

_____ yards

9) Find the base of a triangle whose area is 2.75 square feet and the height is 33 inches.

_____ inches

PREVIEW

Gain complete access to the largest collection of worksheets in all subjects!

Members, please log in to download this worksheet.

Not a member? Please sign up to gain complete access.

www.mathworksheets4kids.com