Name : _____

Types of Dilation

Sheet 2

A) State whether a dilation with the given scale factor is an enlargement or a reduction.

1) Scale factor = 9

2) Scale factor = $\frac{4}{3}$

3) Scale factor = 7.5

4) Scale factor = $\frac{1}{5}$

5) Scale factor = 6

6) Scale factor = $\frac{7}{8}$

B) Figure A is a dilated imag or enlargement)

1)

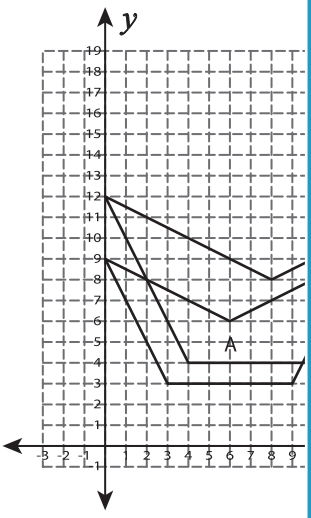

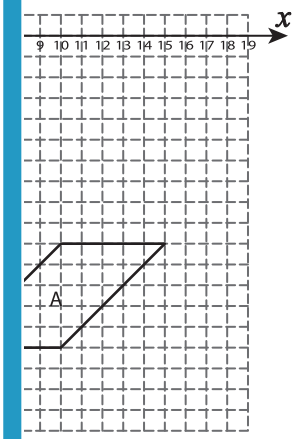

3)

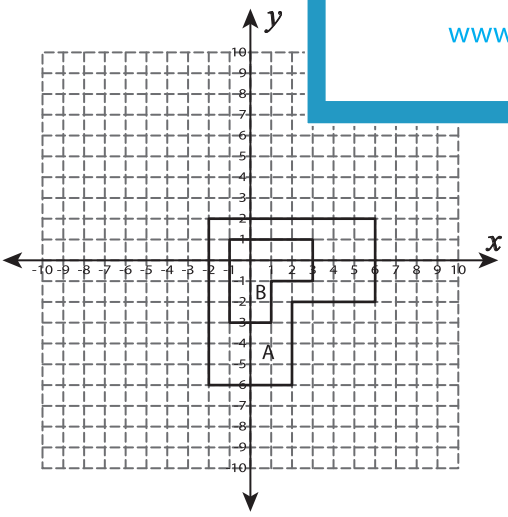

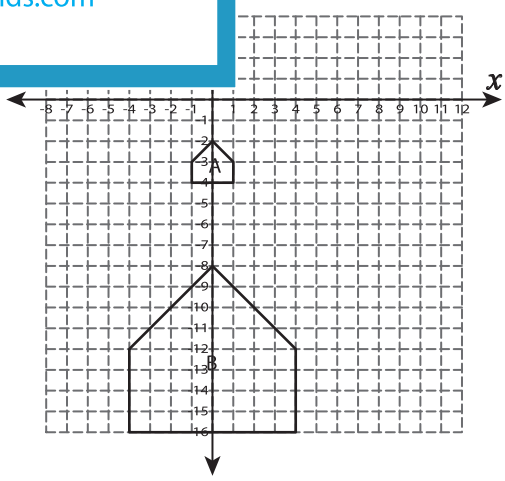

PREVIEW

Gain complete access to the largest collection of worksheets in all subjects!

Members, please log in to download this worksheet.

Not a member? Please sign up to gain complete access.

www.mathworksheets4kids.com